Encontrar los ángulos en las figuras

Nombre:

Cuenta el número de ángulos Agudos, Obtusos, Rectos y Concavos de cada figura.

Ej)

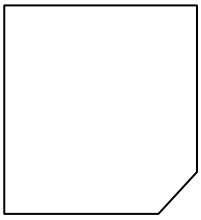

1)

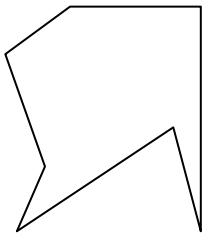

2)



3)

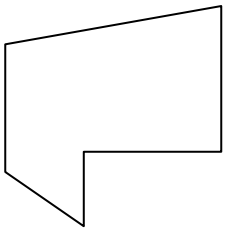

4)

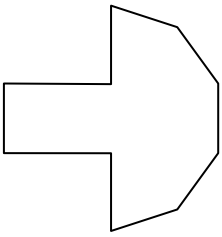

5)

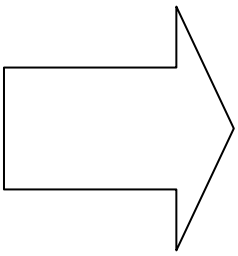

6)

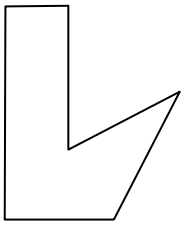

7)

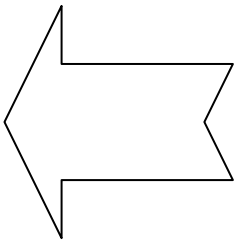

8)

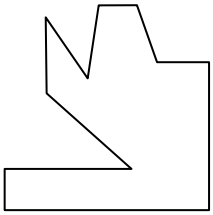

9)

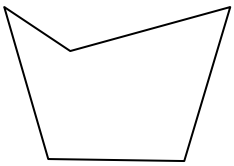

10)



11)



Respuestas

Ej.	0	2	3	0
1.				
2.				
3.				
4.				
5.				
6.				
7.				
8.				
9.				
10.				
11.				

1-10	91	82	73	64	55	45	36	27	18	9
11	0									

Encontrar los ángulos en las figuras

Nombre: **Clave De Respuestas**

Cuenta el número de ángulos Agudos, Obtusos, Rectos y Concavos de cada figura.

Ej)

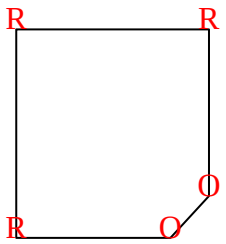

1)

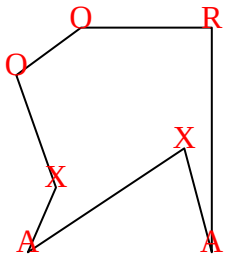

2)



3)

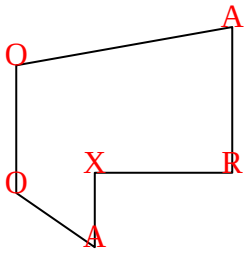

4)

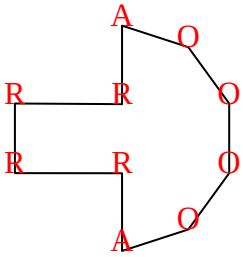

5)

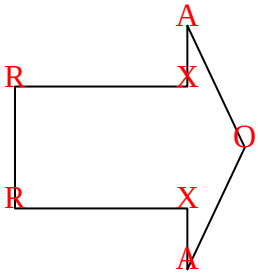

6)

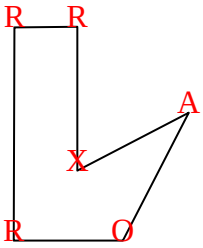

7)

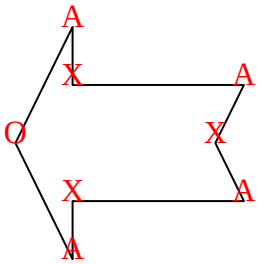

8)

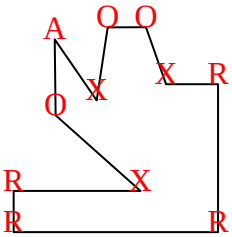

9)

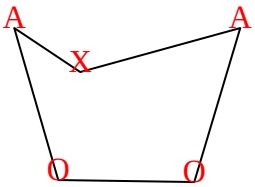

10)

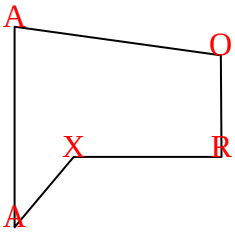

11)

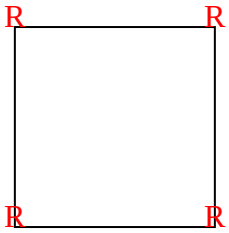

Respuestas

Ej.	0	2	3	0
1.	2	2	1	2
2.	0	0	4	0
3.	2	2	1	1
4.	2	4	4	0
5.	2	1	2	2
6.	1	1	3	1
7.	4	1	0	3
8.	1	3	4	3
9.	2	2	0	1
10.	2	1	1	1
11.	0	0	4	0

1-10	91	82	73	64	55	45	36	27	18	9
11	0									