Encontrar los ángulos en las figuras Nombre:

Cuenta el número de ángulos Agudos, Obtusos, Rectos y Concavos de cada figura.

Ej)

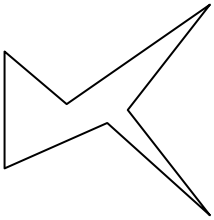

1)



2)

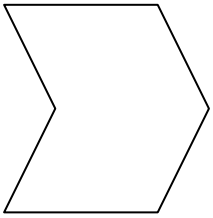

3)

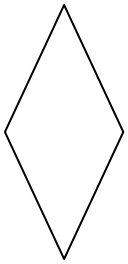

4)

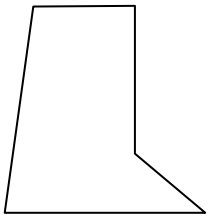

5)

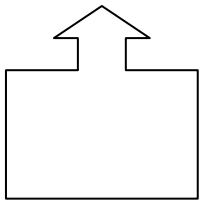

6)



7)

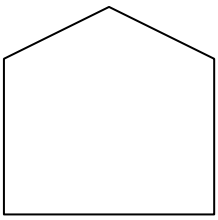

8)

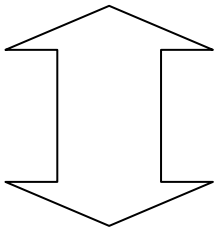

9)

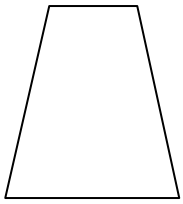

10)



11)

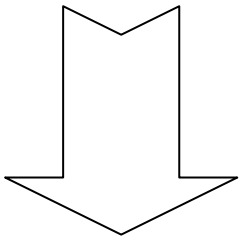

Respuestas

Ej.	4	0	0	3
1.				
2.				
3.				
4.				
5.				
6.				
7.				
8.				
9.				
10.				
11.				

1-10	91	82	73	64	55	45	36	27	18	9
11	0									

Encontrar los ángulos en las figuras

Nombre: **Clave De Respuestas**

Cuenta el número de ángulos Agudos, Obtusos, Rectos y Concavos de cada figura.

Ej)

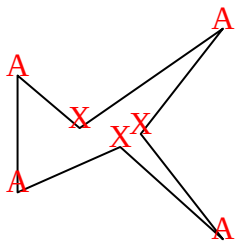

1)

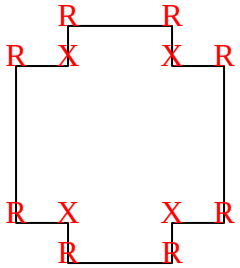

2)

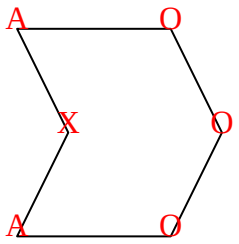

3)

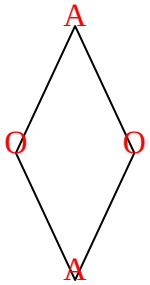

4)

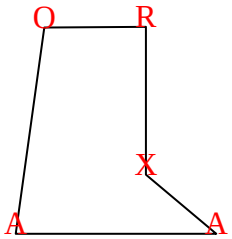

5)

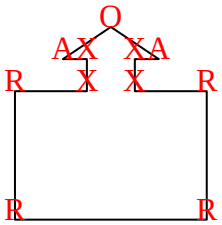

6)

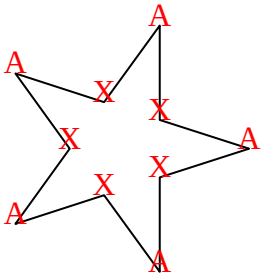

7)

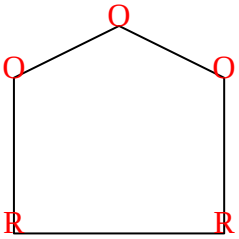

8)

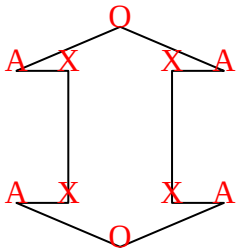

9)

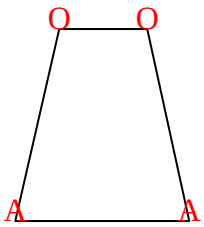

10)

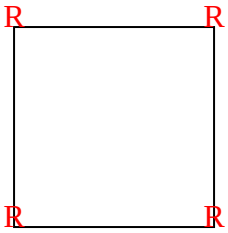

11)

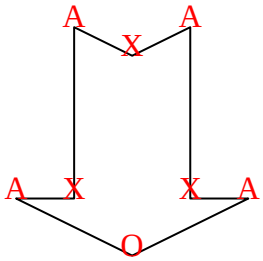

Respuestas

Ej.	4	0	0	3
1.	0	0	8	4
2.	2	3	0	1
3.	2	2	0	0
4.	2	1	1	1
5.	2	1	4	4
6.	5	0	0	5
7.	0	3	2	0
8.	4	2	0	4
9.	2	2	0	0
10.	0	0	4	0
11.	4	1	0	3

1-10	91	82	73	64	55	45	36	27	18	9
11	0									