Completar y emparejar ecuaciones de volumen Nombre:

**Empareje cada problema con la ecuación que podría representarlo. Responda con el término y la letra que faltan.**

**Ej)** 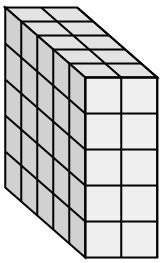

**1)** 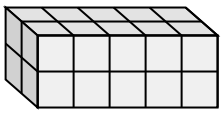

**2)** 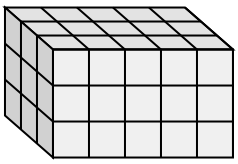

**3)** 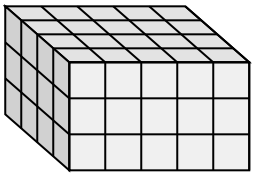

**4)** 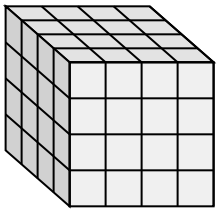

**5)** 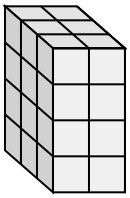

**6)** 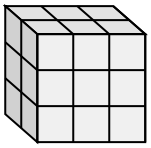

**7)** 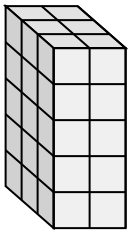

**8)** 

**9)** 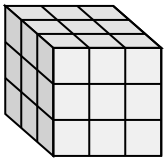

**10)** 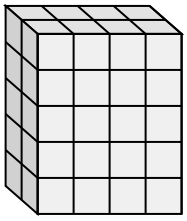

**11)** 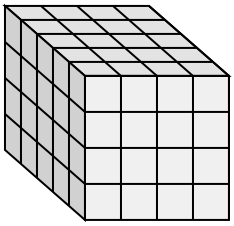

**A.** ___ × 2 × 5 = 30

**B.** ___ × 5 × 3 = 60

**C.** 3 × 3 × ___ = 27

**D.** 3 × 2 × ___ = 24

**E.** ___ × 4 × 5 = 100

**F.** 5 × ___ × 5 = 50

**G.** ___ × 4 × 4 = 64

**H.** 3 × 5 × ___ = 45

**I.** 2 × 5 × 2 = ___

**J.** ___ × 4 × 4 = 80

**K.** ___ × 3 × 3 = 18

**L.** 2 × 4 × ___ = 40

**Respuestas**

Ej. F , 2

1. _____

2. _____

3. _____

4. _____

5. _____

6. _____

7. _____

8. _____

9. _____

10. _____

11. _____



| | | | | | | | | | | |
|---|---|---|---|---|---|---|---|---|---|---|
| 1-10 | 91 | 82 | 73 | 64 | 55 | 45 | 36 | 27 | 18 | 9 |
| 11 | 0 | | | | | | | | | |

Completar y emparejar ecuaciones de volumen

Nombre: **Clave De Respuestas**

**Empareje cada problema con la ecuación que podría representarlo. Responda con el término y la letra que faltan.**

**Ej)** 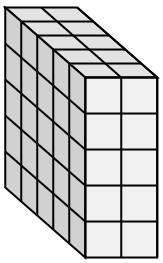

**1)** 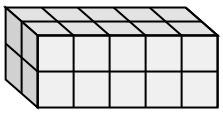

**2)** 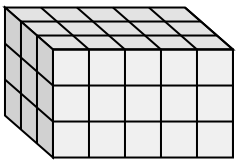

**3)** 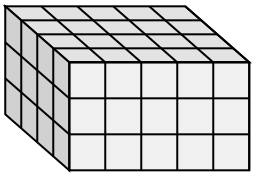

**4)** 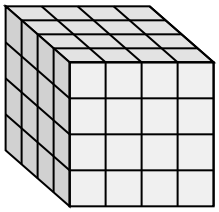

**5)** 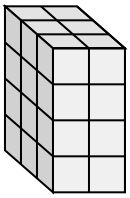

**6)** 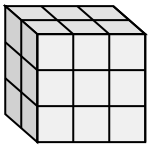

**7)** 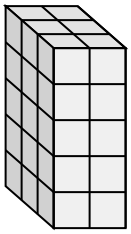

**8)** 

**9)** 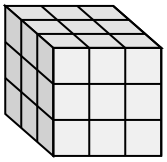

**10)** 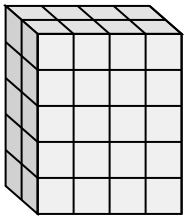

**11)** 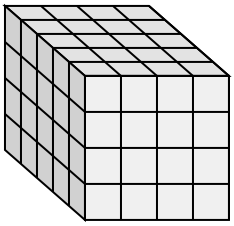

**A.** ___ × 2 × 5 = 30

**B.** ___ × 5 × 3 = 60

**C.** 3 × 3 × ___ = 27

**D.** 3 × 2 × ___ = 24

**E.** ___ × 4 × 5 = 100

**F.** 5 × ___ × 5 = 50

**G.** ___ × 4 × 4 = 64

**H.** 3 × 5 × ___ = 45

**I.** 2 × 5 × 2 = ___

**J.** ___ × 4 × 4 = 80

**K.** ___ × 3 × 3 = 18

**L.** 2 × 4 × ___ = 40

## Respuestas

Ej. F , 2

1. I , 20
2. H , 3
3. B , 4
4. G , 4
5. D , 4
6. K , 2
7. A , 3
8. E , 5
9. C , 3
10. L , 5
11. J , 5



| | | | | | | | | | | |
|---|---|---|---|---|---|---|---|---|---|---|
| 1-10 | 91 | 82 | 73 | 64 | 55 | 45 | 36 | 27 | 18 | 9 |
| 11 | 0 | | | | | | | | | |