Completar y emparejar ecuaciones de volumen Nombre:

Empareje cada problema con la ecuación que podría representarlo. Responda con el término y la letra que faltan.

Ej) 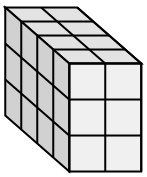

1) 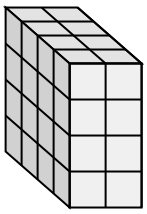

2) 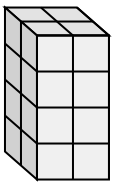

3) 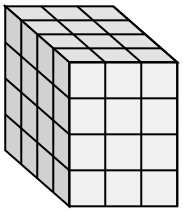

4) 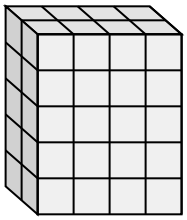

5) 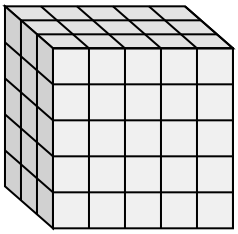

6) 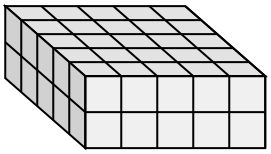

7) 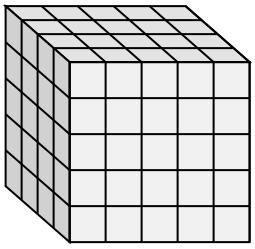

8) 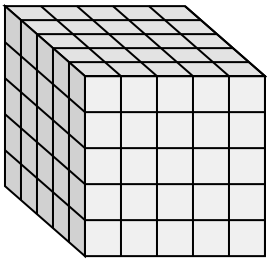

9) 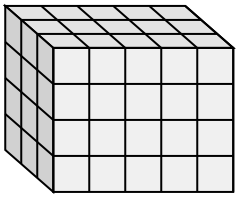

10) 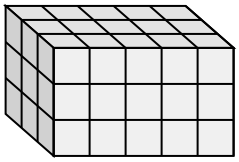

11) 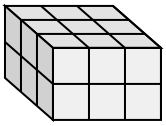

A. 3 × ___ × 4 = 60

B. ___ × 4 × 5 = 40

C. 3 × ___ × 2 = 18

D. ___ × 2 × 3 = 24

E. ___ × 2 × 4 = 16

F. 3 × ___ × 3 = 45

G. 4 × ___ × 5 = 100

H. 5 × 5 × 2 = ___

I. 4 × 2 × ___ = 32

J. ___ × 5 × 5 = 75

K. 4 × 3 × ___ = 48

L. 5 × 5 × ___ = 125

Respuestas

Ej. D , 4

1. _____

2. _____

3. _____

4. _____

5. _____

6. _____

7. _____

8. _____

9. _____

10. _____

11. _____

1-10	91	82	73	64	55	45	36	27	18	9
11	0									

Empareje cada problema con la ecuación que podría representarlo. Responda con el término y la letra que faltan.

Ej) 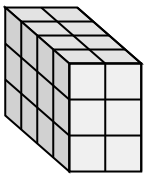

1) 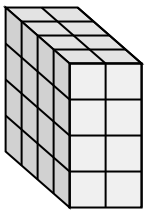

2) 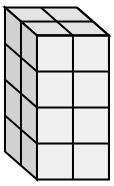

3) 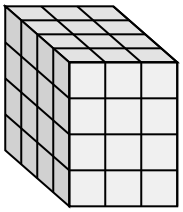

4) 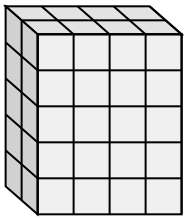

5) 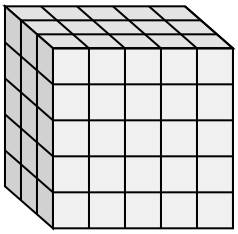

6) 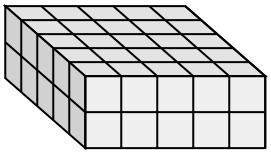

7) 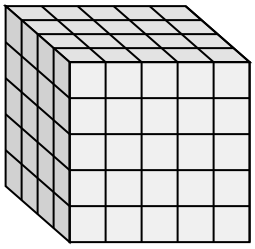

8) 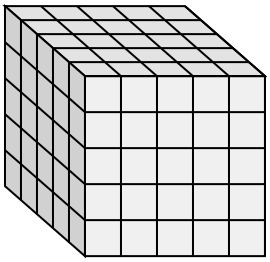

9) 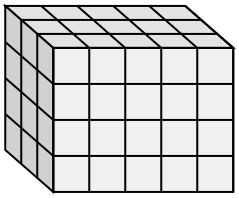

10) 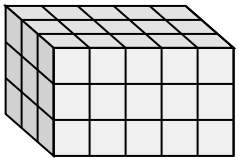

11) 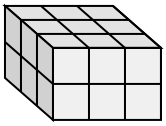

A. 3 × ___ × 4 = 60

B. ___ × 4 × 5 = 40

C. 3 × ___ × 2 = 18

D. ___ × 2 × 3 = 24

E. ___ × 2 × 4 = 16

F. 3 × ___ × 3 = 45

G. 4 × ___ × 5 = 100

H. 5 × 5 × 2 = ___

I. 4 × 2 × ___ = 32

J. ___ × 5 × 5 = 75

K. 4 × 3 × ___ = 48

L. 5 × 5 × ___ = 125

Respuestas

Ej. D , 4

1. I , 4
2. E , 2
3. K , 4
4. B , 2
5. J , 3
6. H , 50
7. G , 5
8. L , 5
9. A , 5
10. F , 5
11. C , 3

1-10	91	82	73	64	55	45	36	27	18	9
11	0									