Completar y emparejar ecuaciones de volumen Nombre:

Empareje cada problema con la ecuación que podría representarlo. Responda con el término y la letra que faltan.

Ej) 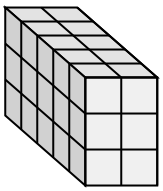

1) 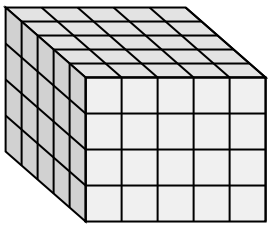

2) 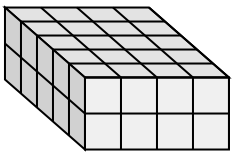

3) 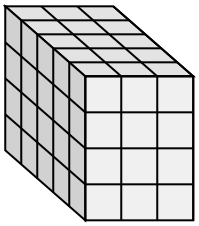

4) 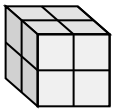

5) 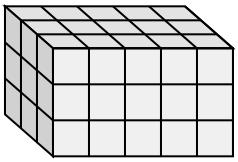

6) 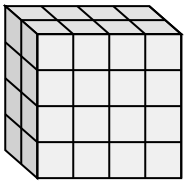

7) 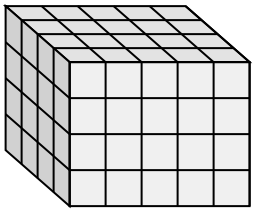

8) 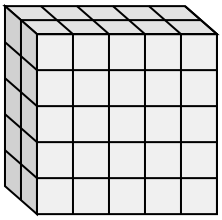

9) 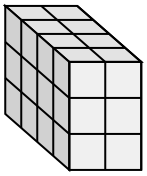

10) 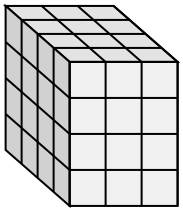

11) 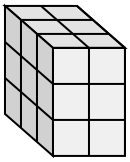

A. 3 × 2 × 3 = ___

B. 4 × 2 × 3 = ___

C. 5 × 2 × ___ = 30

D. 2 × ___ × 2 = 8

E. 5 × 4 × ___ = 40

F. ___ × 3 × 4 = 48

G. ___ × 5 × 5 = 50

H. 5 × ___ × 4 = 100

I. 2 × 4 × ___ = 32

J. 4 × ___ × 4 = 80

K. 3 × 5 × ___ = 45

L. 5 × 3 × ___ = 60

Respuestas

Ej. C , 3

1. ___

2. ___

3. ___

4. ___

5. ___

6. ___

7. ___

8. ___

9. ___

10. ___

11. ___

1-10	91	82	73	64	55	45	36	27	18	9
11	0									

Completar y emparejar ecuaciones de volumen

Nombre: **Clave De Respuestas**

Empareje cada problema con la ecuación que podría representarlo. Responda con el término y la letra que faltan.

Ej) 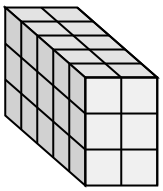

1) 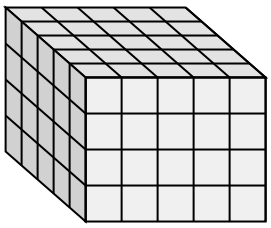

2) 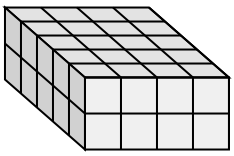

3) 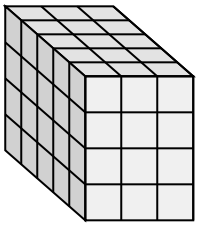

4) 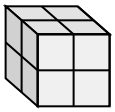

5) 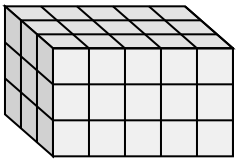

6) 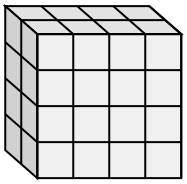

7) 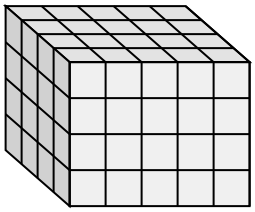

8) 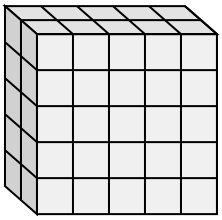

9) 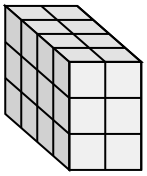

10) 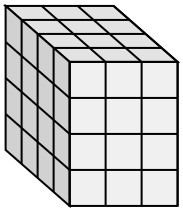

11) 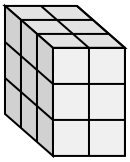

A. 3 × 2 × 3 = ___

B. 4 × 2 × 3 = ___

C. 5 × 2 × ___ = 30

D. 2 × ___ × 2 = 8

E. 5 × 4 × ___ = 40

F. ___ × 3 × 4 = 48

G. ___ × 5 × 5 = 50

H. 5 × ___ × 4 = 100

I. 2 × 4 × ___ = 32

J. 4 × ___ × 4 = 80

K. 3 × 5 × ___ = 45

L. 5 × 3 × ___ = 60

Respuestas

Ej. C , 3

1. H , 5
2. E , 2
3. L , 4
4. D , 2
5. K , 3
6. I , 4
7. J , 5
8. G , 2
9. B , 24
10. F , 4
11. A , 18

1-10	91	82	73	64	55	45	36	27	18	9
11	0									