Dividiendo con una recta numérica Nombre:

Usa las rectas numéricas para resolver los problemas.

1) 9÷3=

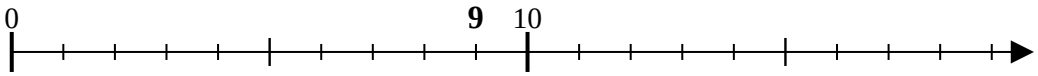

2) 10÷5=

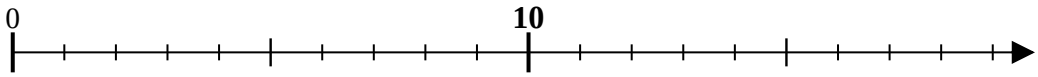

3) 32÷8=

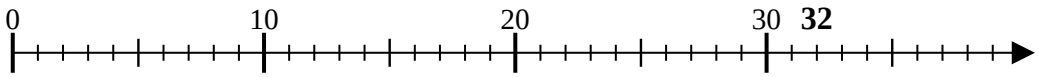

4) 8÷2=

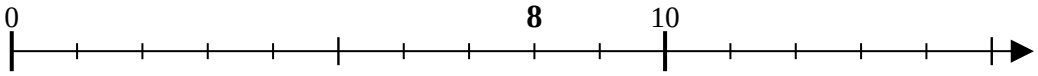

5) 24÷6=

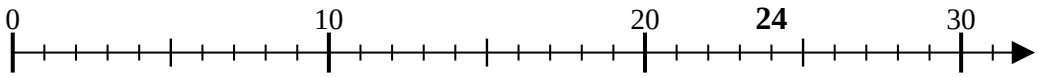

6) 8÷4=

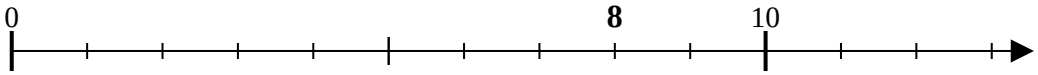

7) 4÷2=

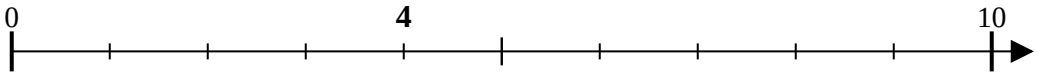

8) 30÷6=

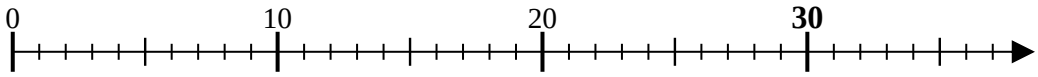

9) 20÷4=

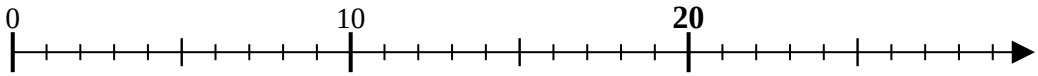

10) 12÷4=

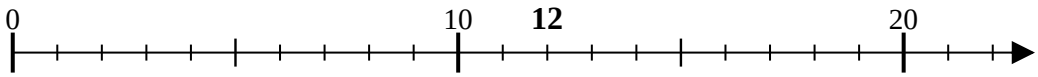

11) 50÷10=

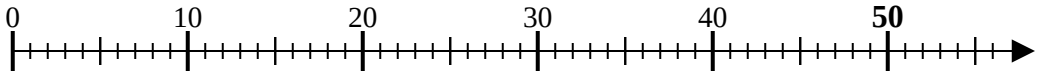

Respuestas

1. _____
2. _____
3. _____
4. _____
5. _____
6. _____
7. _____
8. _____
9. _____
10. _____
11. _____

1-10	91	82	73	64	55	45	36	27	18	9
11	0									

Usa las rectas numéricas para resolver los problemas.

1) 9÷3=

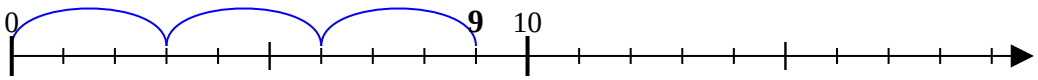

2) 10÷5=

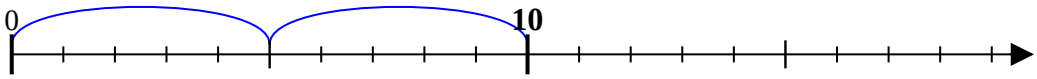

3) 32÷8=

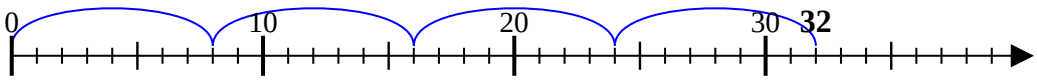

4) 8÷2=

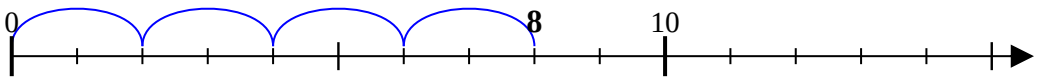

5) 24÷6=

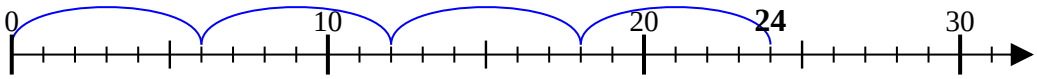

6) 8÷4=

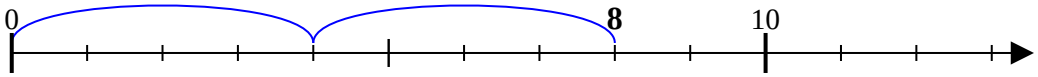

7) 4÷2=

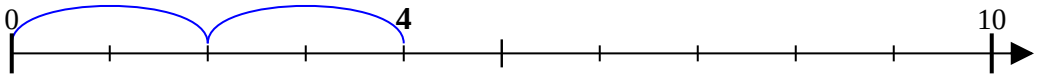

8) 30÷6=

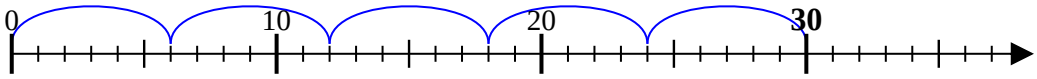

9) 20÷4=

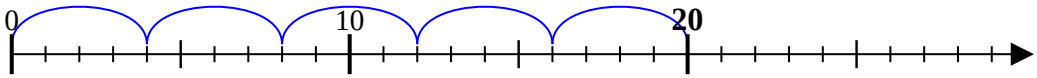

10) 12÷4=

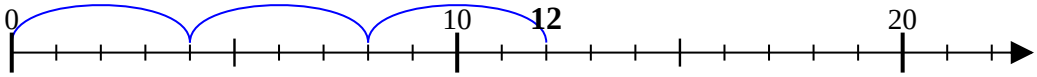

11) 50÷10=

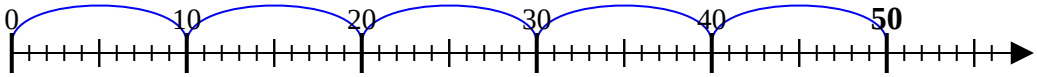

Respuestas

1. 3
2. 2
3. 4
4. 4
5. 4
6. 2
7. 2
8. 5
9. 5
10. 3
11. 5

1-10	91	82	73	64	55	45	36	27	18	9
11	0									