Dividiendo con una recta numérica Nombre:

Usa las rectas numéricas para resolver los problemas.

1) 24÷6=

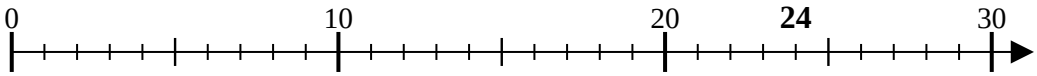

2) 16÷8=

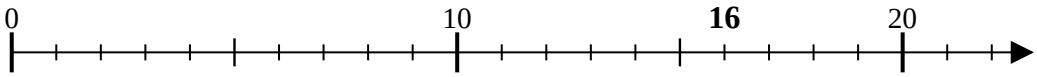

3) 10÷2=

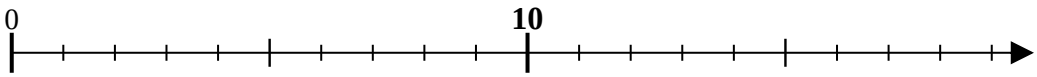

4) 40÷8=

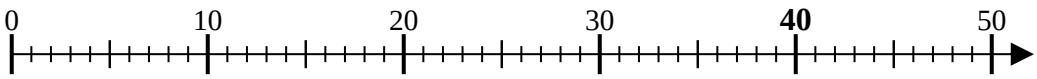

5) 6÷2=

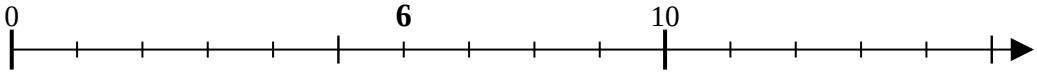

6) 40÷10=

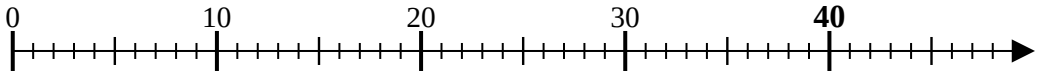

7) 15÷3=

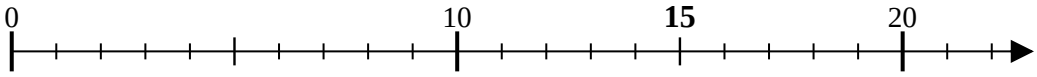

8) 18÷9=

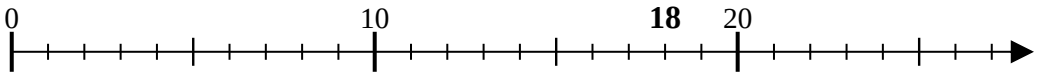

9) 27÷9=

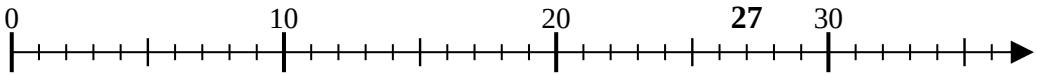

10) 36÷9=

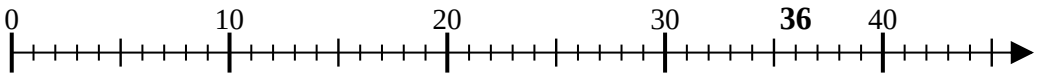

11) 8÷4=

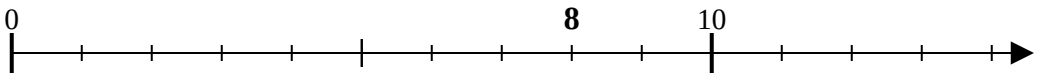

Respuestas

1. _____
2. _____
3. _____
4. _____
5. _____
6. _____
7. _____
8. _____
9. _____
10. _____
11. _____

1-10	91	82	73	64	55	45	36	27	18	9
11	0									

Usa las rectas numéricas para resolver los problemas.

1) 24÷6=

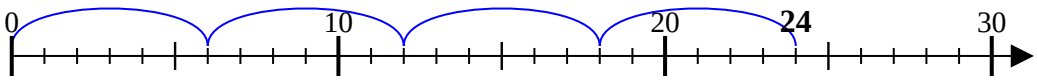

2) 16÷8=

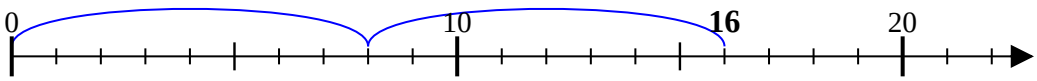

3) 10÷2=

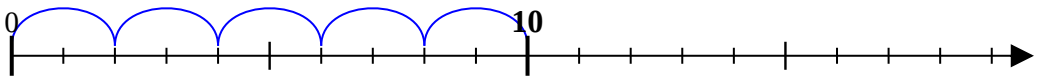

4) 40÷8=

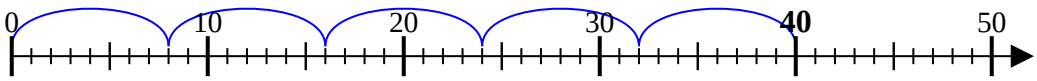

5) 6÷2=

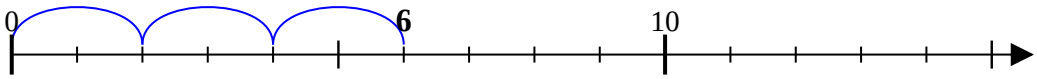

6) 40÷10=

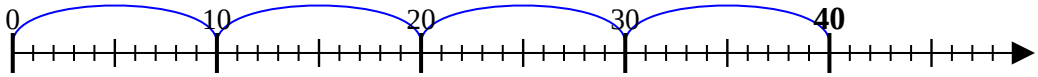

7) 15÷3=

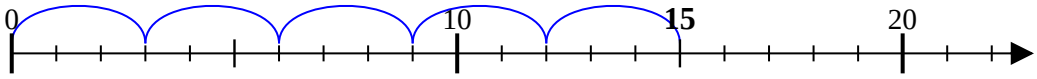

8) 18÷9=

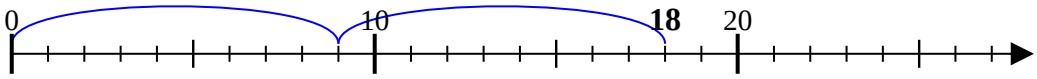

9) 27÷9=

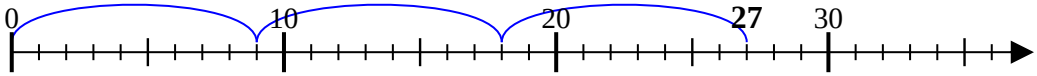

10) 36÷9=

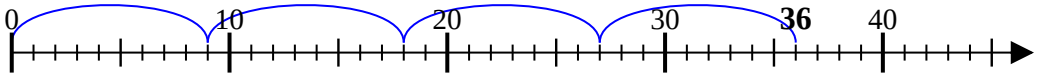

11) 8÷4=

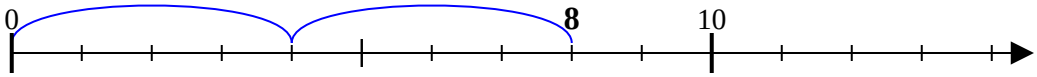

Respuestas

1. **4**
2. **2**
3. **5**
4. **5**
5. **3**
6. **4**
7. **5**
8. **2**
9. **3**
10. **4**
11. **2**

1-10	91	82	73	64	55	45	36	27	18	9
11	0									