Dividiendo con una recta numérica Nombre:

Usa las rectas numéricas para resolver los problemas.

1) 20÷5=

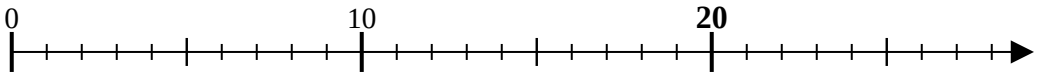

2) 50÷10=

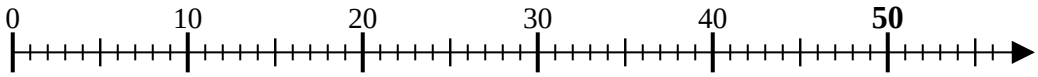

3) 12÷4=

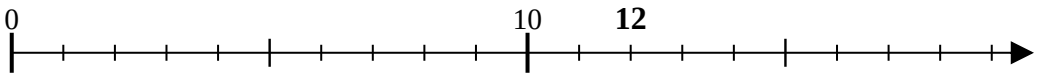

4) 9÷3=

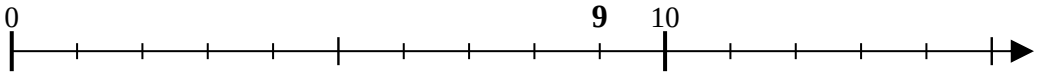

5) 20÷10=

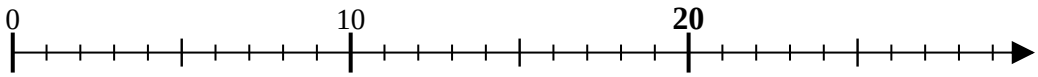

6) 18÷6=

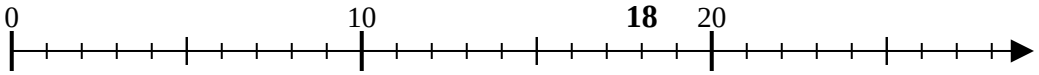

7) 16÷8=

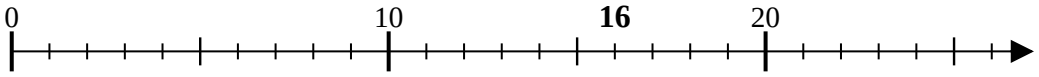

8) 15÷5=

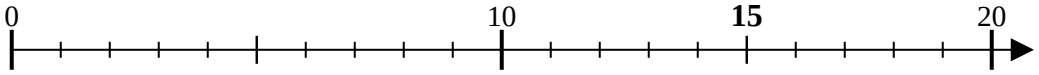

9) 8÷4=

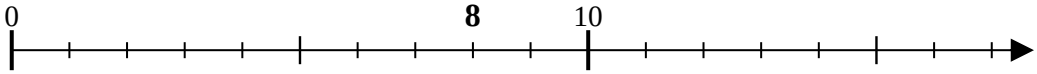

10) 40÷10=

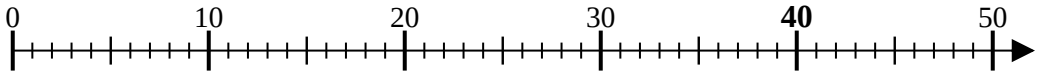

11) 25÷5=

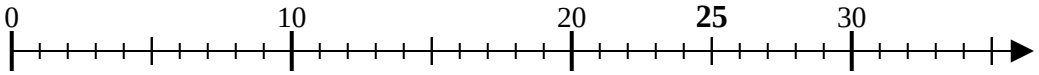

Respuestas

1. _____
2. _____
3. _____
4. _____
5. _____
6. _____
7. _____
8. _____
9. _____
10. _____
11. _____

Dividiendo con una recta numérica

Nombre: **Clave De Respuestas**

Usa las rectas numéricas para resolver los problemas.

1) 20÷5=

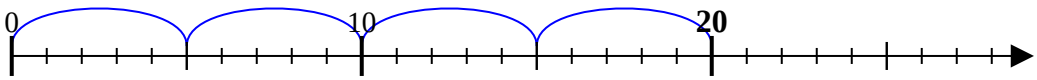

2) 50÷10=

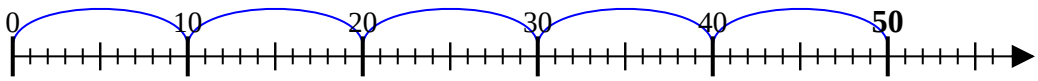

3) 12÷4=

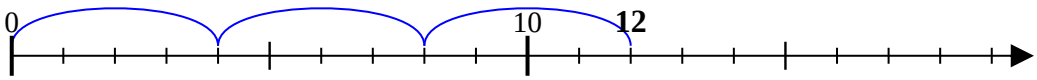

4) 9÷3=

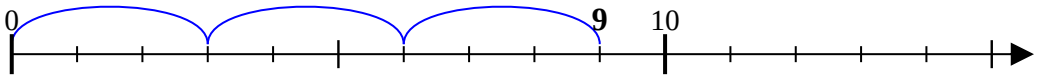

5) 20÷10=

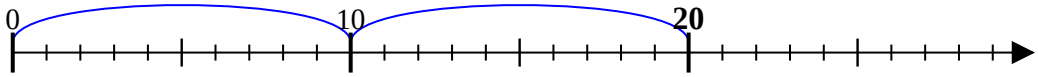

6) 18÷6=

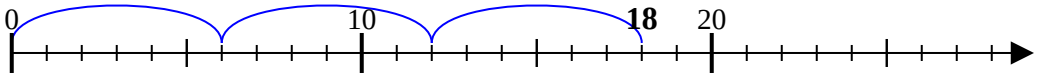

7) 16÷8=

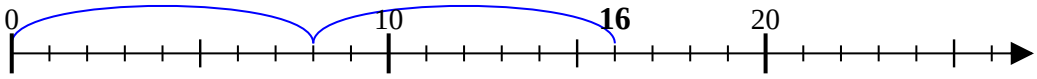

8) 15÷5=

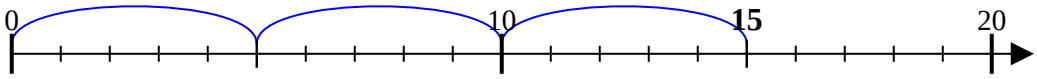

9) 8÷4=

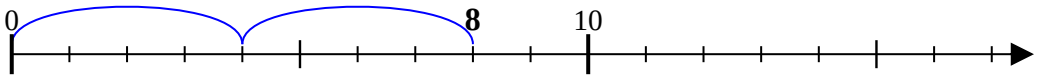

10) 40÷10=

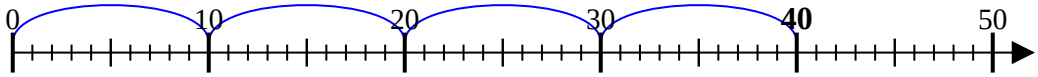

11) 25÷5=

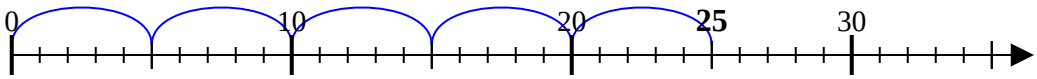

Respuestas

1. 4
2. 5
3. 3
4. 3
5. 2
6. 3
7. 2
8. 3
9. 2
10. 4
11. 5