Fracciones Impropias y Mixtas (Visual)

Nombre:

Escribe cada cantidad como un número mixto.

1)

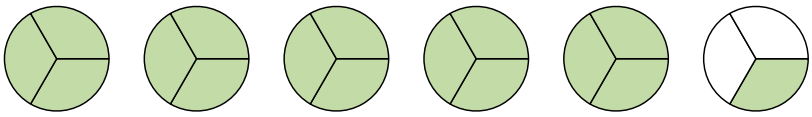

2)

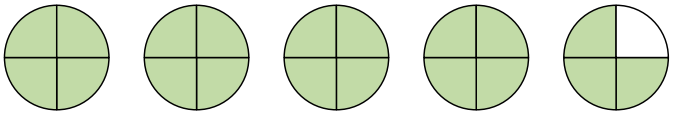

3)

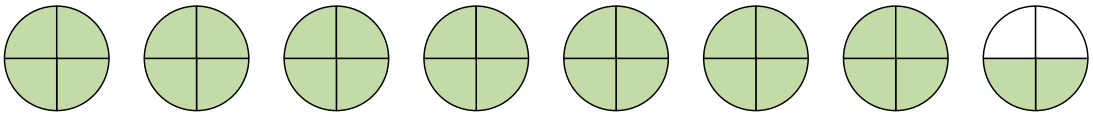

4)

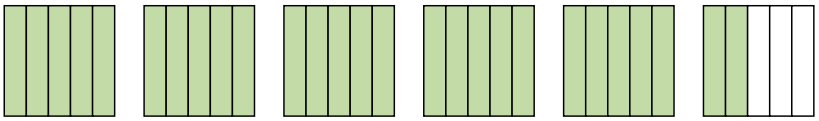

5)

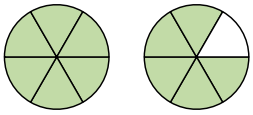

Escriba cada cantidad como una fracción impropia.

6)

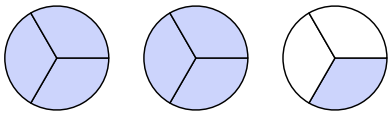

7)

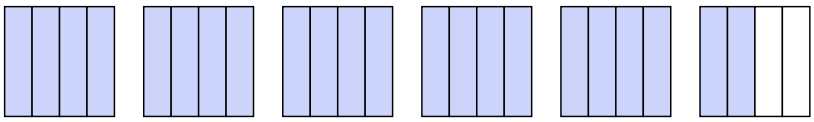

8)

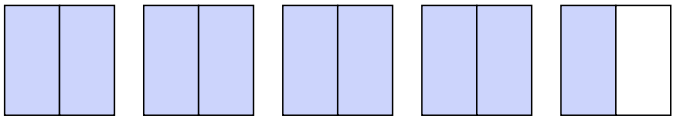

9)

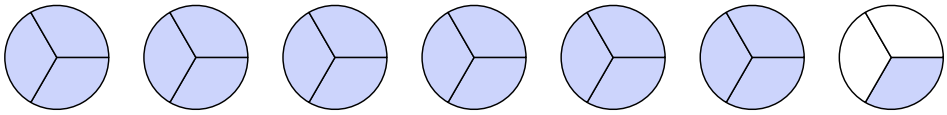

10)

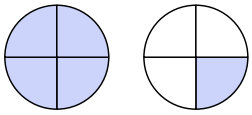

11)

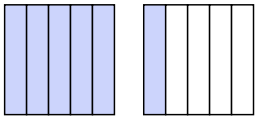

Respuestas

1. _____
2. _____
3. _____
4. _____
5. _____
6. _____
7. _____
8. _____
9. _____
10. _____
11. _____

1-10	91	82	73	64	55	45	36	27	18	9
11	0									

Fracciones Impropias y Mixtas (Visual) Nombre: **Clave De Respuestas**

Escribe cada cantidad como un número mixto.

1)

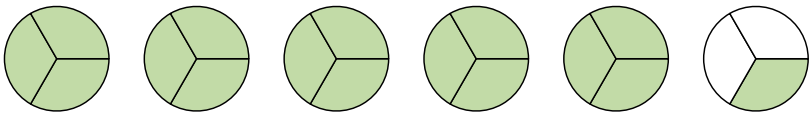

2)

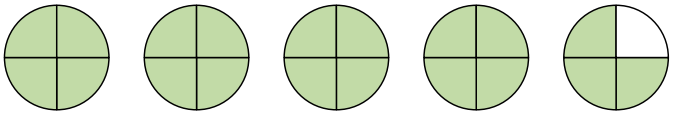

3)

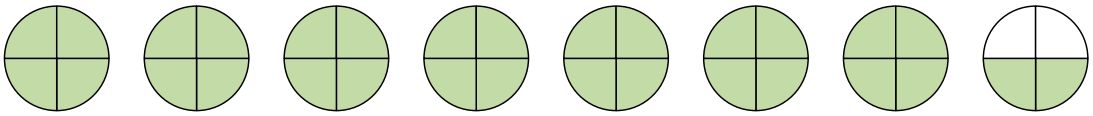

4)

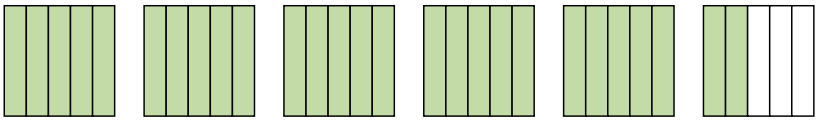

5)

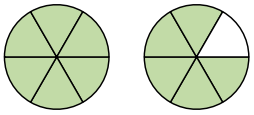

Escriba cada cantidad como una fracción impropia.

6)

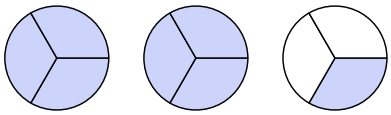

7)

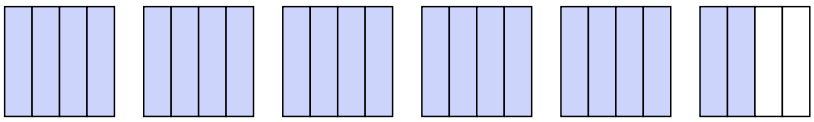

8)

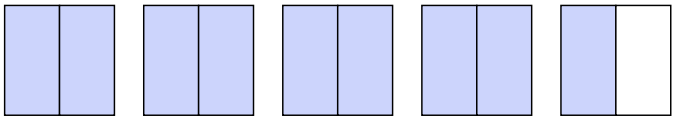

9)

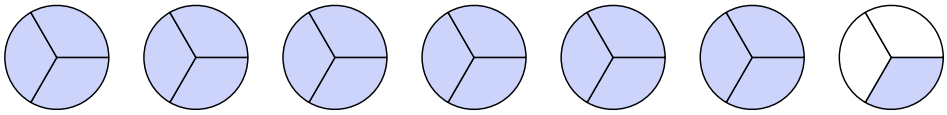

10)

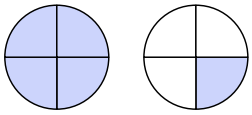

11)

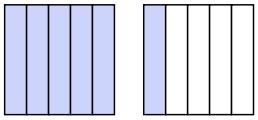

Respuestas

1. $5\frac{1}{3}$
2. $4\frac{3}{4}$
3. $7\frac{2}{4}$
4. $5\frac{2}{5}$
5. $1\frac{5}{6}$
6. $\frac{7}{3}$
7. $\frac{22}{4}$
8. $\frac{9}{2}$
9. $\frac{19}{3}$
10. $\frac{5}{4}$
11. $\frac{6}{5}$

1-10	91	82	73	64	55	45	36	27	18	9
11	0									