Multiplicando Fracciones (visualmente) Nombre:

Usa la caja para mostrar de manera visual cómo multiplicar dos fracciones.

Ej) $\frac{8}{9} \times \frac{5}{8} =$

1) $\frac{1}{3} \times \frac{3}{4} =$

2) $\frac{3}{4} \times \frac{2}{9} =$

3) $\frac{1}{2} \times \frac{1}{2} =$

4) $\frac{1}{4} \times \frac{1}{2} =$

5) $\frac{1}{9} \times \frac{2}{4} =$

6) $\frac{5}{6} \times \frac{1}{6} =$

7) $\frac{6}{9} \times \frac{2}{3} =$

8) $\frac{5}{6} \times \frac{7}{9} =$

9) $\frac{2}{4} \times \frac{2}{6} =$

10) $\frac{1}{2} \times \frac{1}{6} =$

11) $\frac{5}{7} \times \frac{4}{6} =$

Respuestas

Ej. 40/72

1. _____
2. _____
3. _____
4. _____
5. _____
6. _____
7. _____
8. _____
9. _____
10. _____
11. _____

1-10	91	82	73	64	55	45	36	27	18	9
11	0									

Usa la caja para mostrar de manera visual cómo multiplicar dos fracciones.

Ej) $\frac{8}{9} \times \frac{5}{8} =$

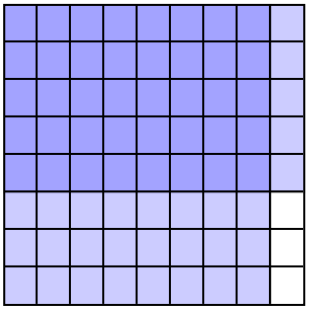

1) $\frac{1}{3} \times \frac{3}{4} =$



2) $\frac{3}{4} \times \frac{2}{9} =$

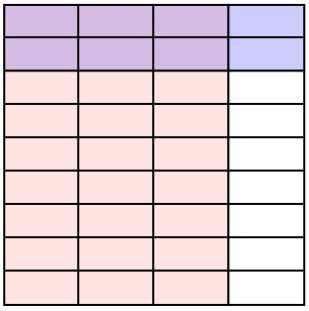

3) $\frac{1}{2} \times \frac{1}{2} =$



4) $\frac{1}{4} \times \frac{1}{2} =$



5) $\frac{1}{9} \times \frac{2}{4} =$

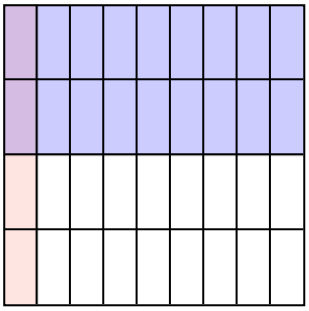

6) $\frac{5}{6} \times \frac{1}{6} =$

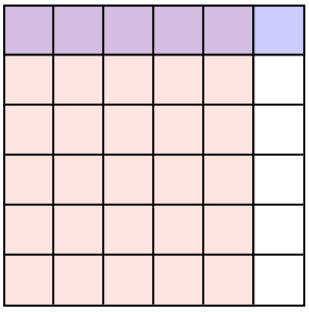

7) $\frac{6}{9} \times \frac{2}{3} =$

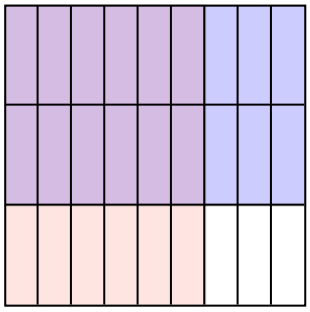

8) $\frac{5}{6} \times \frac{7}{9} =$

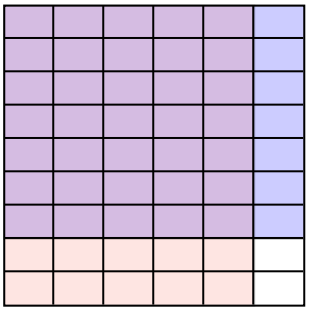

9) $\frac{2}{4} \times \frac{2}{6} =$



10) $\frac{1}{2} \times \frac{1}{6} =$



11) $\frac{5}{7} \times \frac{4}{6} =$

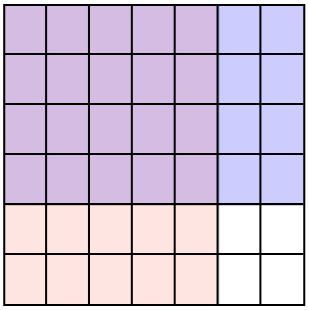

Respuestas

Ej.	40/72
1.	3/12
2.	6/36
3.	1/4
4.	1/8
5.	2/36
6.	5/36
7.	12/27
8.	35/54
9.	4/24
10.	1/12
11.	20/42

1-10	91	82	73	64	55	45	36	27	18	9
11	0									