Encontrando la distancia en el plano cartesiano Nombre:

Encuentra la distancia entre puntos. Redondea tu respuesta al decimal más cercano.

Ej)

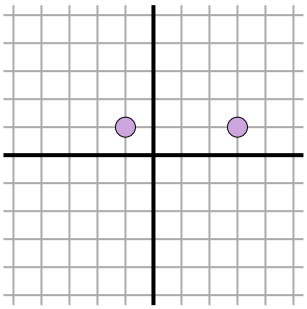

1)

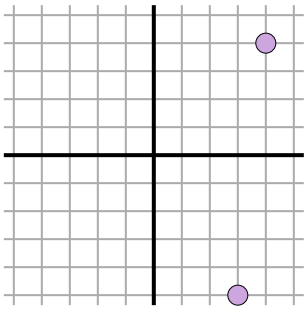

2)

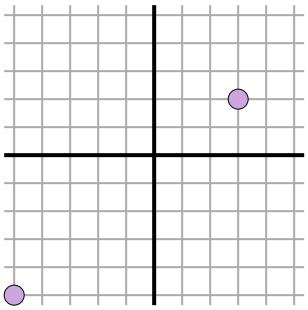

3)

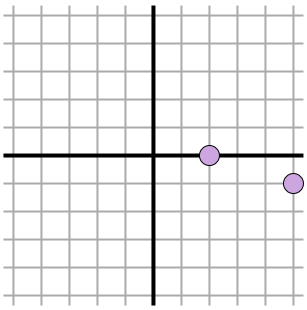

4)

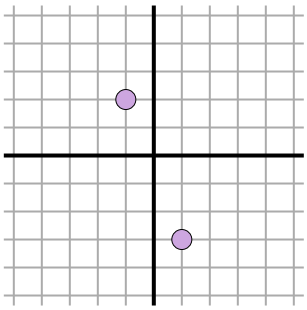

5)

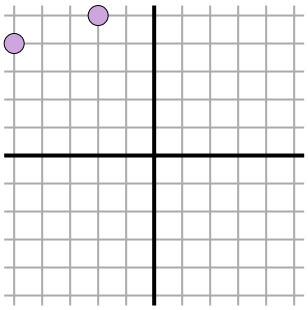

6)

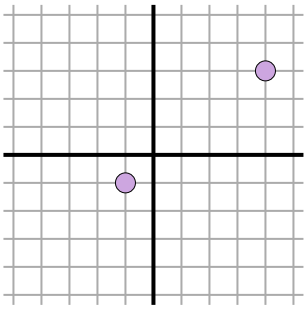

7)

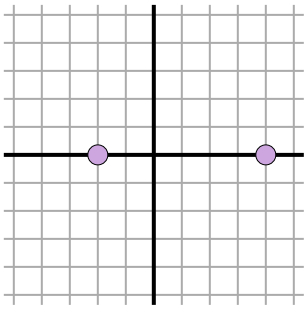

8)

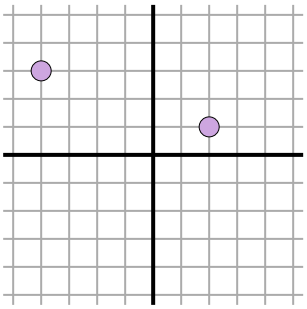

9)

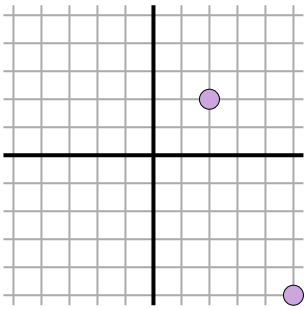

10)

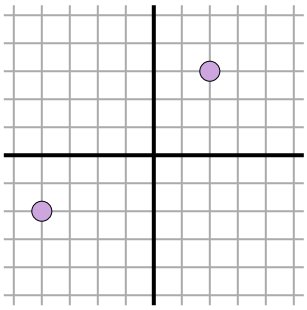

11)

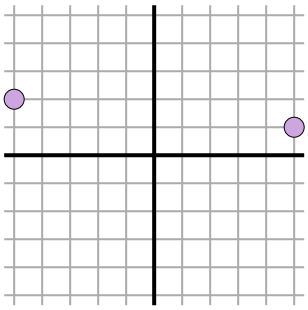

Respuestas

Ej. 4

1. _____
2. _____
3. _____
4. _____
5. _____
6. _____
7. _____
8. _____
9. _____
10. _____
11. _____

1-10	91	82	73	64	55	45	36	27	18	9
11	0									

Encuentra la distancia entre puntos. Redondea tu respuesta al decimal más cercano.

Ej)

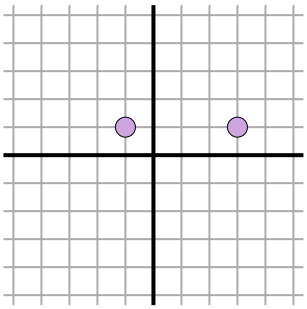

$\sqrt{(-1-3)^2 + (1-1)^2}$

$\sqrt{(16) + (0)}$

1)

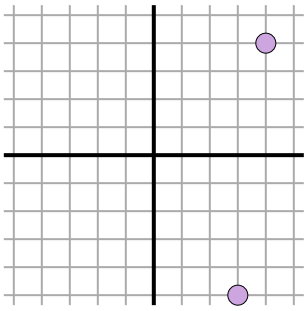

$\sqrt{(3-4)^2 + (-5-4)^2}$

$\sqrt{(1) + (81)}$

2)

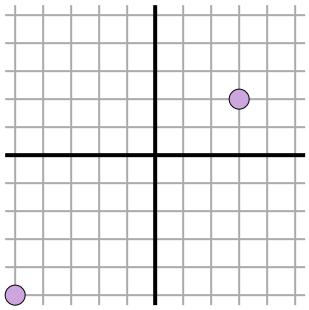

$\sqrt{(3--5)^2 + (2--5)^2}$

$\sqrt{(64) + (49)}$

3)

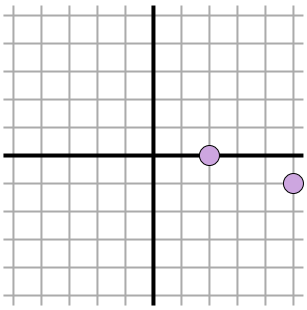

$\sqrt{(5-2)^2 + (-1-0)^2}$

$\sqrt{(9) + (1)}$

4)

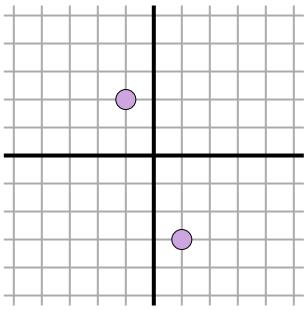

$\sqrt{(-1-1)^2 + (2--3)^2}$

$\sqrt{(4) + (25)}$

5)

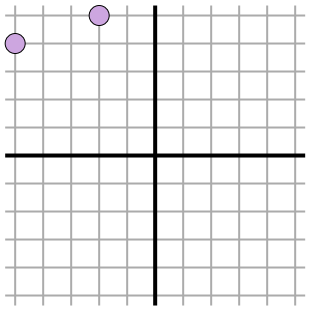

$\sqrt{(-5--2)^2 + (4-5)^2}$

$\sqrt{(9) + (1)}$

6)

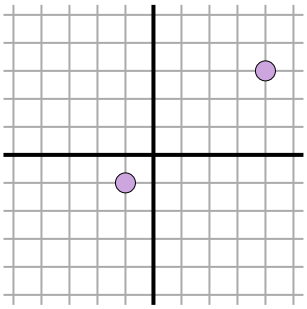

$\sqrt{(-1-4)^2 + (-1-3)^2}$

$\sqrt{(25) + (16)}$

7)

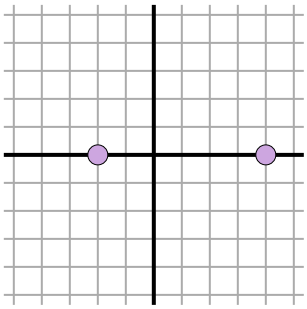

$\sqrt{(-2-4)^2 + (0-0)^2}$

$\sqrt{(36) + (0)}$

8)

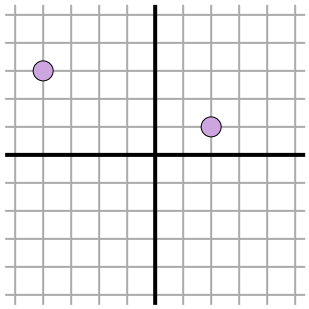

$\sqrt{(-4-2)^2 + (3-1)^2}$

$\sqrt{(36) + (4)}$

9)

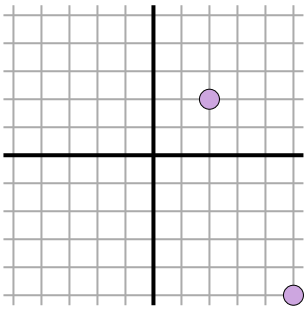

$\sqrt{(5-2)^2 + (-5-2)^2}$

$\sqrt{(9) + (49)}$

10)

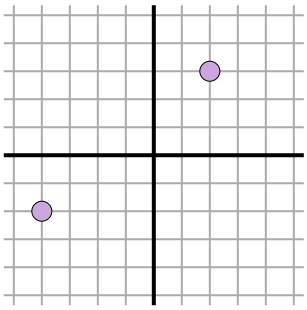

$\sqrt{(2--4)^2 + (3--2)^2}$

$\sqrt{(36) + (25)}$

11)

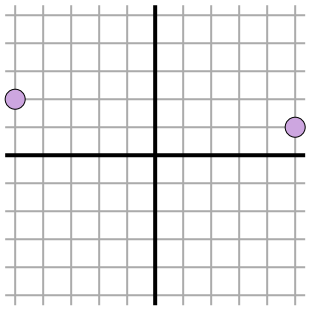

$\sqrt{(-5-5)^2 + (2-1)^2}$

$\sqrt{(100) + (1)}$

Respuestas

Ej.	4
1.	9.1
2.	10.6
3.	3.2
4.	5.4
5.	3.2
6.	6.4
7.	6
8.	6.3
9.	7.6
10.	7.8
11.	10

1-10	91	82	73	64	55	45	36	27	18	9
11	0									