Encontrando la distancia en el plano cartesiano Nombre:

Encuentra la distancia entre puntos. Redondea tu respuesta al decimal más cercano.

Ej)

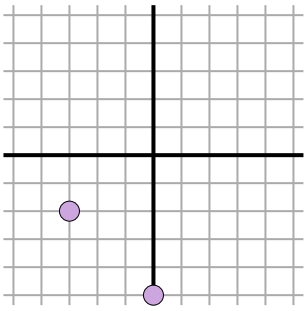

1)

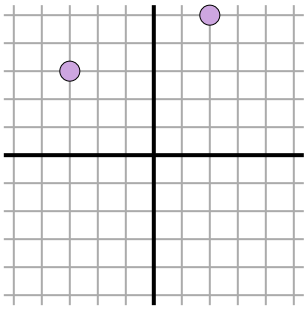

2)

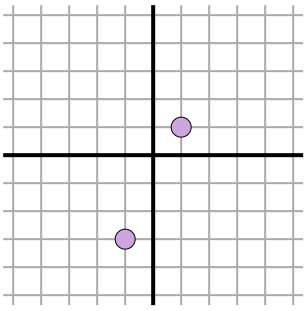

3)

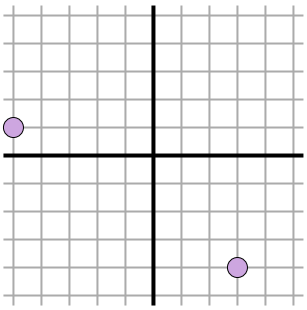

4)

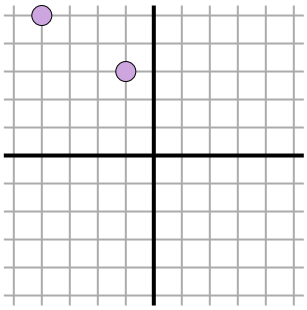

5)

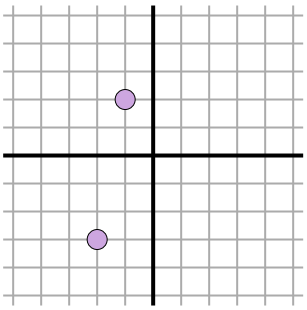

6)

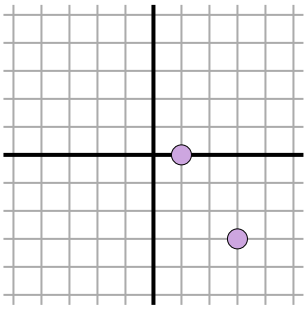

7)

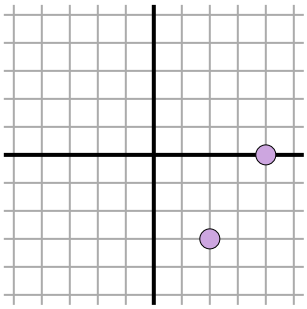

8)

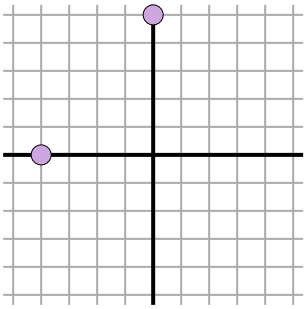

9)

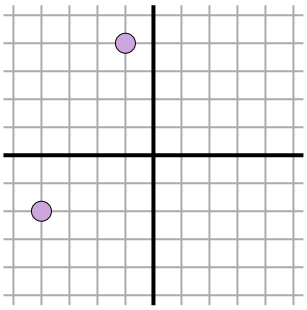

10)

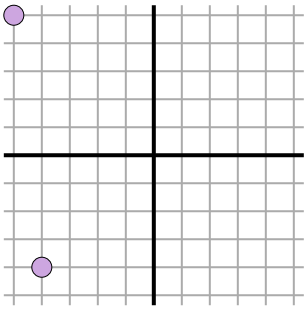

11)

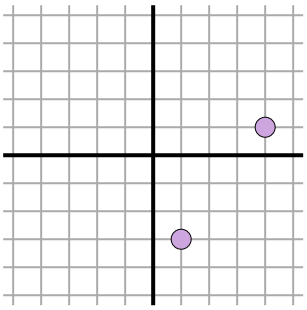

Respuestas

Ej. 4.2

1. _____
2. _____
3. _____
4. _____
5. _____
6. _____
7. _____
8. _____
9. _____
10. _____
11. _____

1-10	91	82	73	64	55	45	36	27	18	9
11	0									

Encuentra la distancia entre puntos. Redondea tu respuesta al decimal más cercano.

Ej)

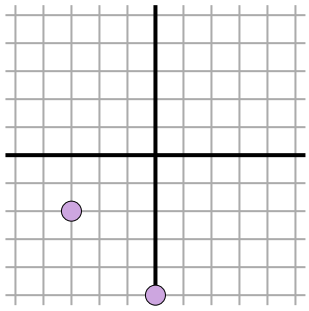

$\sqrt{(0--3)^2 + (-5--2)^2}$

$\sqrt{(9) + (9)}$

1)

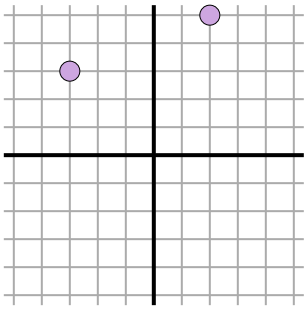

$\sqrt{(2--3)^2 + (5-3)^2}$

$\sqrt{(25) + (4)}$

2)

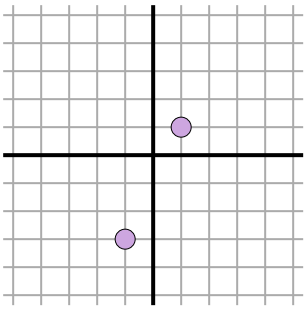

$\sqrt{(-1-1)^2 + (-3-1)^2}$

$\sqrt{(4) + (16)}$

3)

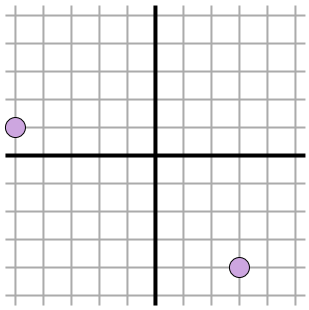

$\sqrt{(3--5)^2 + (-4-1)^2}$

$\sqrt{(64) + (25)}$

4)

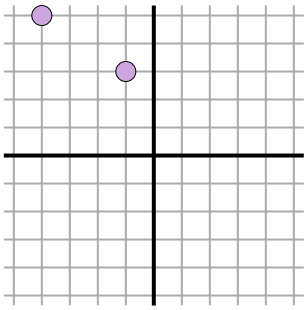

$\sqrt{(-4--1)^2 + (5-3)^2}$

$\sqrt{(9) + (4)}$

5)

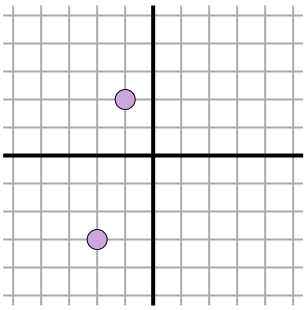

$\sqrt{(-2--1)^2 + (-3-2)^2}$

$\sqrt{(1) + (25)}$

6)

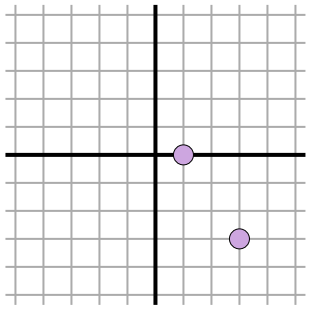

$\sqrt{(1-3)^2 + (0--3)^2}$

$\sqrt{(4) + (9)}$

7)

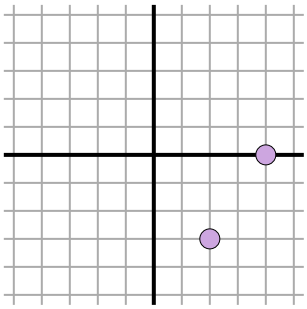

$\sqrt{(4-2)^2 + (0--3)^2}$

$\sqrt{(4) + (9)}$

8)

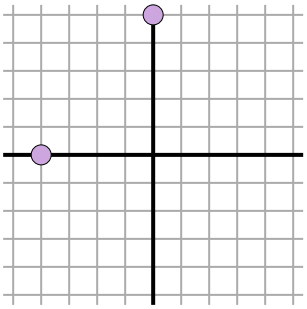

$\sqrt{(0--4)^2 + (5-0)^2}$

$\sqrt{(16) + (25)}$

9)

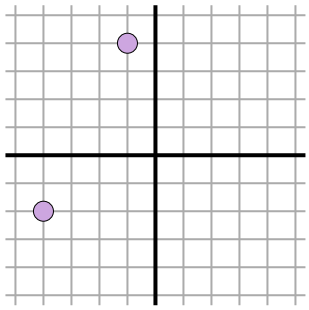

$\sqrt{(-1--4)^2 + (4--2)^2}$

$\sqrt{(9) + (36)}$

10)

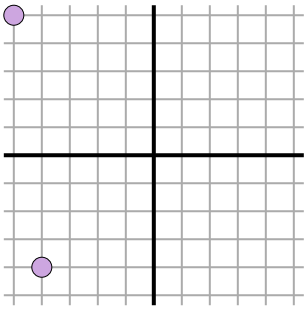

$\sqrt{(-5--4)^2 + (5--4)^2}$

$\sqrt{(1) + (81)}$

11)

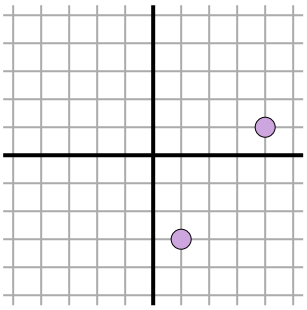

$\sqrt{(1-4)^2 + (-3-1)^2}$

$\sqrt{(9) + (16)}$

Respuestas

Ej.	4.2
1.	5.4
2.	4.5
3.	9.4
4.	3.6
5.	5.1
6.	3.6
7.	3.6
8.	6.4
9.	6.7
10.	9.1
11.	5

1-10	91	82	73	64	55	45	36	27	18	9
11	0									