Encontrando la distancia en un plano cartesiano Nombre:

Encuentra la distancia entre puntos.

Ej)

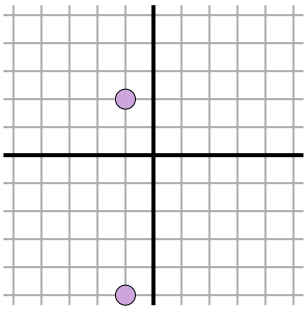

1)

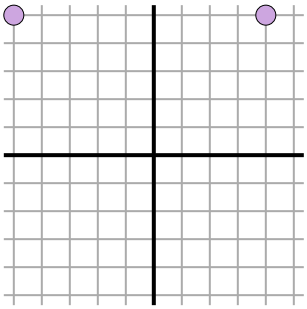

2)

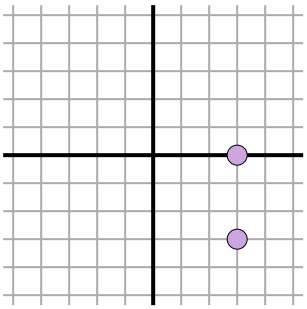

3)

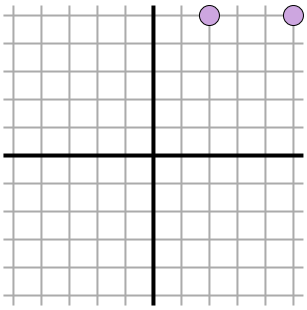

4)

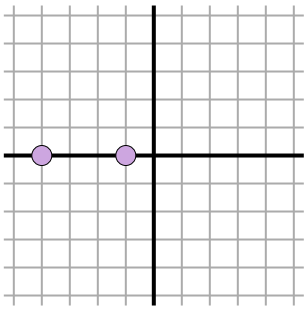

5)

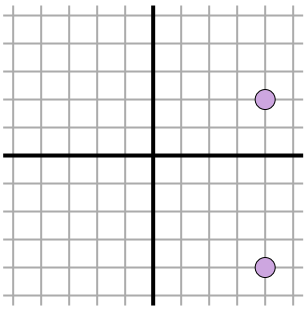

6)

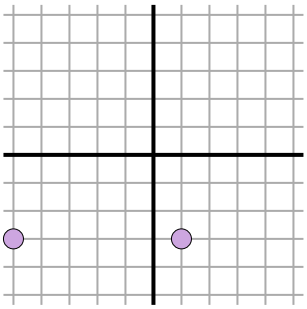

7)

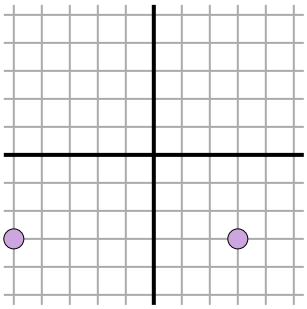

8)

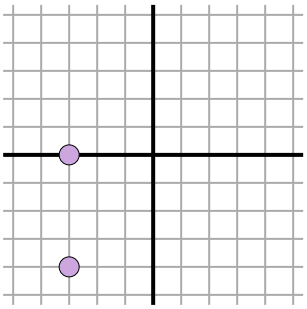

9)

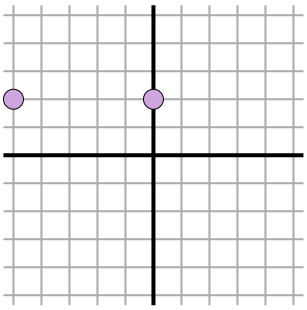

10)

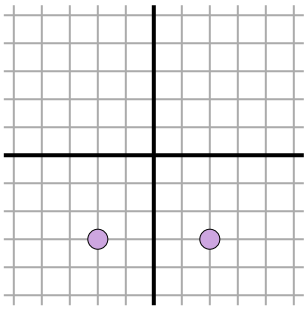

11)

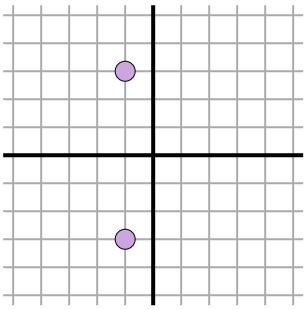

Respuestas

Ej. 7

1. _____

2. _____

3. _____

4. _____

5. _____

6. _____

7. _____

8. _____

9. _____

10. _____

11. _____

1-10	91	82	73	64	55	45	36	27	18	9
11	0									

Encuentra la distancia entre puntos.

Ej)

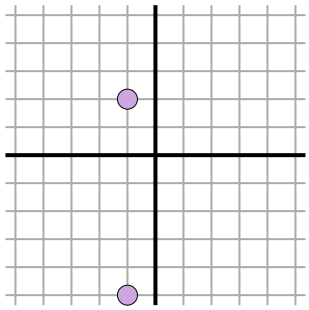

$\sqrt{(-1--1)^2 + (-5-2)^2}$

$\sqrt{(0) + (49)}$

1)

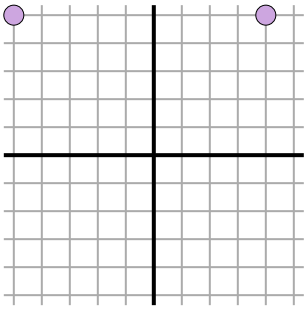

$\sqrt{(-5-4)^2 + (5-5)^2}$

$\sqrt{(81) + (0)}$

2)

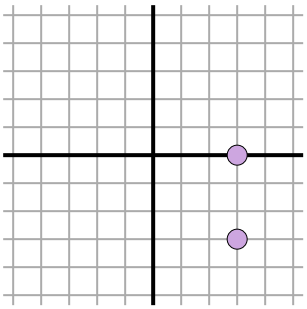

$\sqrt{(3-3)^2 + (-3-0)^2}$

$\sqrt{(0) + (9)}$

3)

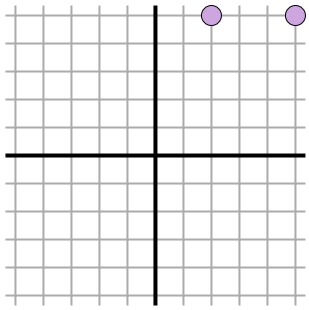

$\sqrt{(5-2)^2 + (5-5)^2}$

$\sqrt{(9) + (0)}$

4)

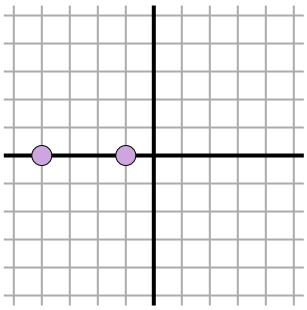

$\sqrt{(-4--1)^2 + (0-0)^2}$

$\sqrt{(9) + (0)}$

5)

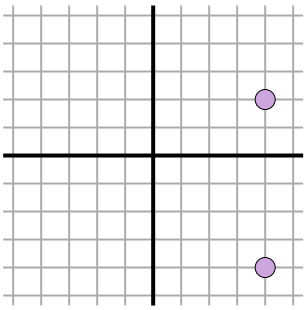

$\sqrt{(4-4)^2 + (2--4)^2}$

$\sqrt{(0) + (36)}$

6)

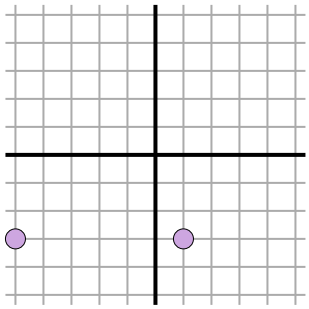

$\sqrt{(1--5)^2 + (-3--3)^2}$

$\sqrt{(36) + (0)}$

7)

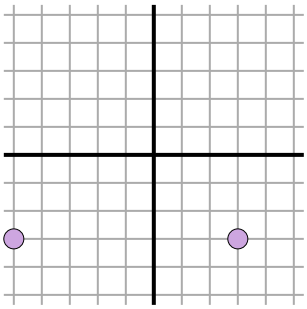

$\sqrt{(-5-3)^2 + (-3--3)^2}$

$\sqrt{(64) + (0)}$

8)

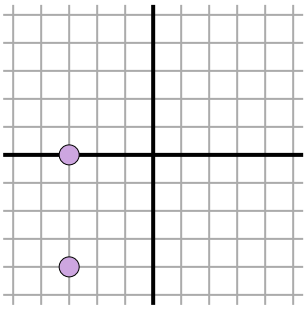

$\sqrt{(-3--3)^2 + (0--4)^2}$

$\sqrt{(0) + (16)}$

9)

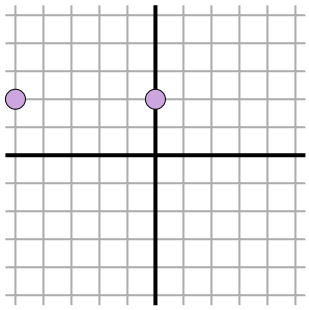

$\sqrt{(-5-0)^2 + (2-2)^2}$

$\sqrt{(25) + (0)}$

10)

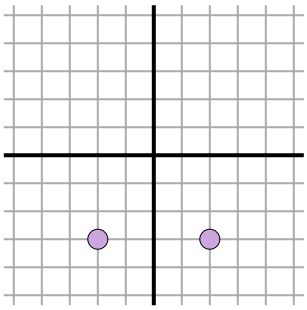

$\sqrt{(-2-2)^2 + (-3--3)^2}$

$\sqrt{(16) + (0)}$

11)

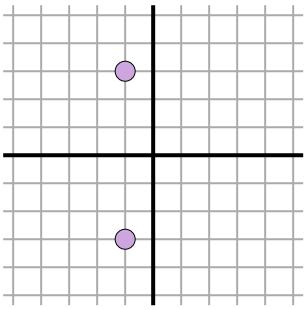

$\sqrt{(-1--1)^2 + (3--3)^2}$

$\sqrt{(0) + (36)}$

Respuestas

Ej.	7
1.	9
2.	3
3.	3
4.	3
5.	6
6.	6
7.	8
8.	4
9.	5
10.	4
11.	6

1-10	91	82	73	64	55	45	36	27	18	9
11	0									