Encontrando la distancia en un plano cartesiano Nombre:

**Encuentra la distancia entre puntos.**

**Ej)**

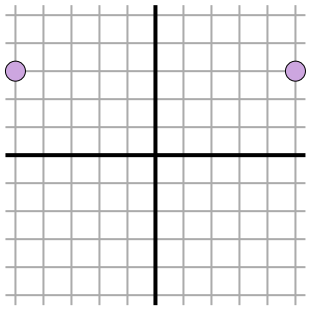

**1)**

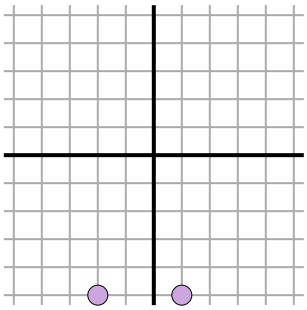

**2)**

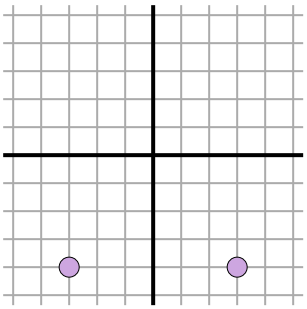

**3)**

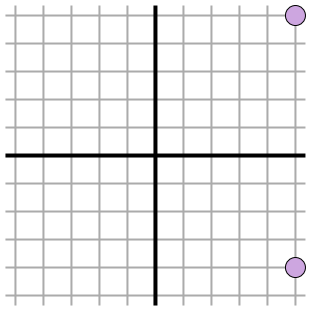

**4)**

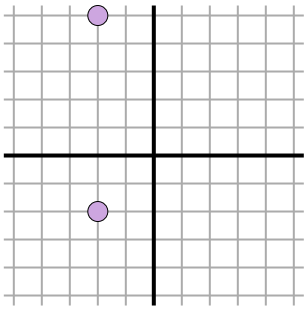

**5)**

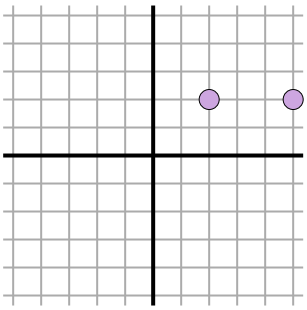

**6)**

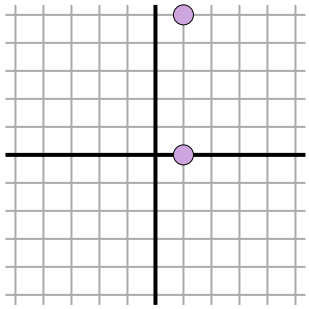

**7)**

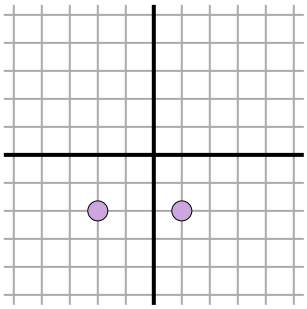

**8)**

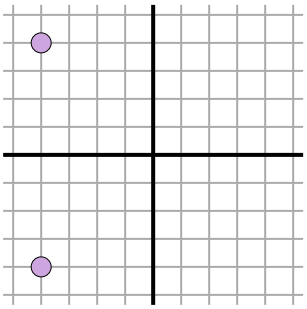

**9)**

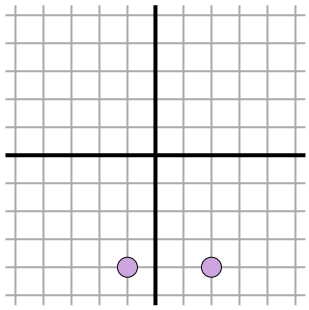

**10)**

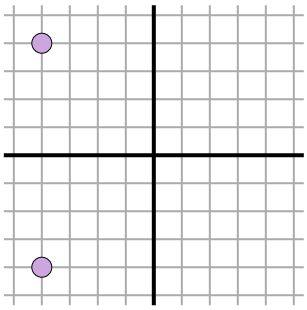

**11)**

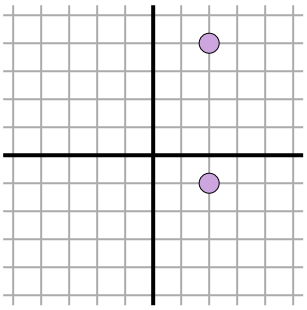

**Respuestas**

Ej. 10

1. _____
2. _____
3. _____
4. _____
5. _____
6. _____
7. _____
8. _____
9. _____
10. _____
11. _____



| | | | | | | | | | | |
|---|---|---|---|---|---|---|---|---|---|---|
| 1-10 | 91 | 82 | 73 | 64 | 55 | 45 | 36 | 27 | 18 | 9 |
| 11 | 0 | | | | | | | | | |

Encontrando la distancia en un plano cartesiano Nombre: **Clave De Respuestas**

**Encuentra la distancia entre puntos.**

**Ej)**

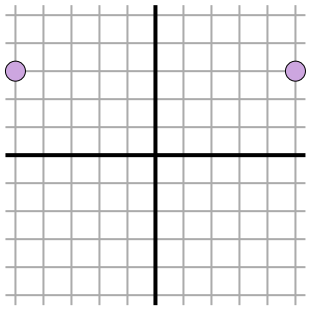

$\sqrt{(-5-5)^2 + (3-3)^2}$

$\sqrt{(100) + (0)}$

**1)**

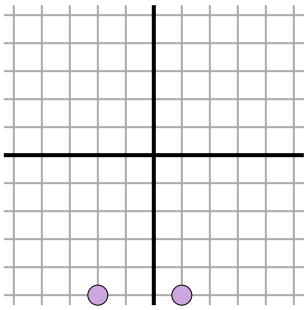

$\sqrt{(1--2)^2 + (-5--5)^2}$

$\sqrt{(9) + (0)}$

**2)**

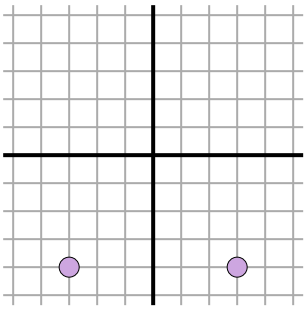

$\sqrt{(-3-3)^2 + (-4--4)^2}$

$\sqrt{(36) + (0)}$

**3)**

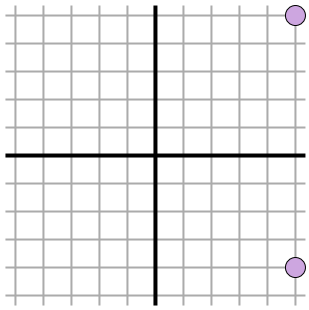

$\sqrt{(5-5)^2 + (5--4)^2}$

$\sqrt{(0) + (81)}$

**4)**

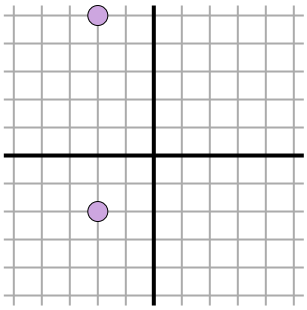

$\sqrt{(-2--2)^2 + (5--2)^2}$

$\sqrt{(0) + (49)}$

**5)**

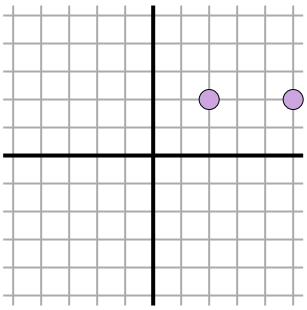

$\sqrt{(5-2)^2 + (2-2)^2}$

$\sqrt{(9) + (0)}$

**6)**

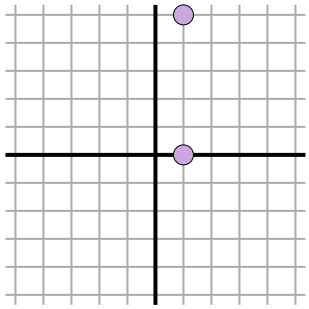

$\sqrt{(1-1)^2 + (0-5)^2}$

$\sqrt{(0) + (25)}$

**7)**

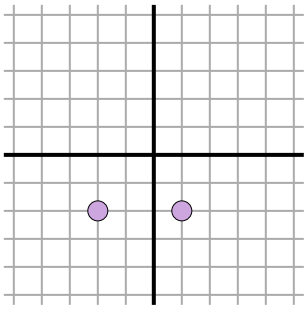

$\sqrt{(1--2)^2 + (-2--2)^2}$

$\sqrt{(9) + (0)}$

**8)**

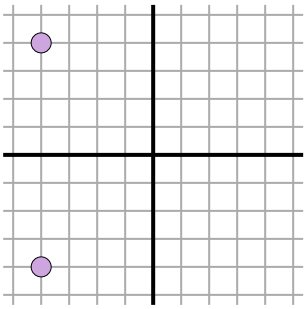

$\sqrt{(-4--4)^2 + (-4-4)^2}$

$\sqrt{(0) + (64)}$

**9)**

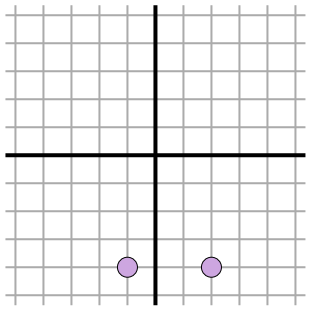

$\sqrt{(-1-2)^2 + (-4--4)^2}$

$\sqrt{(9) + (0)}$

**10)**

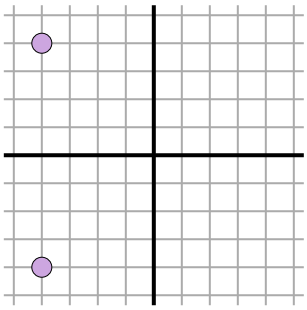

$\sqrt{(-4--4)^2 + (4--4)^2}$

$\sqrt{(0) + (64)}$

**11)**

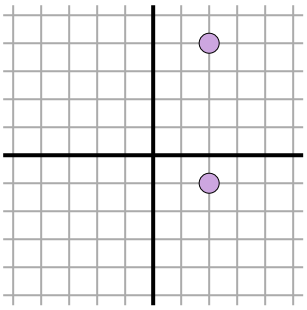

$\sqrt{(2-2)^2 + (4--1)^2}$

$\sqrt{(0) + (25)}$

## Respuestas

| | |
|---|---|
| Ej. | 10 |
| 1. | 3 |
| 2. | 6 |
| 3. | 9 |
| 4. | 7 |
| 5. | 3 |
| 6. | 5 |
| 7. | 3 |
| 8. | 8 |
| 9. | 3 |
| 10. | 8 |
| 11. | 5 |



| | | | | | | | | | | |
|---|---|---|---|---|---|---|---|---|---|---|
| 1-10 | 91 | 82 | 73 | 64 | 55 | 45 | 36 | 27 | 18 | 9 |
| 11 | 0 | | | | | | | | | |