Encontrando la distancia en un plano cartesiano Nombre:

Encuentra la distancia entre puntos.

Ej)

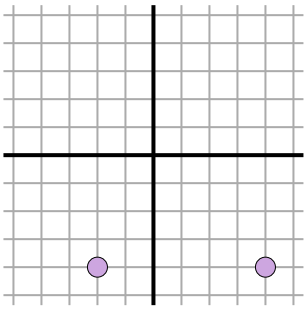

1)

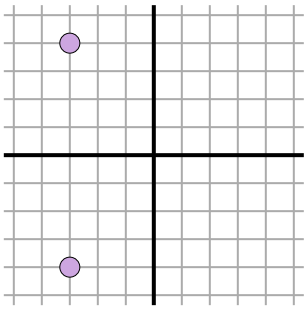

2)

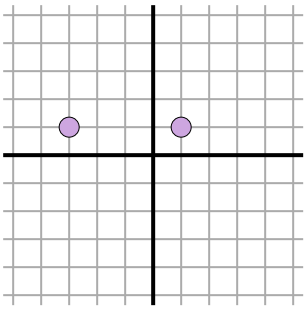

3)

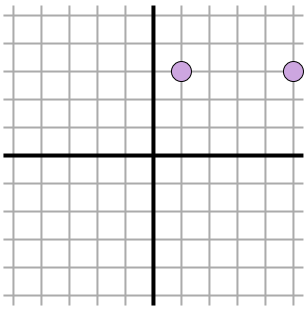

4)

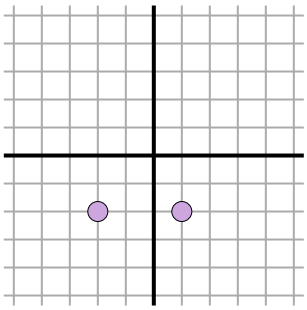

5)

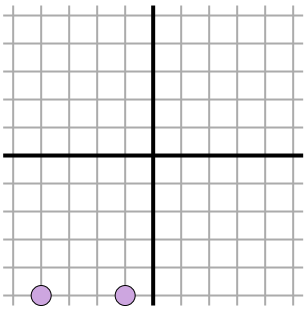

6)

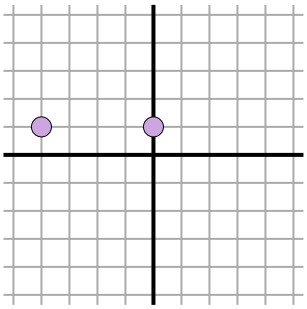

7)

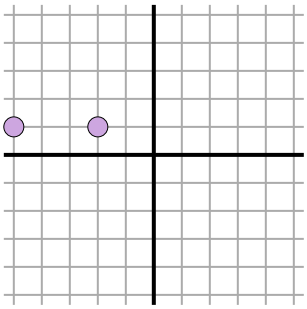

8)

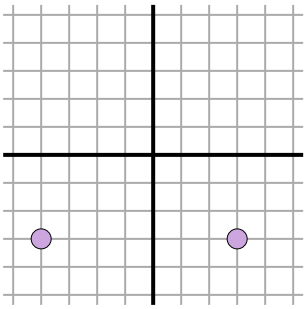

9)

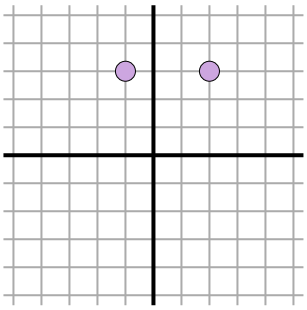

10)

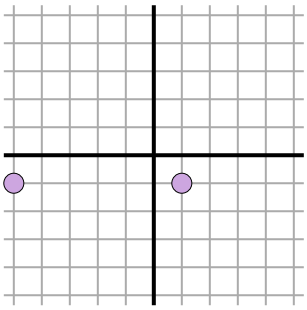

11)

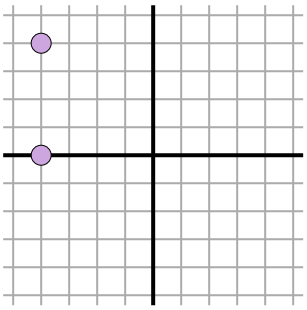

Respuestas

Ej. 6

1. _____
2. _____
3. _____
4. _____
5. _____
6. _____
7. _____
8. _____
9. _____
10. _____
11. _____

1-10	91	82	73	64	55	45	36	27	18	9
11	0									

Encontrando la distancia en un plano cartesiano

Nombre: **Clave De Respuestas**

Encuentra la distancia entre puntos.

Ej)

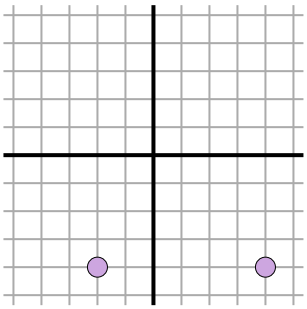

$\sqrt{(4--2)^2 + (-4--4)^2}$

$\sqrt{(36) + (0)}$

1)

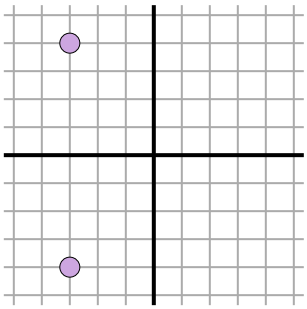

$\sqrt{(-3--3)^2 + (-4-4)^2}$

$\sqrt{(0) + (64)}$

2)

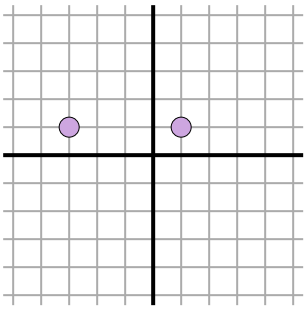

$\sqrt{(1--3)^2 + (1-1)^2}$

$\sqrt{(16) + (0)}$

3)

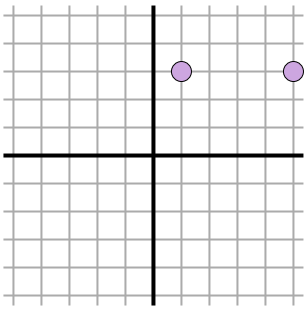

$\sqrt{(5-1)^2 + (3-3)^2}$

$\sqrt{(16) + (0)}$

4)

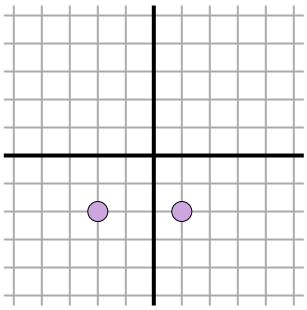

$\sqrt{(-2-1)^2 + (-2--2)^2}$

$\sqrt{(9) + (0)}$

5)

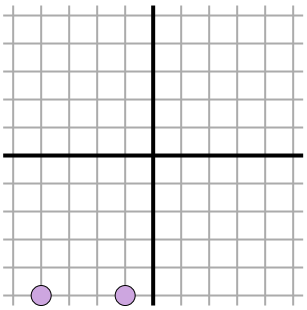

$\sqrt{(-4--1)^2 + (-5--5)^2}$

$\sqrt{(9) + (0)}$

6)

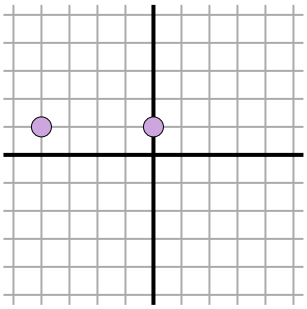

$\sqrt{(-4-0)^2 + (1-1)^2}$

$\sqrt{(16) + (0)}$

7)

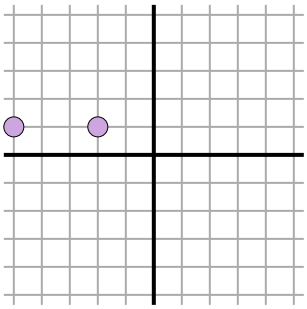

$\sqrt{(-5--2)^2 + (1-1)^2}$

$\sqrt{(9) + (0)}$

8)

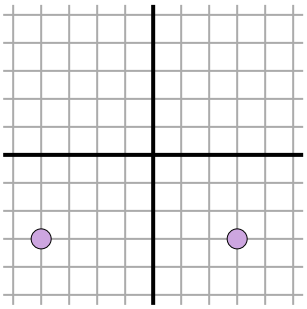

$\sqrt{(3--4)^2 + (-3--3)^2}$

$\sqrt{(49) + (0)}$

9)

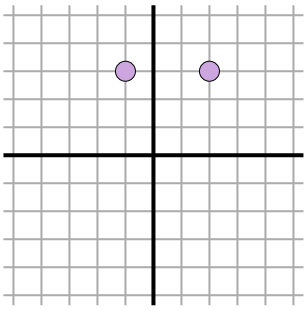

$\sqrt{(2--1)^2 + (3-3)^2}$

$\sqrt{(9) + (0)}$

10)

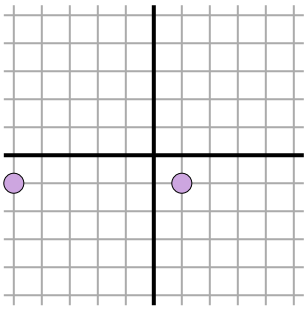

$\sqrt{(-5-1)^2 + (-1--1)^2}$

$\sqrt{(36) + (0)}$

11)

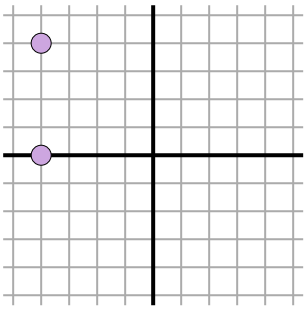

$\sqrt{(-4--4)^2 + (0-4)^2}$

$\sqrt{(0) + (16)}$

Respuestas

Ej.	6
1.	8
2.	4
3.	4
4.	3
5.	3
6.	4
7.	3
8.	7
9.	3
10.	6
11.	4