Medición y visualización de datos Nombre:

Mida cada ITEM punta a punta y luego coloque sus resultados en la gráfica de línea.

Ej) 

1) 

2) 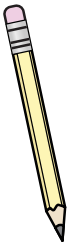

3)

4)

5) 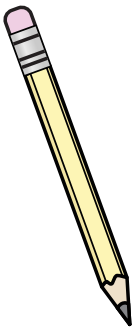

6) 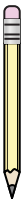

7)

8)

9) 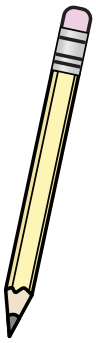

10) 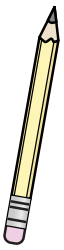

11) 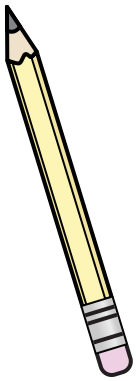

Line Plot							
¼	½	¾	1	1 ¼	1 ½	1 ¾	2

Respuestas

Ej. 2

1. _____
2. _____
3. _____
4. _____
5. _____
6. _____
7. _____
8. _____
9. _____
10. _____
11. _____

1-10	91	82	73	64	55	45	36	27	18	9
11	0									

Mida cada ITEM punta a punta y luego coloque sus resultados en la gráfica de línea.

Ej)



1)



2)

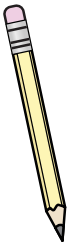

3)

4)

5)

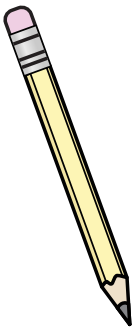

6)

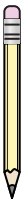

7)

8)

9)

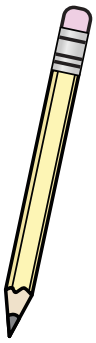

10)



11)

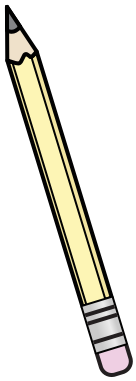

Line Plot

		X		X		X	X
X	X	X	X	X	X	X	X
$\frac{1}{4}$	$\frac{1}{2}$	$\frac{3}{4}$	1	$1\frac{1}{4}$	$1\frac{1}{2}$	$1\frac{3}{4}$	2

Respuestas

Ej.	2
1.	$1\frac{1}{2}$
2.	$1\frac{1}{4}$
3.	$\frac{3}{4}$
4.	$\frac{1}{2}$
5.	$1\frac{3}{4}$
6.	1
7.	$\frac{1}{4}$
8.	$\frac{3}{4}$
9.	$1\frac{3}{4}$
10.	$1\frac{1}{4}$
11.	2

1-10	91	82	73	64	55	45	36	27	18	9
11	0									

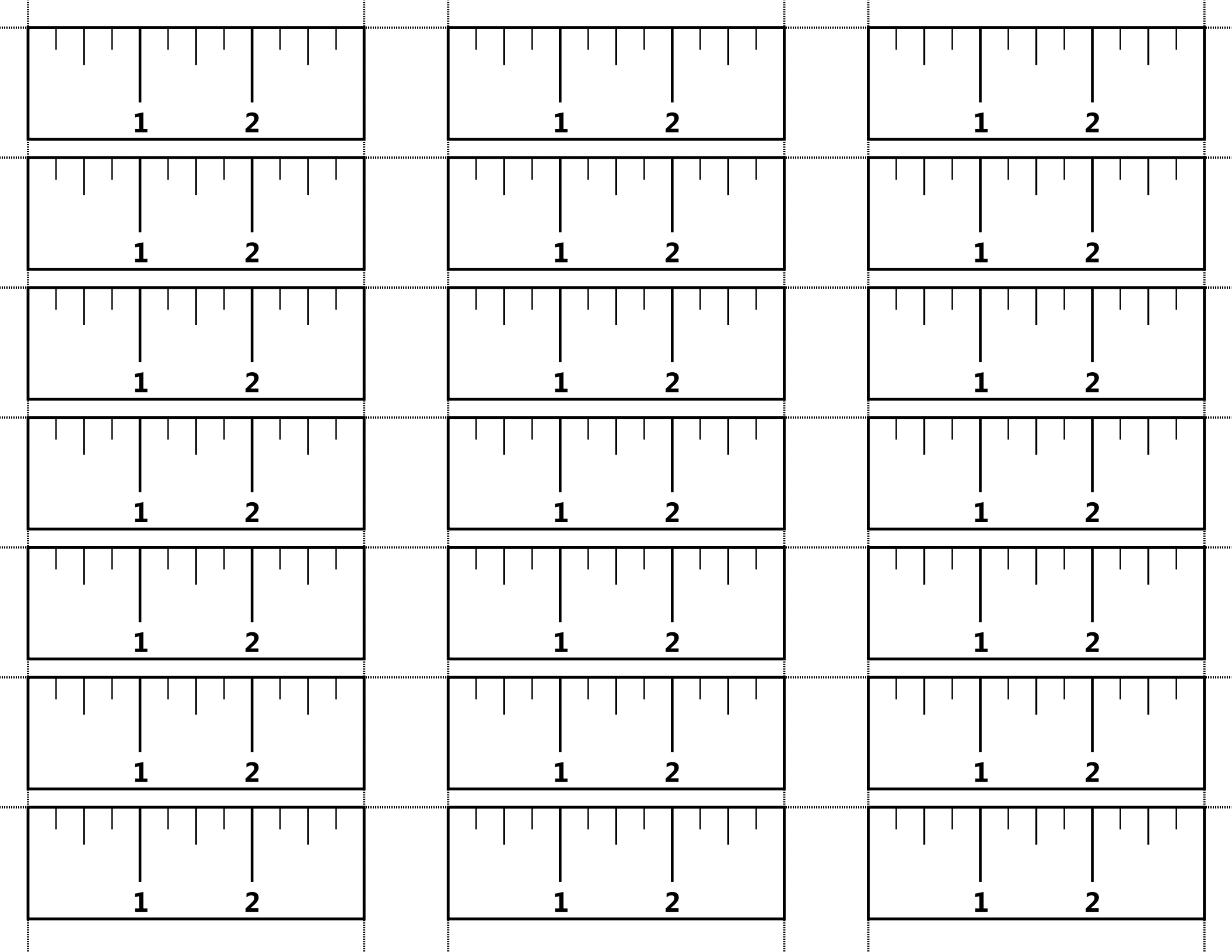
1
2