Multiplicando con una Recta Numérica

Nombre:

Usar la recta numérica para resolver cada problema.

1) 3 × 10 =

10 × 3 =

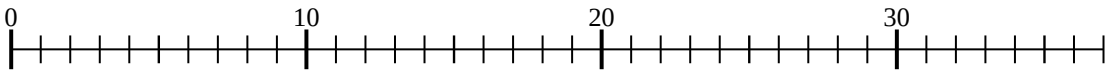

2) 4 × 7 =

7 × 4 =

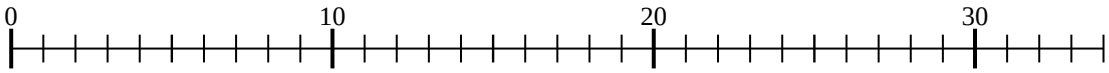

3) 2 × 3 =

3 × 2 =

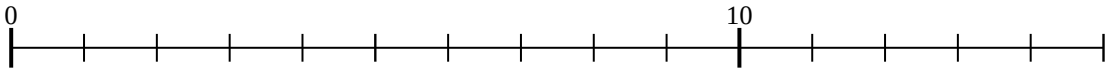

4) 4 × 8 =

8 × 4 =

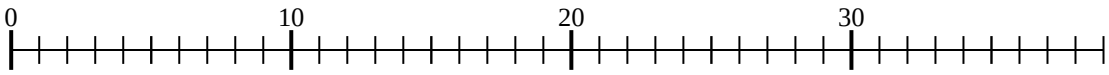

5) 5 × 3 =

3 × 5 =

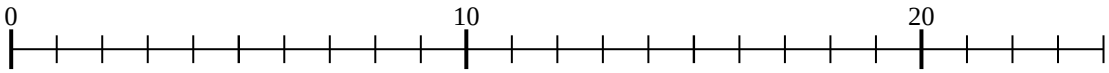

6) 2 × 5 =

5 × 2 =

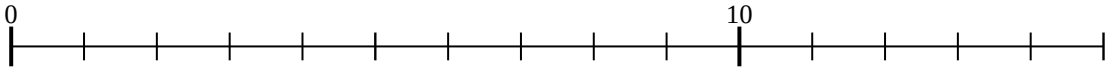

7) 3 × 6 =

6 × 3 =

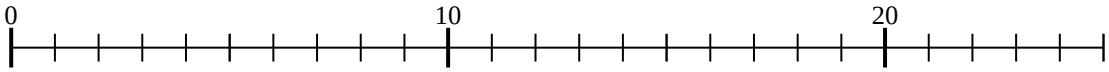

8) 2 × 10 =

10 × 2 =

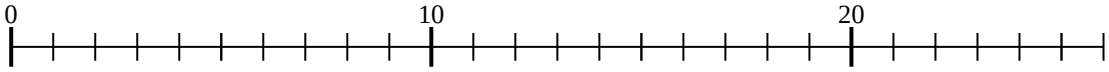

9) 4 × 9 =

9 × 4 =

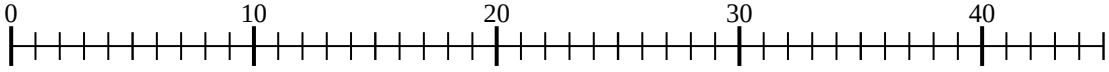

10) 5 × 8 =

8 × 5 =

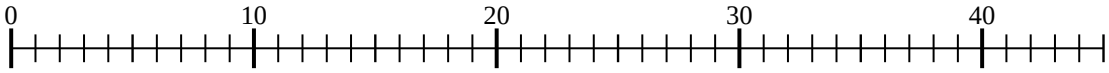

11) 3 × 3 =

3 × 3 =

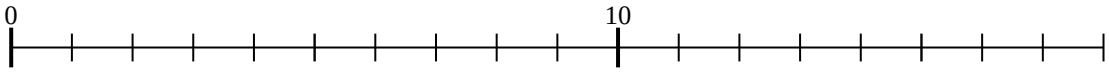

Respuestas

1. _____
2. _____
3. _____
4. _____
5. _____
6. _____
7. _____
8. _____
9. _____
10. _____
11. _____

1-10	91	82	73	64	55	45	36	27	18	9
11	0									

Multiplicando con una Recta Numérica

Nombre: **Clave De Respuestas**

Usar la recta numérica para resolver cada problema.

1) 3 × 10 =
10 × 3 =

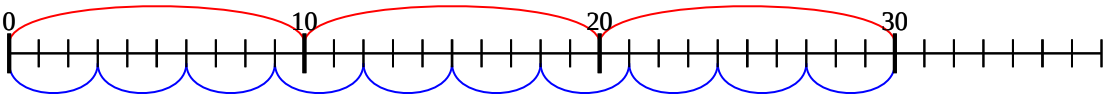

2) 4 × 7 =
7 × 4 =

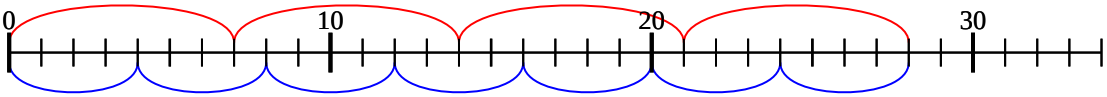

3) 2 × 3 =
3 × 2 =

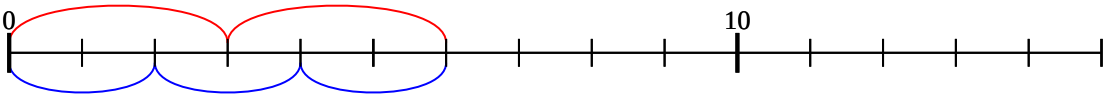

4) 4 × 8 =
8 × 4 =

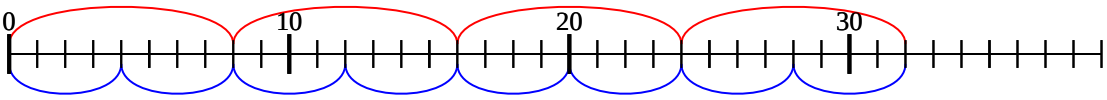

5) 5 × 3 =
3 × 5 =

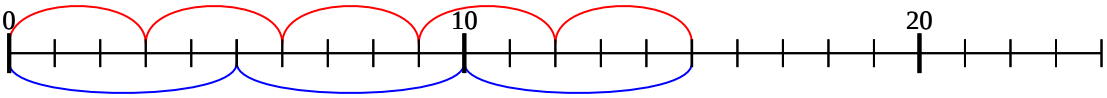

6) 2 × 5 =
5 × 2 =

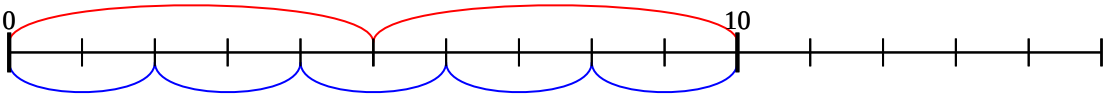

7) 3 × 6 =
6 × 3 =

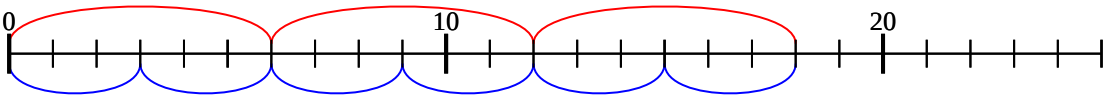

8) 2 × 10 =
10 × 2 =

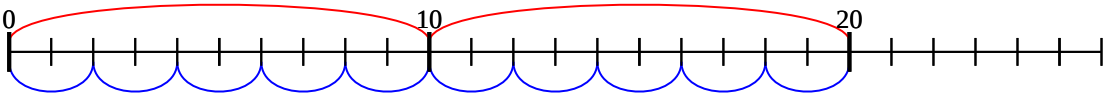

9) 4 × 9 =
9 × 4 =

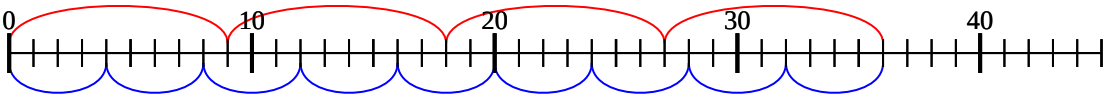

10) 5 × 8 =
8 × 5 =

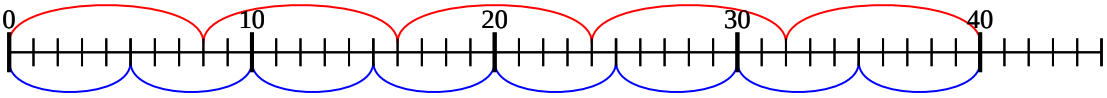

11) 3 × 3 =
3 × 3 =

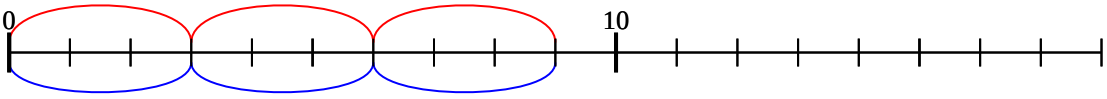

Respuestas

1. **30**
2. **28**
3. **6**
4. **32**
5. **15**
6. **10**
7. **18**
8. **20**
9. **36**
10. **40**
11. **9**

1-10	91	82	73	64	55	45	36	27	18	9
11	0									