# Re-escribiendo problemas de multiplicación (Visual)

Nombre:

**Escribir cada matriz como un problema de multiplicación y resolver.**

**Ej)**

**1)**



**2)**

**3)**

**4)**

**5)**



**6)**

**7)**

**8)**

**9)**



**10)**

**11)**



## Respuestas

Ej. **6 × 3 = 18**

1. _____
2. _____
3. _____
4. _____
5. _____
6. _____
7. _____
8. _____
9. _____
10. _____
11. _____



| | | | | | | | | | | |
|---|---|---|---|---|---|---|---|---|---|---|
| 1-10 | 91 | 82 | 73 | 64 | 55 | 45 | 36 | 27 | 18 | 9 |
| 11 | 0 | | | | | | | | | |

# Re-escribiendo problemas de multiplicación (Visual)

Nombre: **Clave De Respuestas**

**Escribir cada matriz como un problema de multiplicación y resolver.**

**Ej)**

**1)**



**2)**

**3)**

**4)**

**5)**



**6)**

**7)**

**8)**

**9)**



**10)**

**11)**



## Respuestas

Ej. **6 × 3 = 18**

1. **10 × 9 = 90**
2. **9 × 5 = 45**
3. **5 × 2 = 10**
4. **8 × 4 = 32**
5. **9 × 10 = 90**
6. **3 × 2 = 6**
7. **4 × 9 = 36**
8. **10 × 3 = 30**
9. **10 × 7 = 70**
10. **2 × 8 = 16**
11. **3 × 4 = 12**



| | | | | | | | | | | |
|---|---|---|---|---|---|---|---|---|---|---|
| 1-10 | 91 | 82 | 73 | 64 | 55 | 45 | 36 | 27 | 18 | 9 |
| 11 | 0 | | | | | | | | | |