Re-escribiendo problemas de multiplicación (Visual)

Nombre:

Escribir cada matriz como un problema de multiplicación y resolver.

Ej)



1)



2)

3)



4)

5)



6)

7)

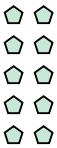

8)

9)

10)



11)

Respuestas

Ej. **10 × 10 = 100**

1. _____
2. _____
3. _____
4. _____
5. _____
6. _____
7. _____
8. _____
9. _____
10. _____
11. _____

1-10	91	82	73	64	55	45	36	27	18	9
11	0									

Re-escribiendo problemas de multiplicación (Visual) Nombre: **Clave De Respuestas**

Escribir cada matriz como un problema de multiplicación y resolver.

Ej)



1)



2)

3)



4)

5)



6)

7)

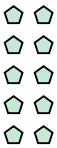

8)

9)

10)



11)

Respuestas

Ej. **10 × 10 = 100**

1. **10 × 7 = 70**
2. **4 × 7 = 28**
3. **10 × 6 = 60**
4. **8 × 2 = 16**
5. **3 × 6 = 18**
6. **6 × 2 = 12**
7. **5 × 2 = 10**
8. **5 × 7 = 35**
9. **5 × 5 = 25**
10. **9 × 9 = 81**
11. **3 × 8 = 24**

1-10	91	82	73	64	55	45	36	27	18	9
11	0									