Re-escribiendo problemas de multiplicación (Visual)

Nombre:

Escribir cada matriz como un problema de multiplicación y resolver.

Ej)



1)



2)



3)

4)



5)



6)



7)

8)

9)



10)



11)

Respuestas

Ej. **6 × 9 = 54**

1. _____
2. _____
3. _____
4. _____
5. _____
6. _____
7. _____
8. _____
9. _____
10. _____
11. _____

1-10	91	82	73	64	55	45	36	27	18	9
11	0									

Re-escribiendo problemas de multiplicación (Visual) Nombre: **Clave De Respuestas**

Escribir cada matriz como un problema de multiplicación y resolver.

Ej)



1)



2)



3)

4)



5)



6)



7)

8)

9)



10)



11)

Respuestas

Ej. **6 × 9 = 54**

1. **7 × 6 = 42**
2. **7 × 2 = 14**
3. **5 × 6 = 30**
4. **6 × 7 = 42**
5. **5 × 8 = 40**
6. **5 × 10 = 50**
7. **2 × 6 = 12**
8. **6 × 3 = 18**
9. **10 × 9 = 90**
10. **8 × 4 = 32**
11. **4 × 7 = 28**

1-10	91	82	73	64	55	45	36	27	18	9
11	0									