Máquinas de Funciones - (Sumar y Restar)

Nombre:

Determina la regla que cada máquina de función está usando.

Ej)

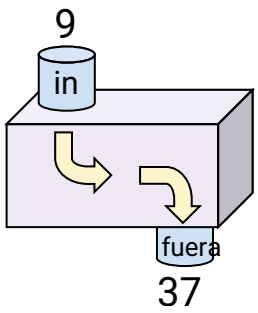

1)

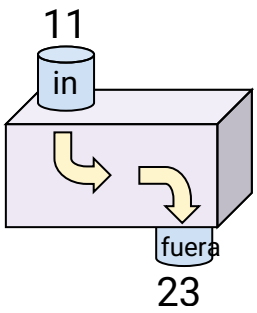

2)

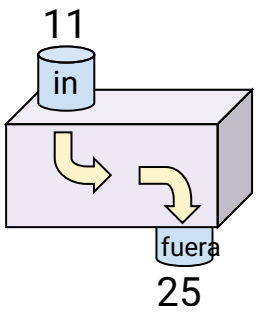

3)

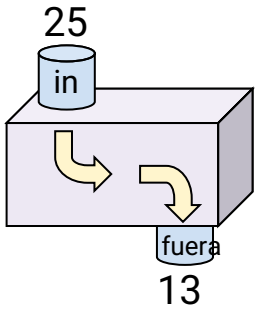

4)

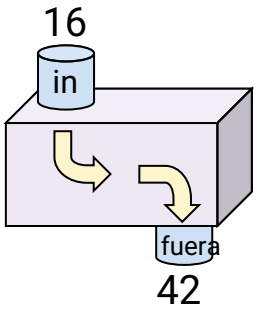

5)

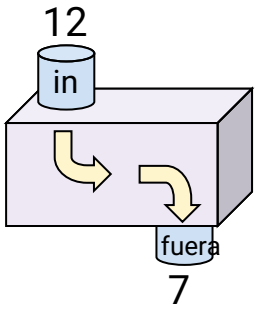

6)

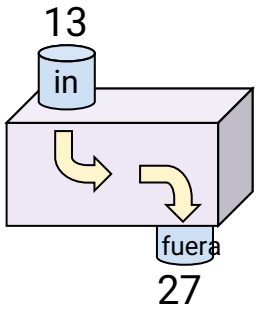

7)

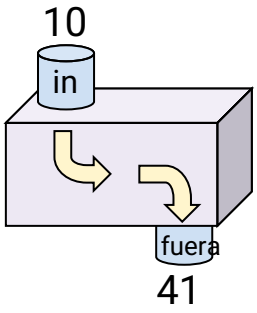

8)

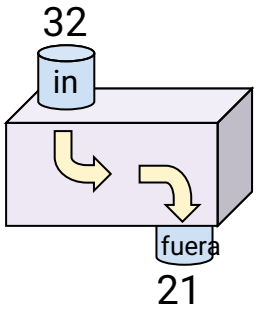

9)

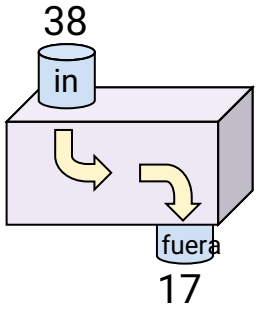

10)

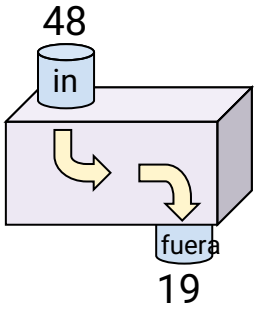

11)

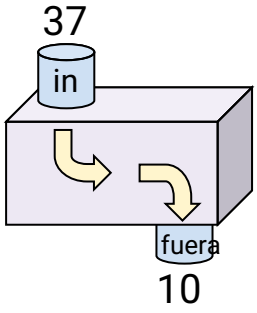

Respuestas

Ej. Sumar 28

1. _____
2. _____
3. _____
4. _____
5. _____
6. _____
7. _____
8. _____
9. _____
10. _____
11. _____

1-10	91	82	73	64	55	45	36	27	18	9
11	0									

Máquinas de Funciones - (Sumar y Restar) Nombre: **Clave De Respuestas**

Determina la regla que cada máquina de función está usando.

Ej)

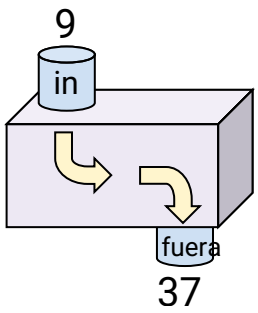

1)

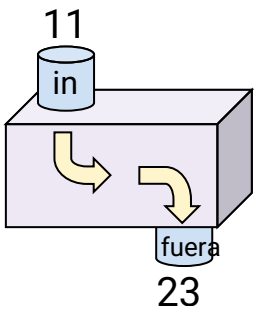

2)

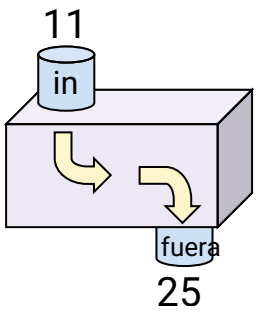

3)

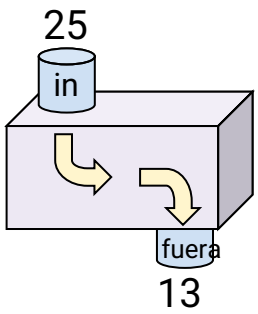

4)

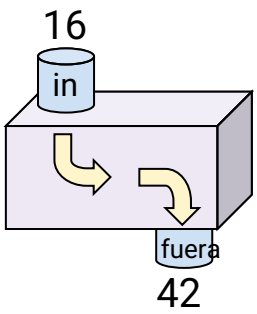

5)

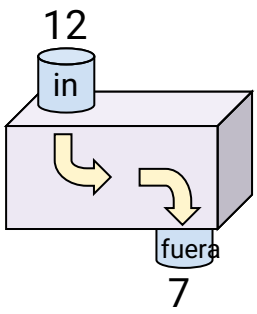

6)

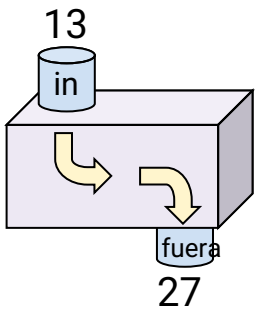

7)

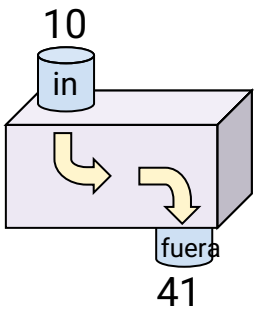

8)

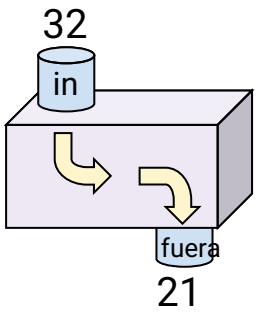

9)

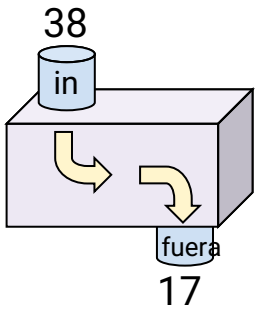

10)

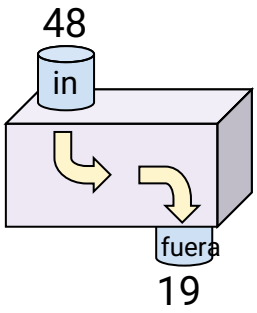

11)

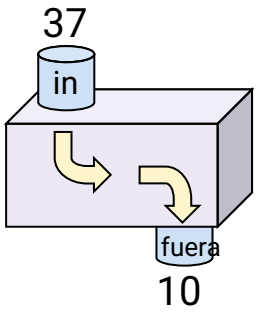

Respuestas

Ej.	Sumar 28
1.	Sumar 12
2.	Sumar 14
3.	Restar 12
4.	Sumar 26
5.	Restar 5
6.	Sumar 14
7.	Sumar 31
8.	Restar 11
9.	Restar 21
10.	Restar 29
11.	Restar 27

1-10	91	82	73	64	55	45	36	27	18	9
11	0									