Máquinas de Funciones - (Sumar y Restar) Nombre:

Determina la regla que cada máquina de función está usando.

Ej)

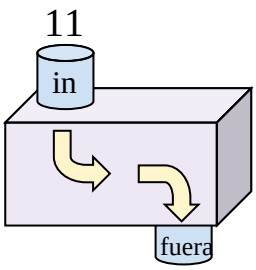

Agregar 20

1)

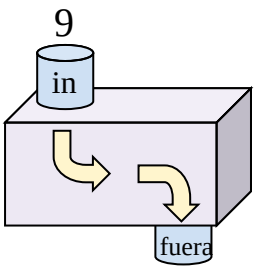

2)

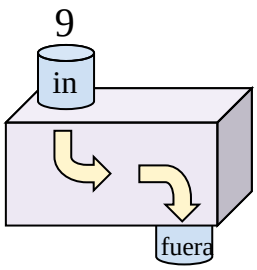

3)

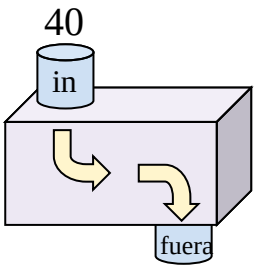

4)

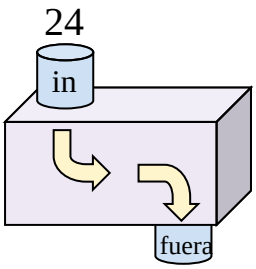

5)

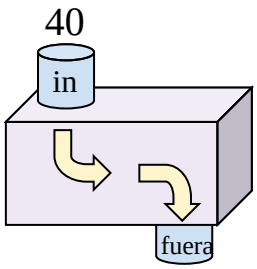

6)

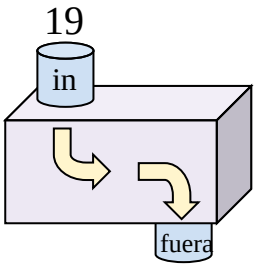

7)

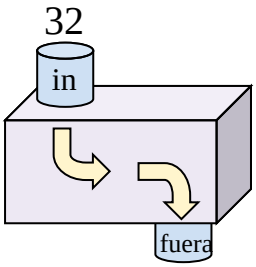

8)

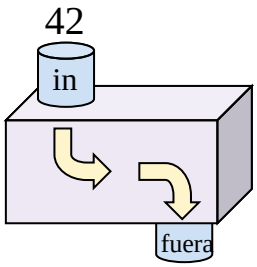

9)

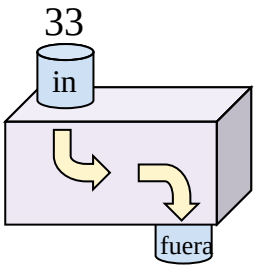

10)

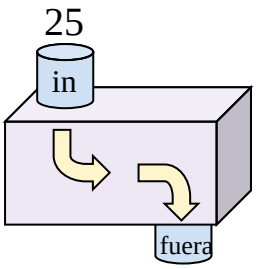

11)

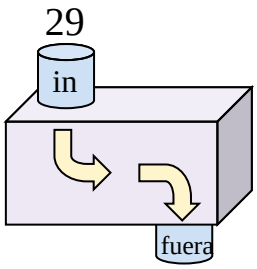

Respuestas

Ej. Agregar 20

1. _____
2. _____
3. _____
4. _____
5. _____
6. _____
7. _____
8. _____
9. _____
10. _____
11. _____

1-10	91	82	73	64	55	45	36	27	18	9
11	0									

Determina la regla que cada máquina de función está usando.

Ej)

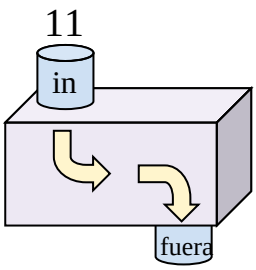

Agregar 20

1)

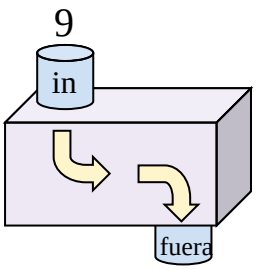

Agregar 27

2)

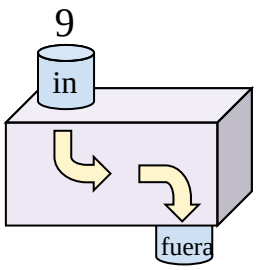

Agregar 25

3)

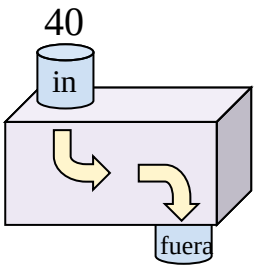

Restar 28

4)

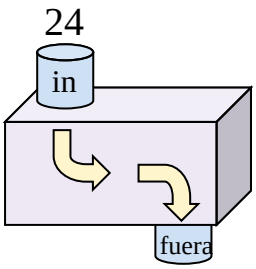

Restar 6

5)

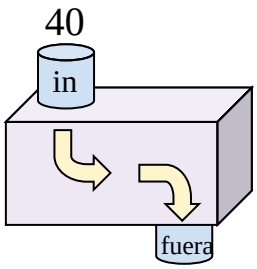

Restar 34

6)

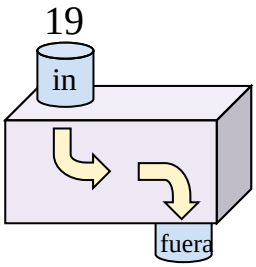

Agregar 14

7)

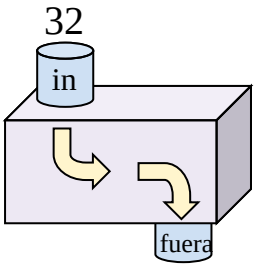

Restar 8

8)

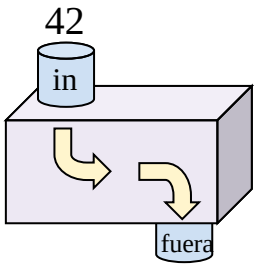

Restar 24

9)

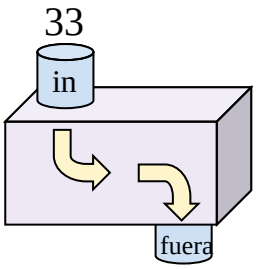

Restar 25

10)

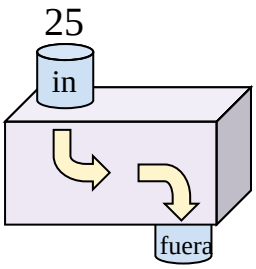

Agregar 14

11)

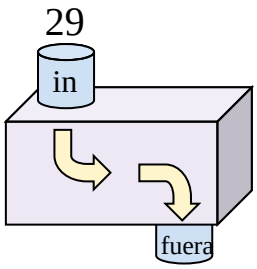

Agregar 9

Respuestas

Ej. **Agregar 20**

1. **Agregar 27**
2. **Agregar 25**
3. **Restar 28**
4. **Restar 6**
5. **Restar 34**
6. **Agregar 14**
7. **Restar 8**
8. **Restar 24**
9. **Restar 25**
10. **Agregar 14**
11. **Agregar 9**

1-10	91	82	73	64	55	45	36	27	18	9
11	0									