Máquinas de Funciones - (Sumar y Restar) Nombre:

Determina la regla que cada máquina de función está usando.

Ej)

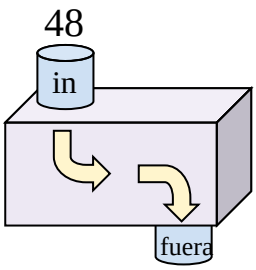

Restar 33

1)

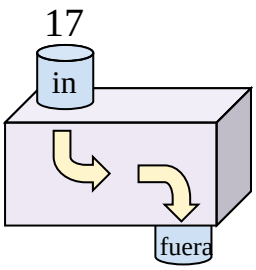

2)

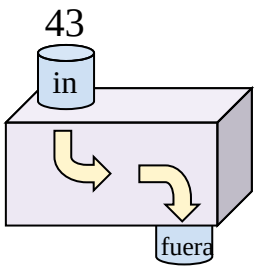

3)

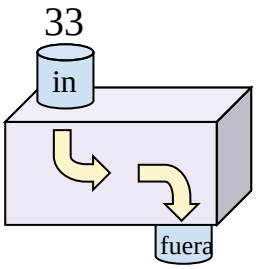

4)

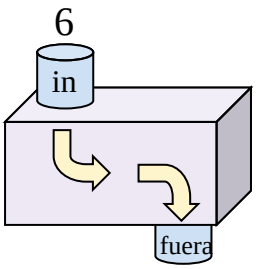

5)

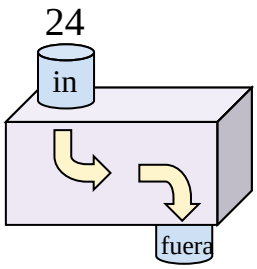

6)

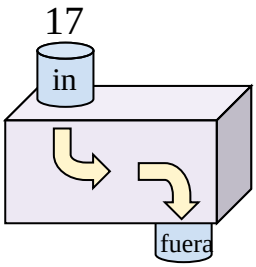

7)

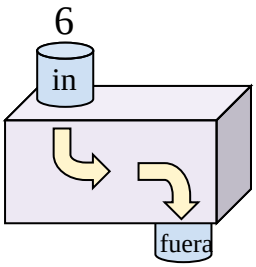

8)

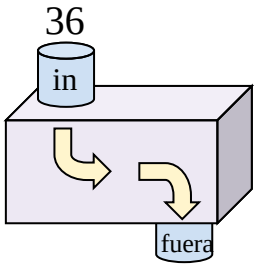

9)

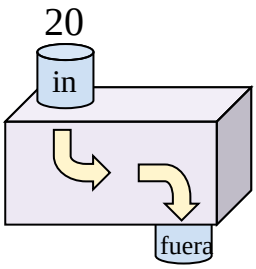

10)

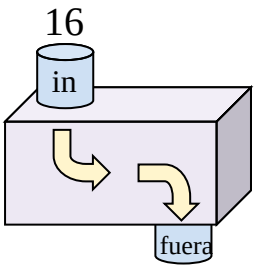

11)

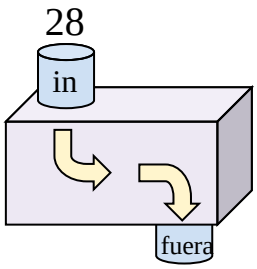

Respuestas

Ej. Restar 33

1. _____
2. _____
3. _____
4. _____
5. _____
6. _____
7. _____
8. _____
9. _____
10. _____
11. _____

1-10	91	82	73	64	55	45	36	27	18	9
11	0									

Determina la regla que cada máquina de función está usando.

Ej)

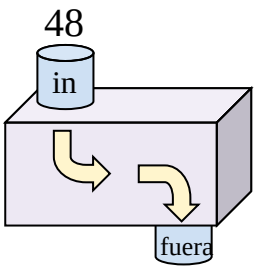

Restar 33

1)

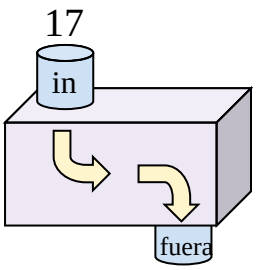

Agregar 15

2)

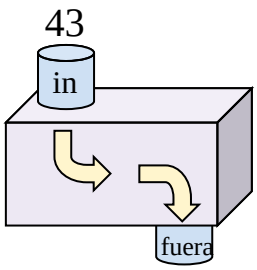

Restar 23

3)

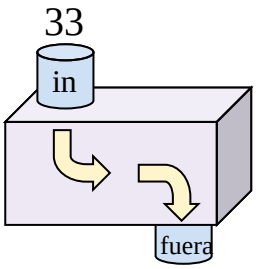

Restar 15

4)

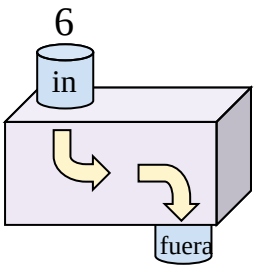

Agregar 36

5)

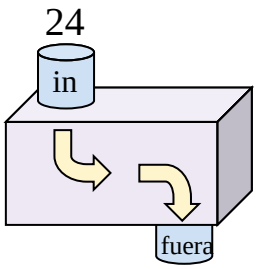

Agregar 14

6)

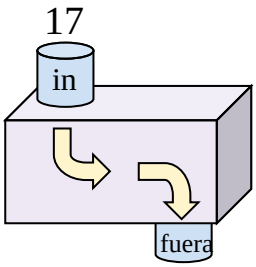

Agregar 9

7)

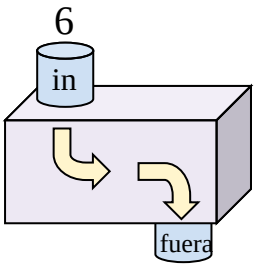

Agregar 14

8)

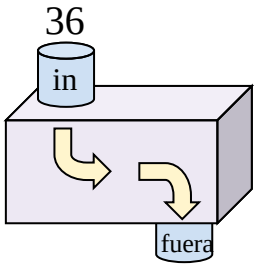

Restar 16

9)

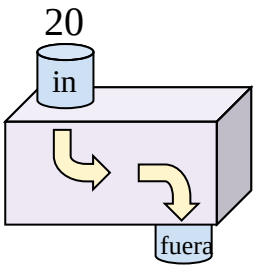

Agregar 8

10)

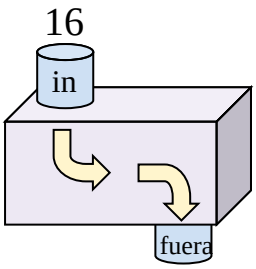

Agregar 19

11)

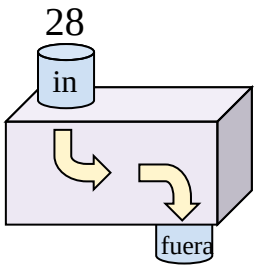

Restar 9

Respuestas

Ej. **Restar 33**

1. **Agregar 15**
2. **Restar 23**
3. **Restar 15**
4. **Agregar 36**
5. **Agregar 14**
6. **Agregar 9**
7. **Agregar 14**
8. **Restar 16**
9. **Agregar 8**
10. **Agregar 19**
11. **Restar 9**

1-10	91	82	73	64	55	45	36	27	18	9
11	0									