Máquinas de Funciones - (Sumar y Restar) Nombre:

Determina la regla que cada máquina de función está usando.

Ej)

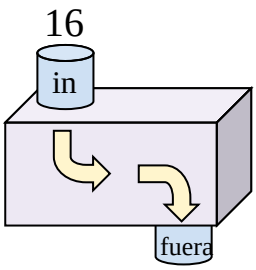

Restar 9

1)

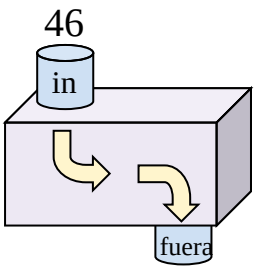

2)

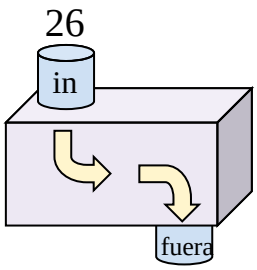

3)

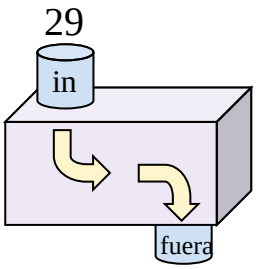

4)

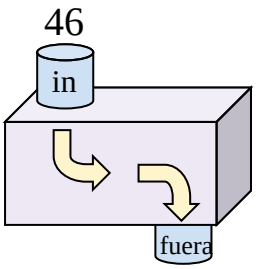

5)

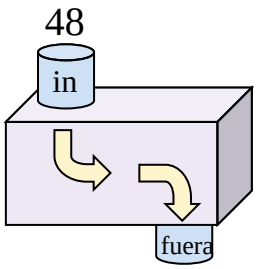

6)

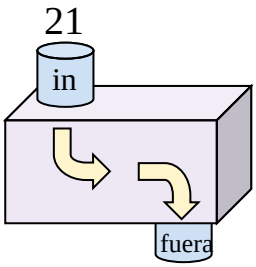

7)

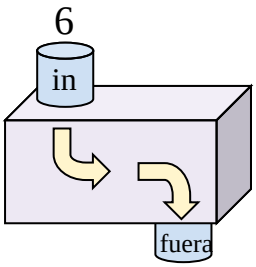

8)

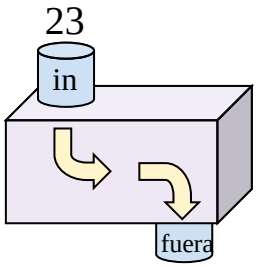

9)

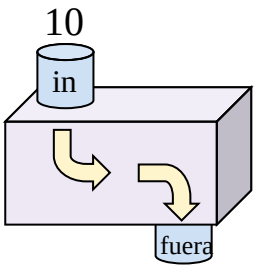

10)

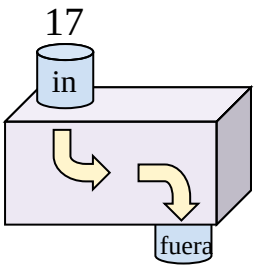

11)

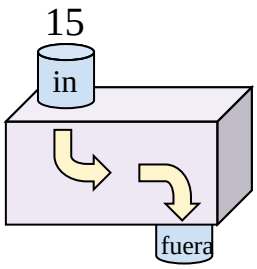

Respuestas

Ej. Restar 9

1. _____
2. _____
3. _____
4. _____
5. _____
6. _____
7. _____
8. _____
9. _____
10. _____
11. _____

Máquinas de Funciones - (Sumar y Restar) Nombre: **Clave De Respuestas**

Determina la regla que cada máquina de función está usando.

Ej)

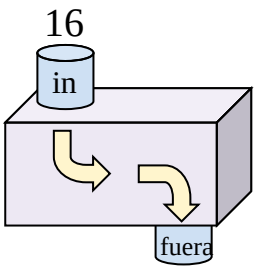

Restar 9

1)

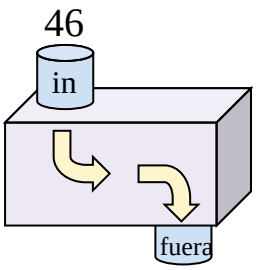

Restar 16

2)

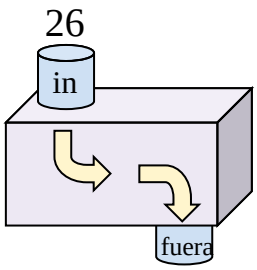

Agregar 23

3)

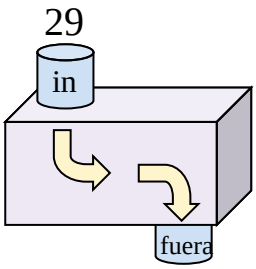

Restar 7

4)

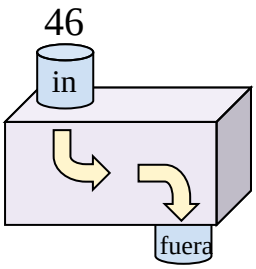

Restar 31

5)

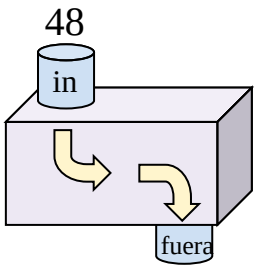

Restar 23

6)

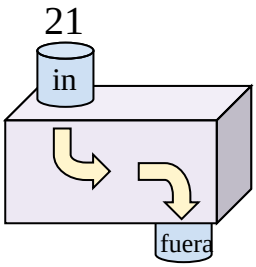

Agregar 22

7)

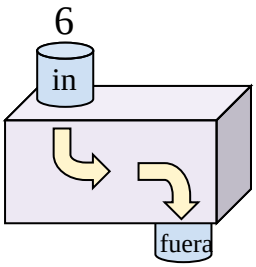

Agregar 37

8)

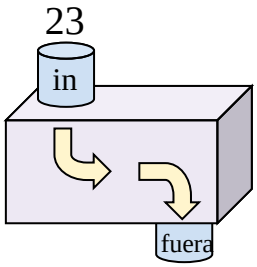

Agregar 6

9)

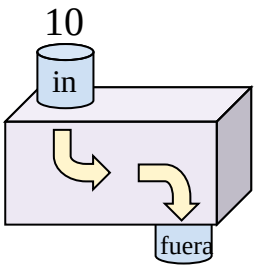

Agregar 34

10)

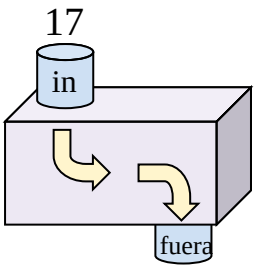

Agregar 27

11)

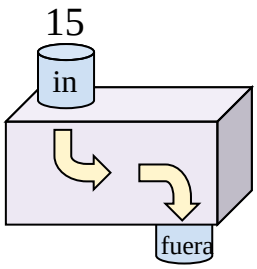

Agregar 15

Respuestas

Ej. **Restar 9**

1. **Restar 16**
2. **Agregar 23**
3. **Restar 7**
4. **Restar 31**
5. **Restar 23**
6. **Agregar 22**
7. **Agregar 37**
8. **Agregar 6**
9. **Agregar 34**
10. **Agregar 27**
11. **Agregar 15**