Contando figuras Nombre:

**Cuenta el número de figuras en cada caja.**

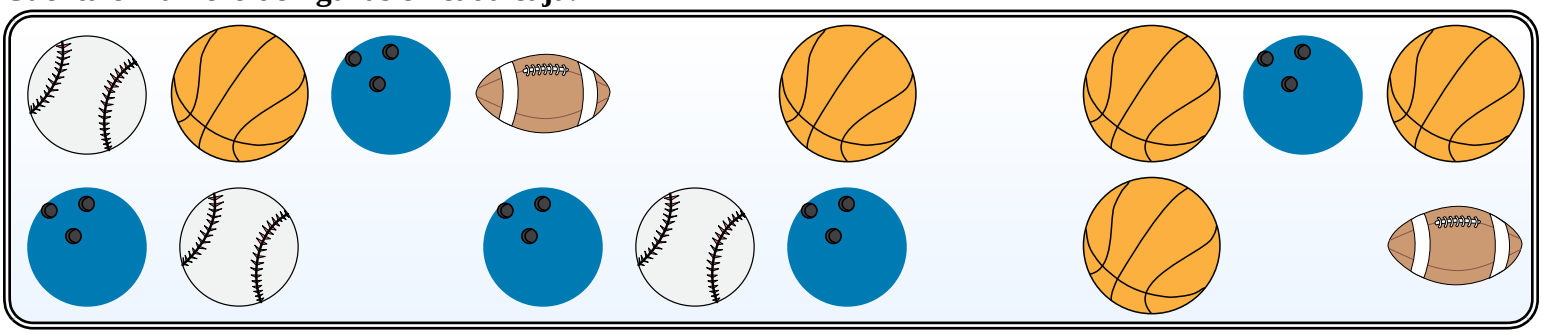

**Ej)** = 3

**1)** = _____

**2)** = _____

**3)** = _____



**4)** = _____

**5)** = _____

**6)** = _____

**7)** = _____



**8)** = _____

**9)** = _____

**10)** = _____

**11)** = _____



| | | | | | | | | | | |
|---|---|---|---|---|---|---|---|---|---|---|
| 1-10 | 91 | 82 | 73 | 64 | 55 | 45 | 36 | 27 | 18 | 9 |
| 11 | 0 | | | | | | | | | |

Contando figuras

Nombre: **Clave De Respuestas**

**Cuenta el número de figuras en cada caja.**

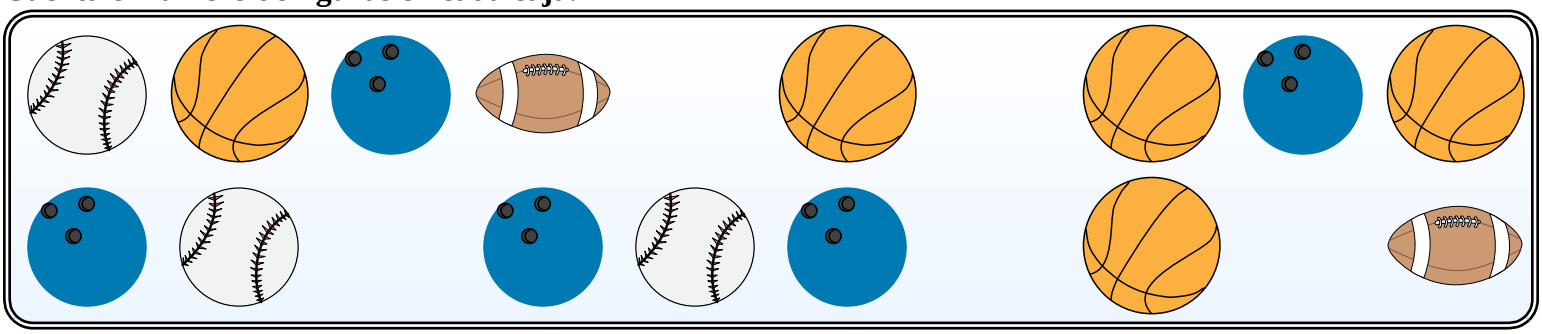

**Ej)** = 3

**1)** = 5

**2)** = 5

**3)** = 2



**4)** = 4

**5)** = 2

**6)** = 6

**7)** = 2



**8)** = 3

**9)** = 4

**10)** = 4

**11)** = 3



| | | | | | | | | | | |
|---|---|---|---|---|---|---|---|---|---|---|
| 1-10 | 91 | 82 | 73 | 64 | 55 | 45 | 36 | 27 | 18 | 9 |
| 11 | 0 | | | | | | | | | |