Creación de grupos de 100

Nombre:

Determine cuántos grupos de 100 se pueden crear a partir de los bloques que se muestran.

Ej)

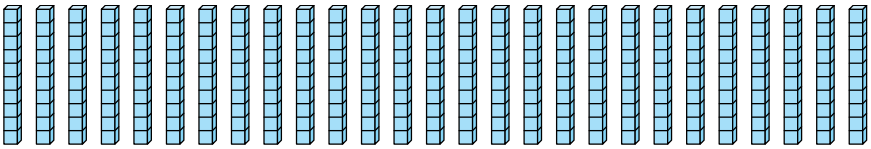

1)

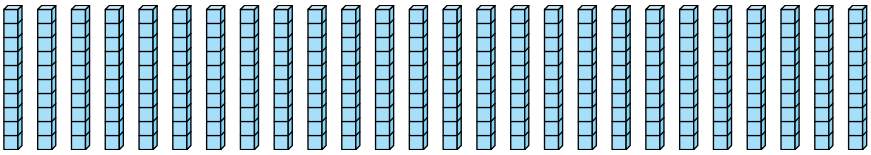

2)

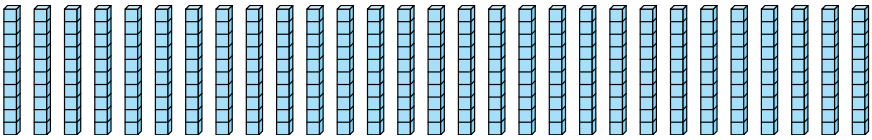

3)

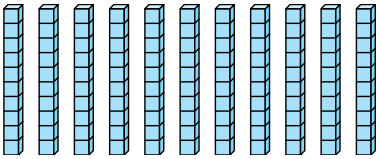

4)

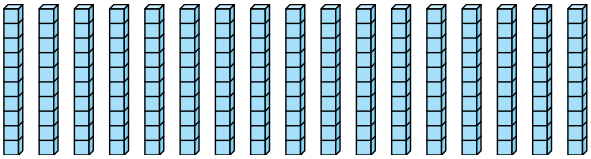

5)

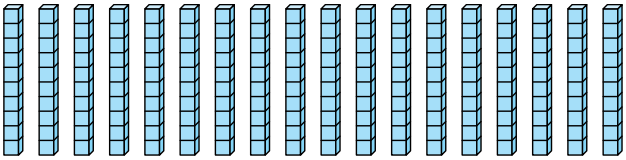

6)

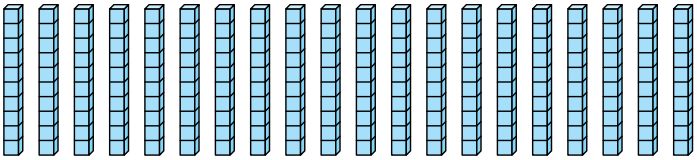

7)

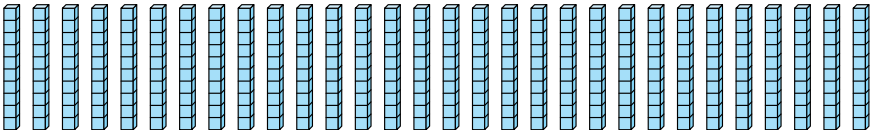

8)

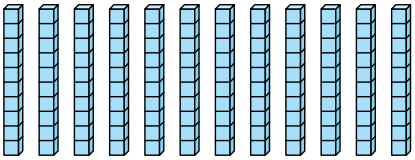

9)

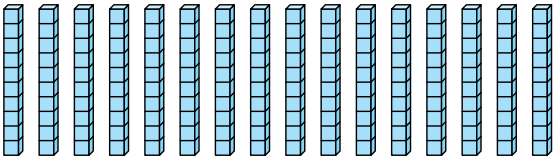

Respuestas

Ej. 2

1. _____

2. _____

3. _____

4. _____

5. _____

6. _____

7. _____

8. _____

9. _____

1-9	89	78	67	56	44	33	22	11	0

Creación de grupos de 100

Nombre: **Clave De Respuestas**

Determine cuántos grupos de 100 se pueden crear a partir de los bloques que se muestran.

Ej)

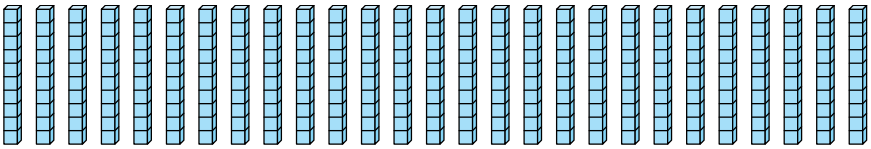

1)

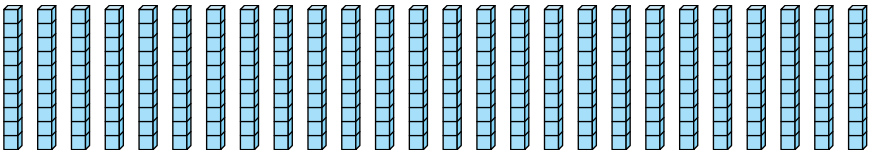

2)

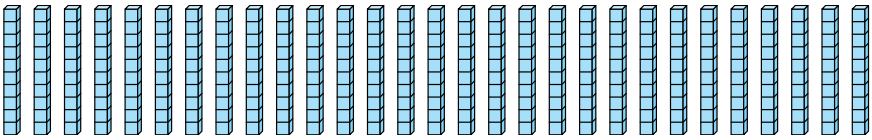

3)

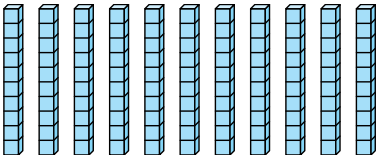

4)

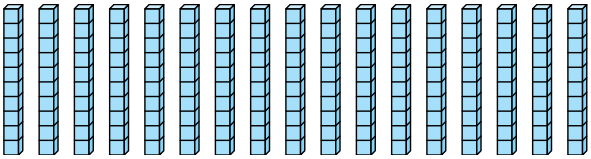

5)

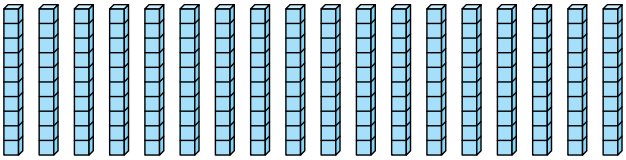

6)

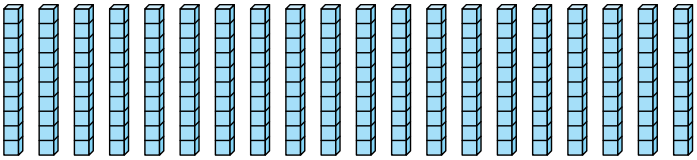

7)

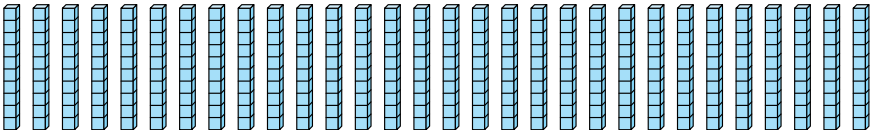

8)

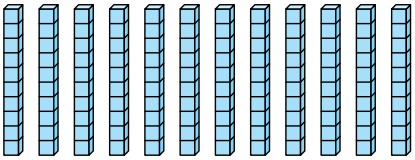

9)

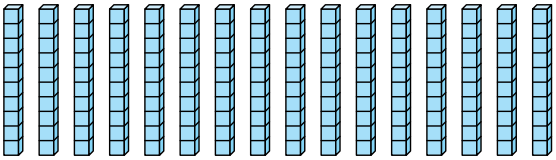

Respuestas

Ej.	2
1.	2
2.	2
3.	1
4.	1
5.	1
6.	2
7.	3
8.	1
9.	1

1-9	89	78	67	56	44	33	22	11	0

Creación de grupos de 100

Nombre:

Determine cuántos grupos de 100 se pueden crear a partir de los bloques que se muestran.

Ej)

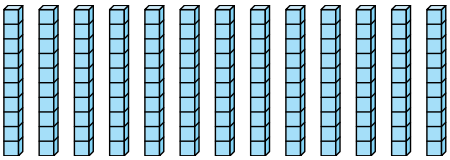

1)

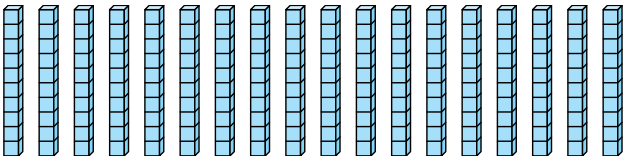

2)

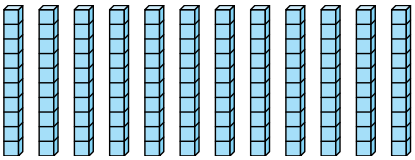

3)

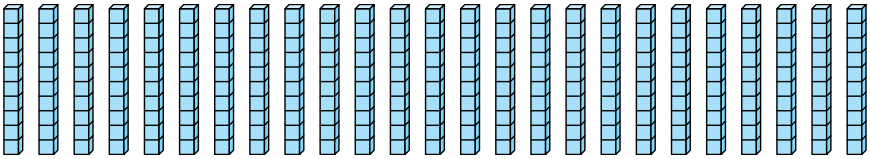

4)

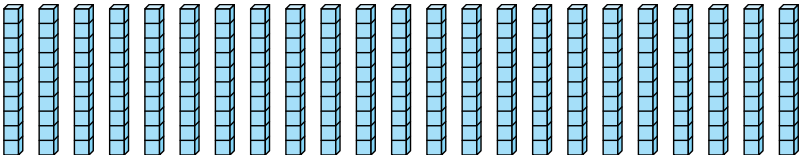

5)

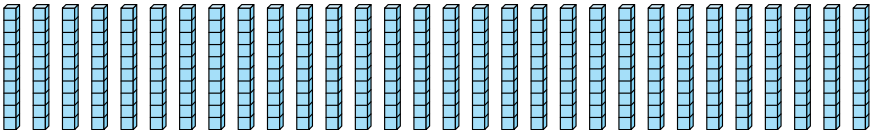

6)

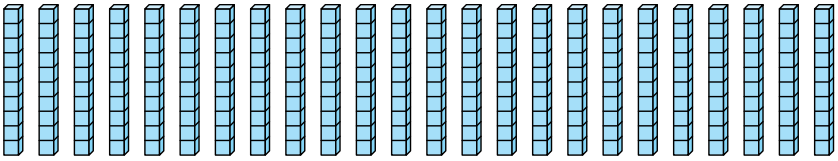

7)

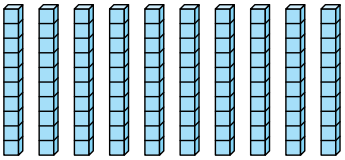

8)

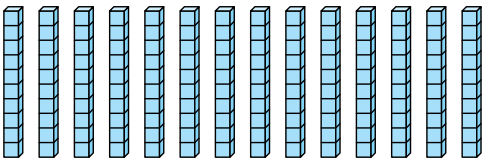

9)

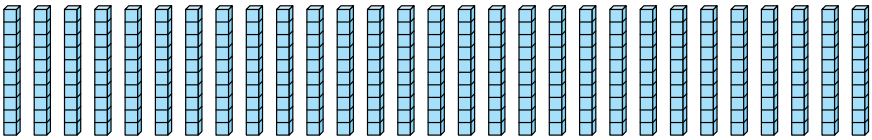

Respuestas

Ej. 1

1. _____

2. _____

3. _____

4. _____

5. _____

6. _____

7. _____

8. _____

9. _____

1-9	89	78	67	56	44	33	22	11	0

Determine cuántos grupos de 100 se pueden crear a partir de los bloques que se muestran.

Ej)

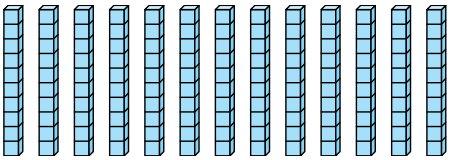

1)

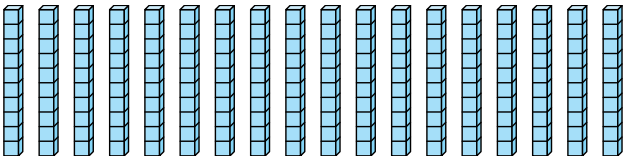

2)

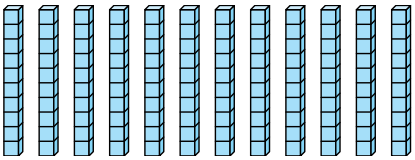

3)

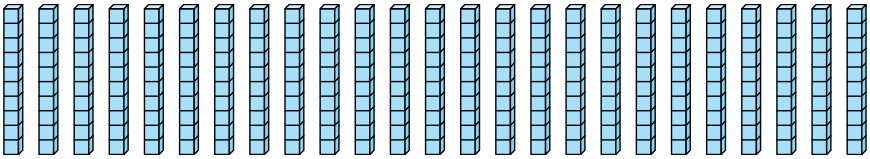

4)

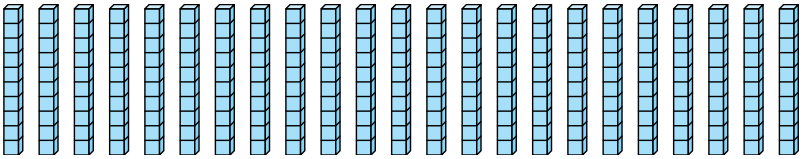

5)

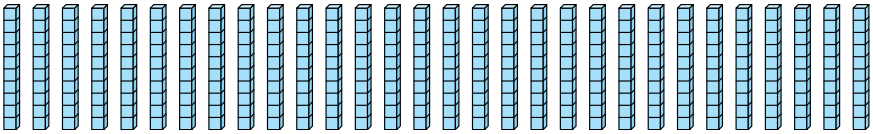

6)

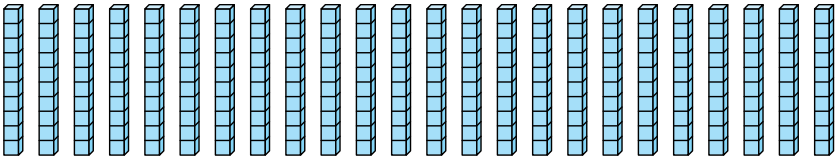

7)

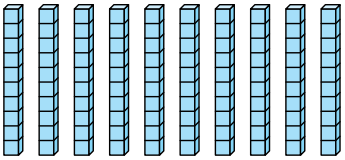

8)

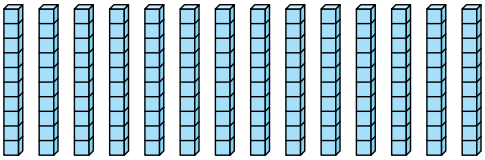

9)

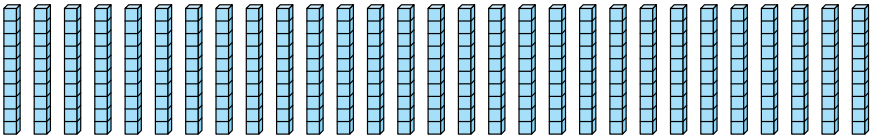

Respuestas

Ej.	1
1.	1
2.	1
3.	2
4.	2
5.	3
6.	2
7.	1
8.	1
9.	2

1-9	89	78	67	56	44	33	22	11	0

Creación de grupos de 100

Nombre:

Determine cuántos grupos de 100 se pueden crear a partir de los bloques que se muestran.

Ej)

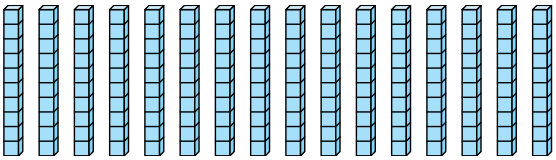

1)

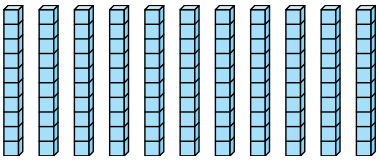

2)

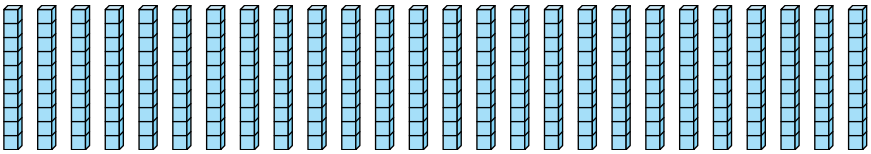

3)

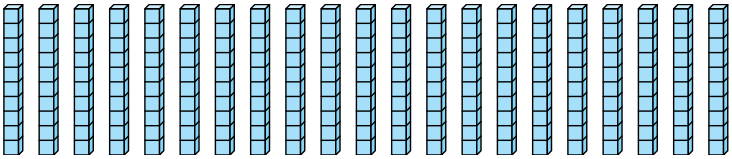

4)

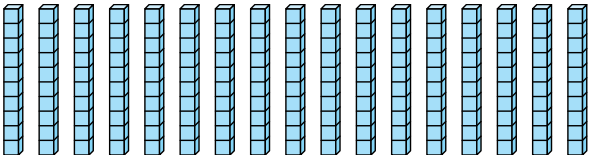

5)

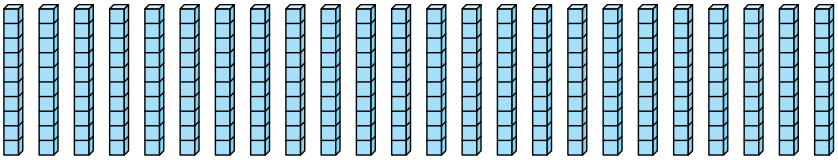

6)

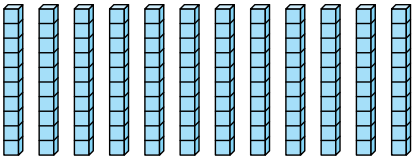

7)

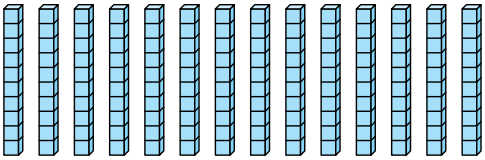

8)

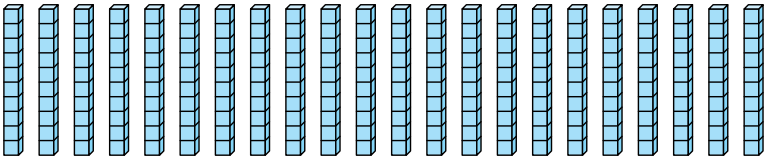

9)

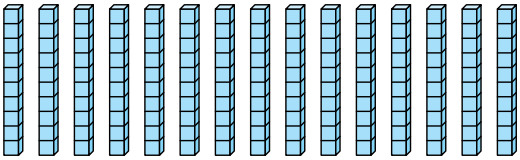

Respuestas

Ej. 1

1. _____

2. _____

3. _____

4. _____

5. _____

6. _____

7. _____

8. _____

9. _____

1-9	89	78	67	56	44	33	22	11	0

Nombre: **Clave De Respuestas**

Determine cuántos grupos de 100 se pueden crear a partir de los bloques que se muestran.

Ej)

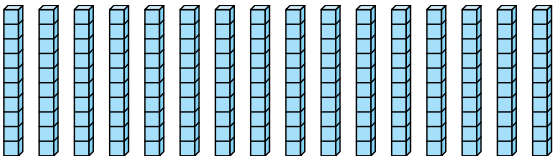

1)

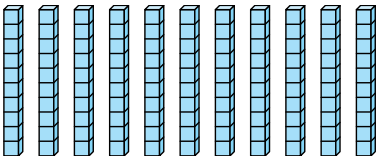

2)

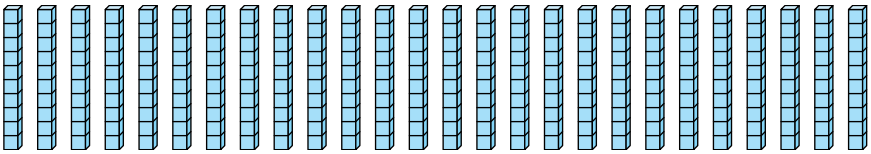

3)

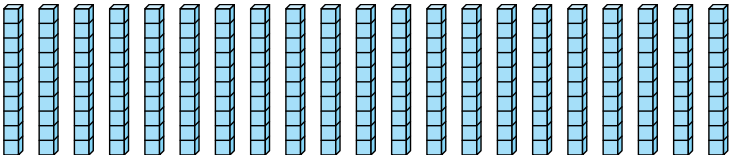

4)

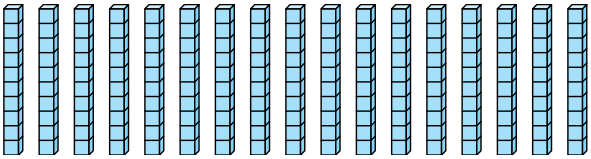

5)

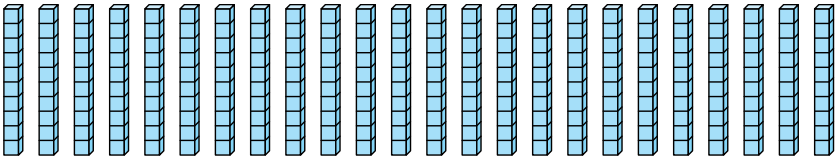

6)

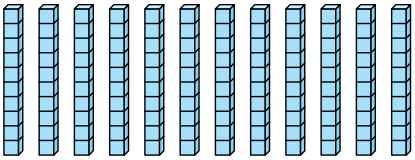

7)

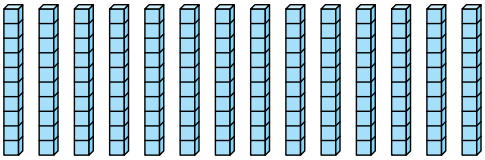

8)

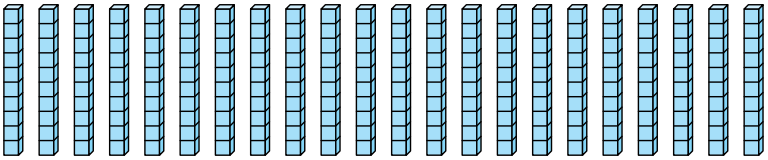

9)

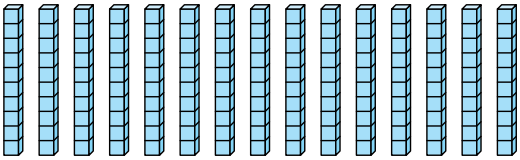

Respuestas

Ej.	1
1.	1
2.	2
3.	2
4.	1
5.	2
6.	1
7.	1
8.	2
9.	1

1-9	89	78	67	56	44	33	22	11	0

Creación de grupos de 100

Nombre:

Determine cuántos grupos de 100 se pueden crear a partir de los bloques que se muestran.

Ej)

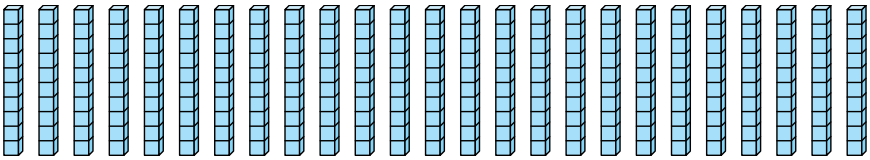

1)

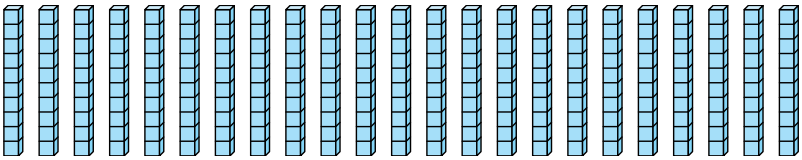

2)

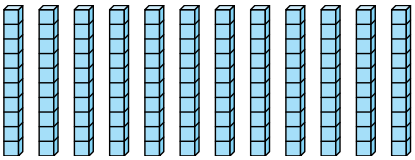

3)

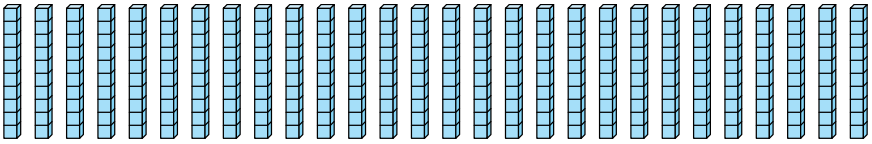

4)

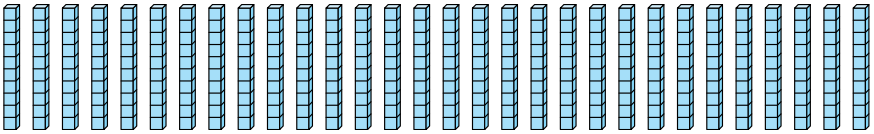

5)

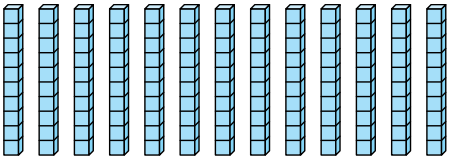

6)

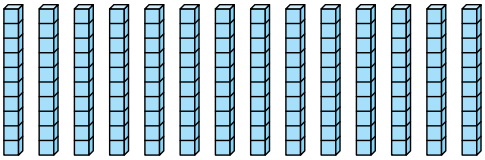

7)

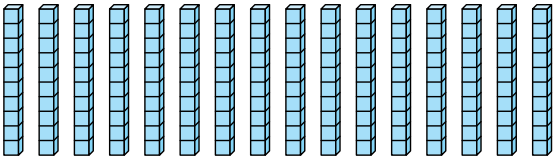

8)

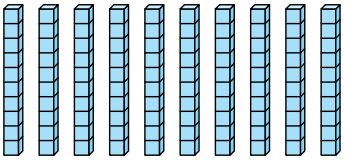

9)

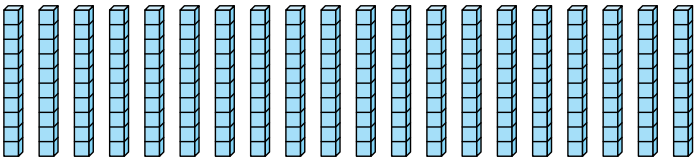

Respuestas

Ej. 2

1. _____
2. _____
3. _____
4. _____
5. _____
6. _____
7. _____
8. _____
9. _____

1-9	89	78	67	56	44	33	22	11	0

Determine cuántos grupos de 100 se pueden crear a partir de los bloques que se muestran.

Ej)

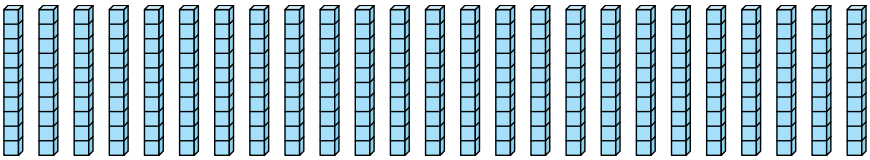

1)

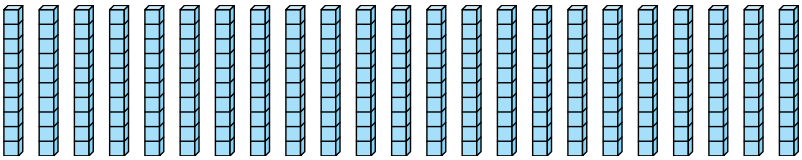

2)

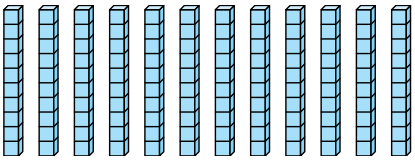

3)

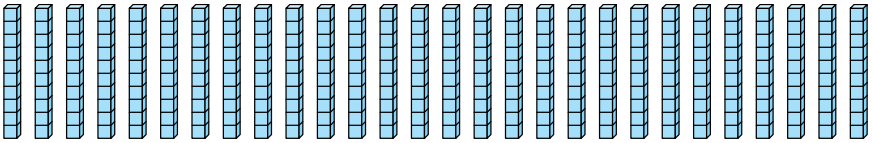

4)

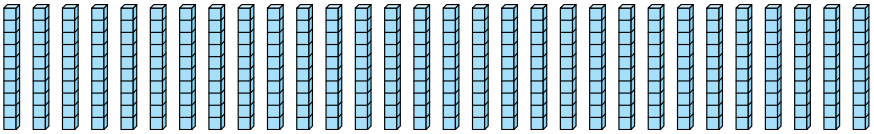

5)

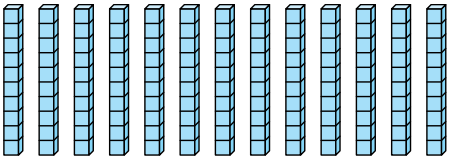

6)

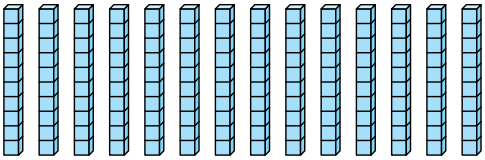

7)

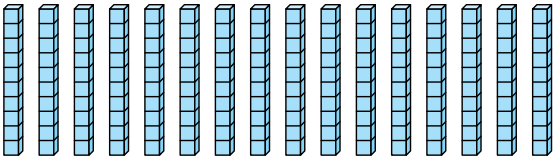

8)

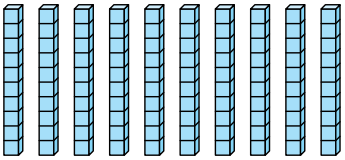

9)

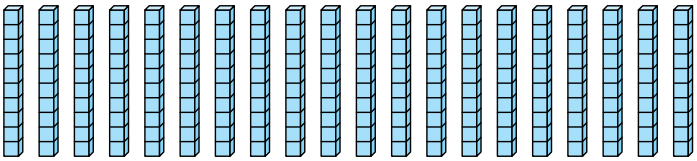

Respuestas

Ej.	2
1.	2
2.	1
3.	2
4.	3
5.	1
6.	1
7.	1
8.	1
9.	2

1-9	89	78	67	56	44	33	22	11	0

Creación de grupos de 100

Nombre:

Determine cuántos grupos de 100 se pueden crear a partir de los bloques que se muestran.

Ej)

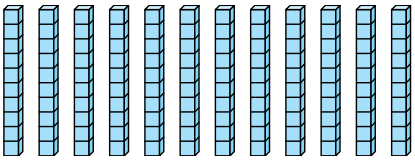

1)

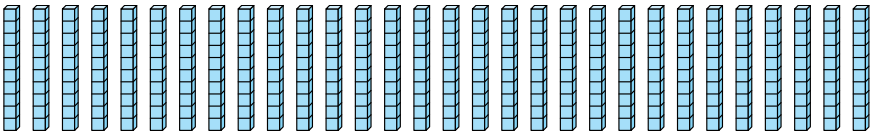

2)

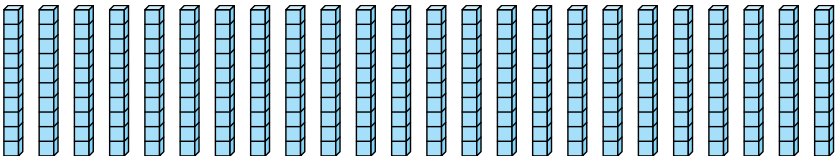

3)

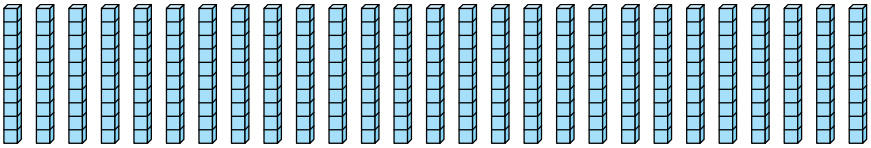

4)

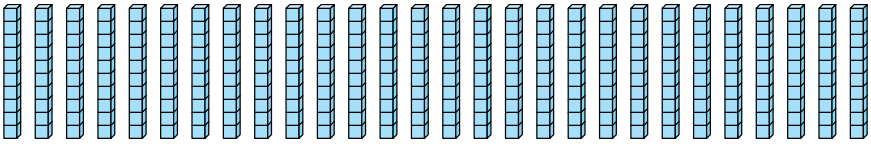

5)

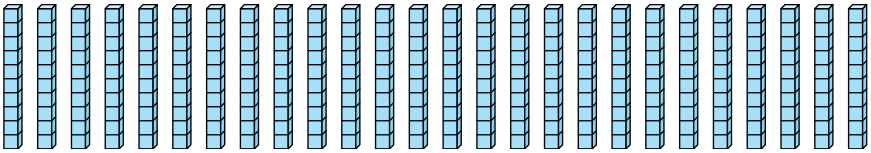

6)

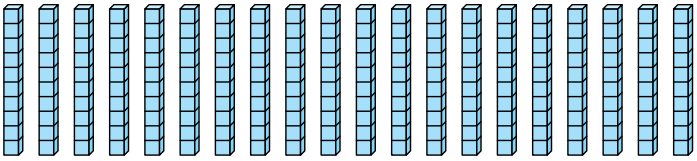

7)

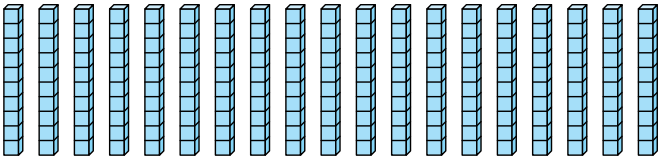

8)

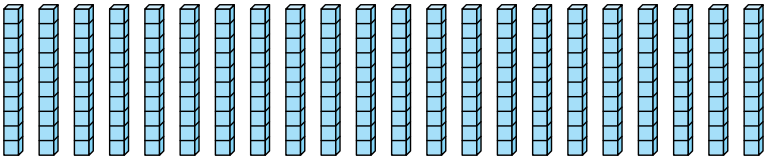

9)

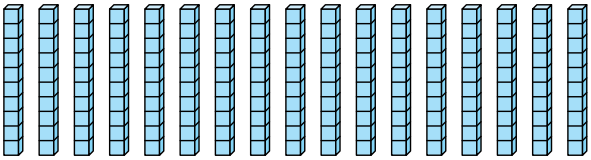

Respuestas

Ej. 1

1. _____

2. _____

3. _____

4. _____

5. _____

6. _____

7. _____

8. _____

9. _____

1-9	89	78	67	56	44	33	22	11	0

Determine cuántos grupos de 100 se pueden crear a partir de los bloques que se muestran.

Ej)

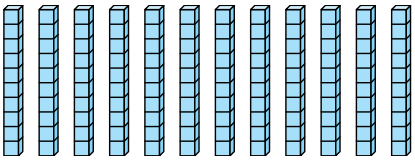

1)

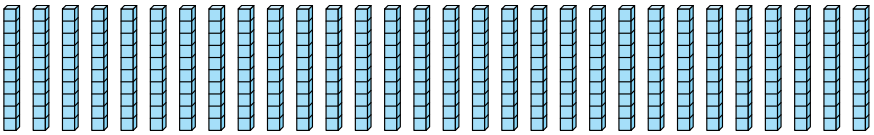

2)

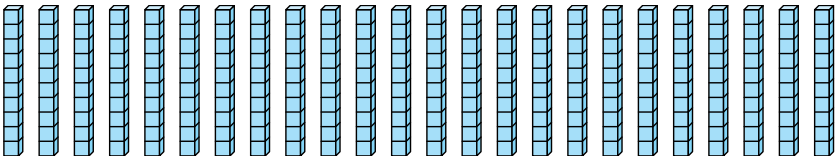

3)

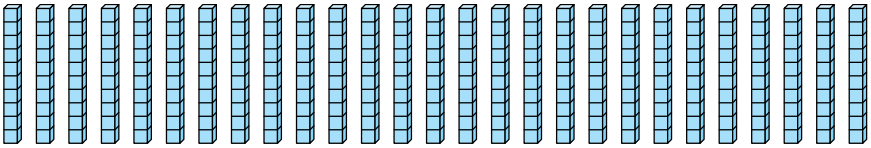

4)

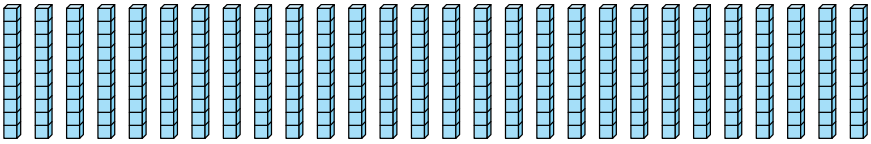

5)

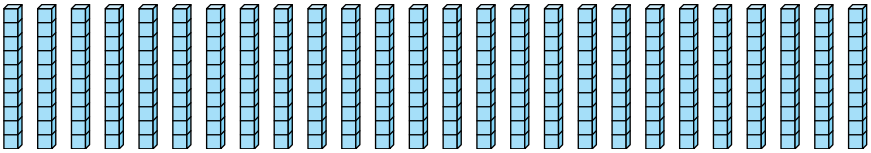

6)

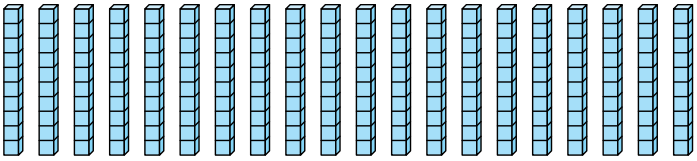

7)

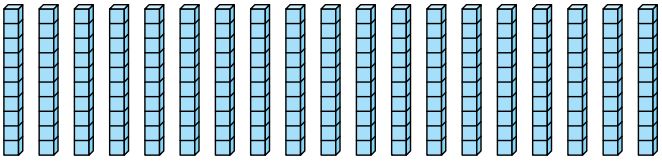

8)

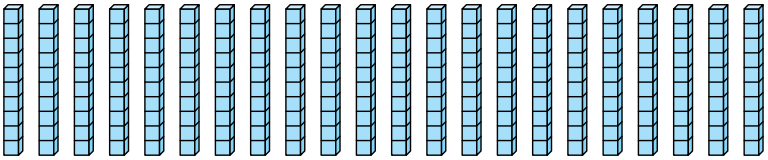

9)

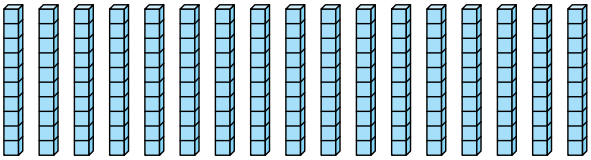

Respuestas

Ej.	1
1.	3
2.	2
3.	2
4.	2
5.	2
6.	2
7.	1
8.	2
9.	1

1-9	89	78	67	56	44	33	22	11	0

Creación de grupos de 100

Nombre:

Determine cuántos grupos de 100 se pueden crear a partir de los bloques que se muestran.

Ej)

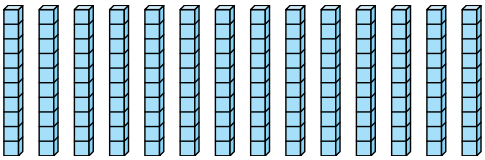

1)

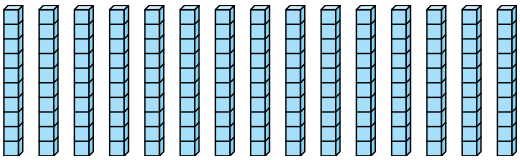

2)

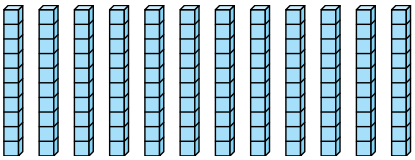

3)

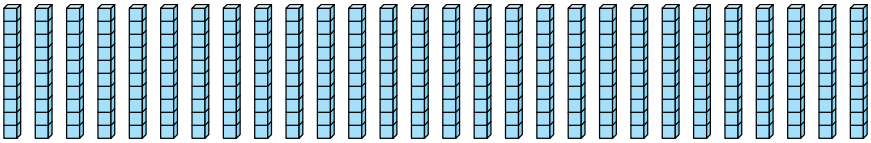

4)

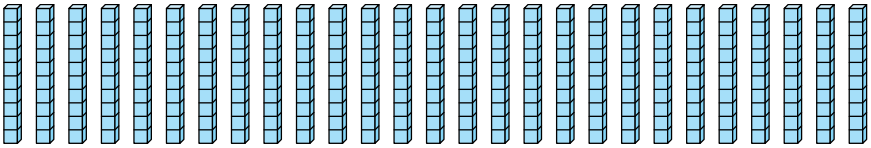

5)

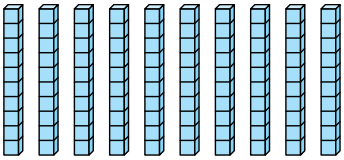

6)

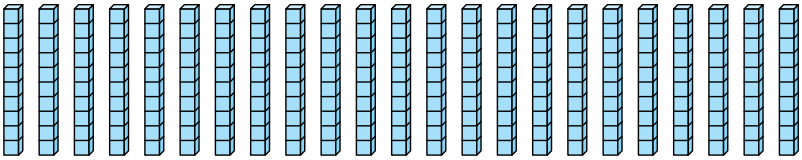

7)

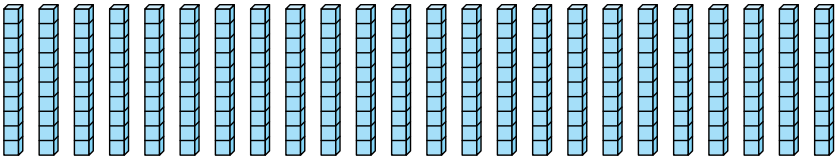

8)

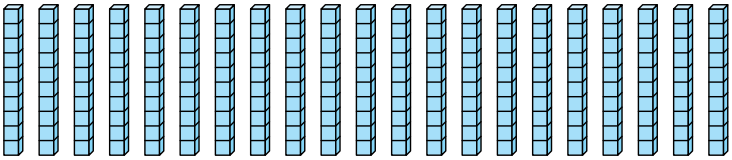

9)

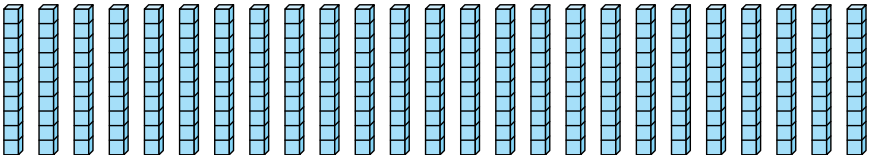

Respuestas

Ej. 1

1. _____

2. _____

3. _____

4. _____

5. _____

6. _____

7. _____

8. _____

9. _____

1-9	89	78	67	56	44	33	22	11	0

Determine cuántos grupos de 100 se pueden crear a partir de los bloques que se muestran.

Ej)

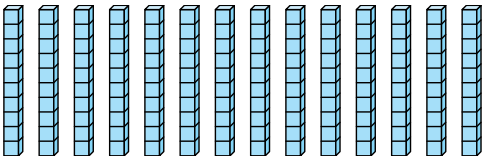

1)

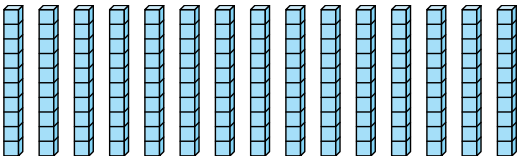

2)

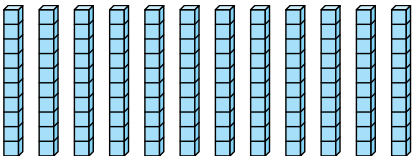

3)

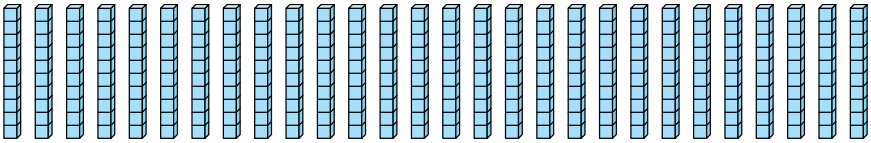

4)

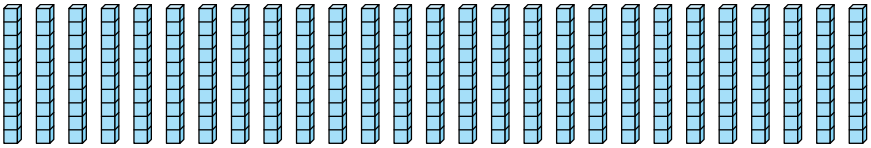

5)

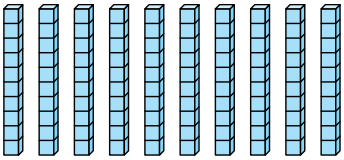

6)

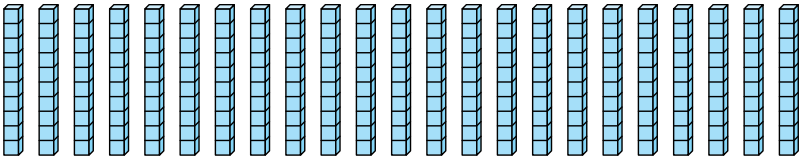

7)

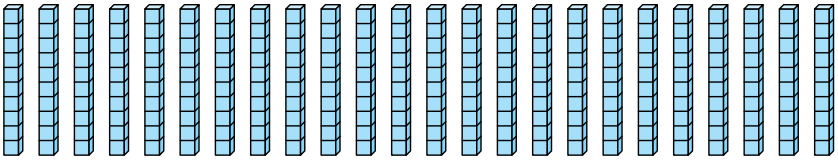

8)

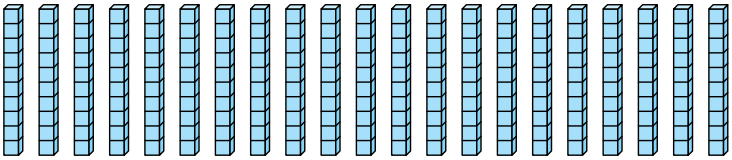

9)

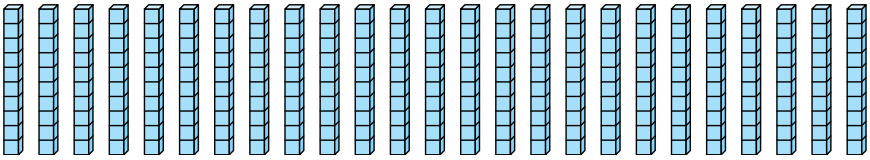

Respuestas

Ej.	1
1.	1
2.	1
3.	2
4.	2
5.	1
6.	2
7.	2
8.	2
9.	2

1-9	89	78	67	56	44	33	22	11	0

Creación de grupos de 100 Nombre:

Determine cuántos grupos de 100 se pueden crear a partir de los bloques que se muestran.

Ej) 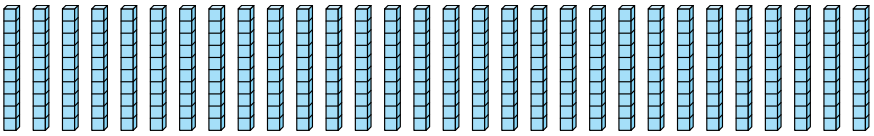

1) 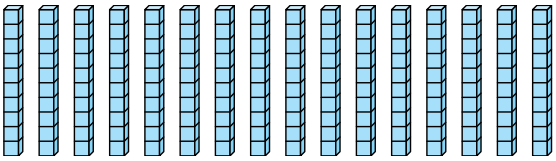

2) 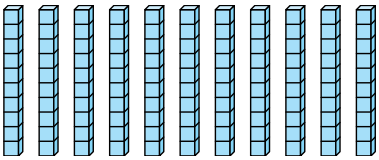

3) 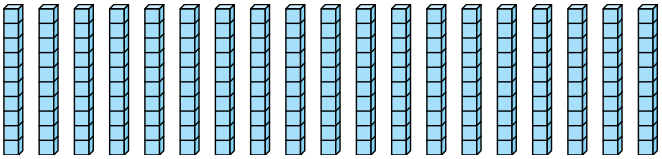

4) 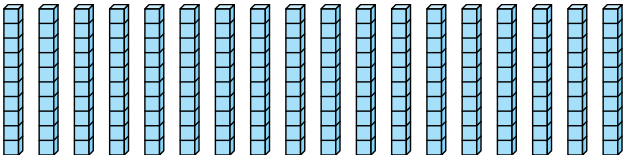

5) 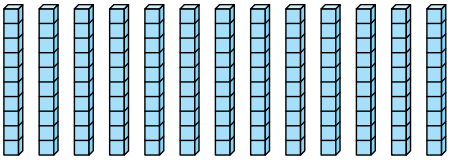

6) 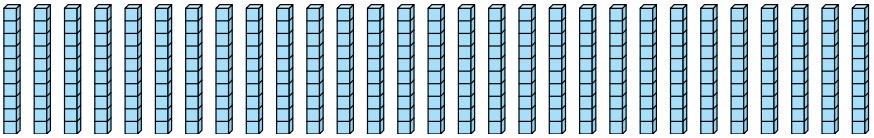

7) 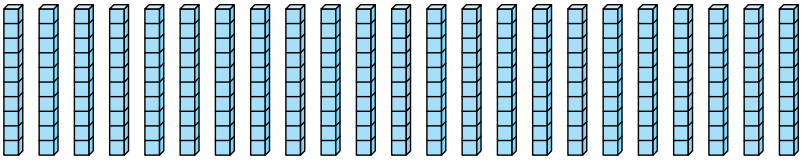

8) 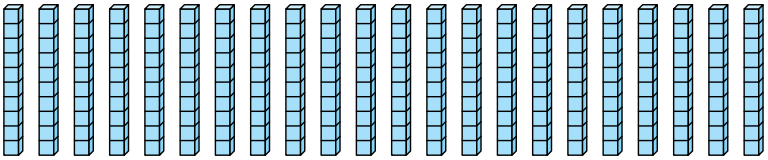

9) 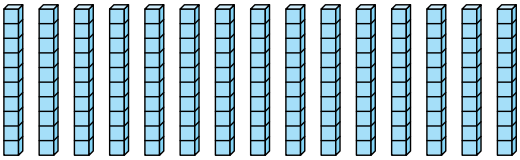

Respuestas

Ej. 3

1. _____
2. _____
3. _____
4. _____
5. _____
6. _____
7. _____
8. _____
9. _____

1-9	89	78	67	56	44	33	22	11	0

Determine cuántos grupos de 100 se pueden crear a partir de los bloques que se muestran.

Ej) 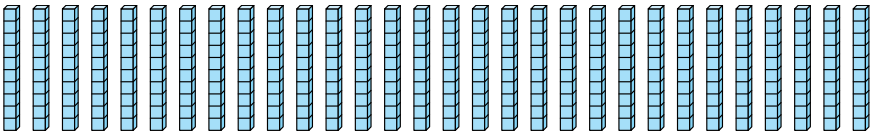

1) 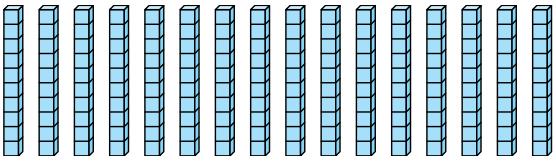

2) 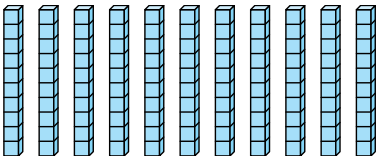

3) 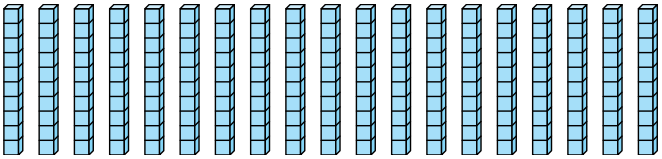

4) 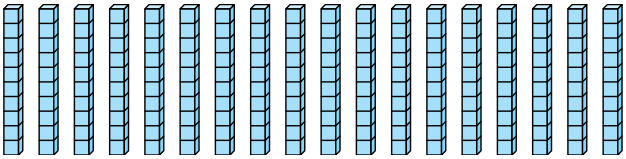

5) 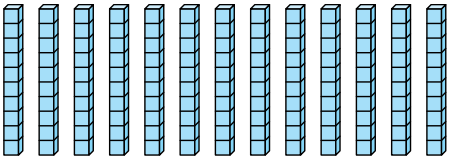

6) 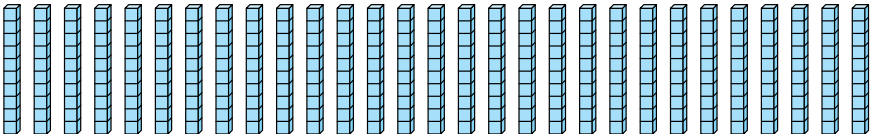

7) 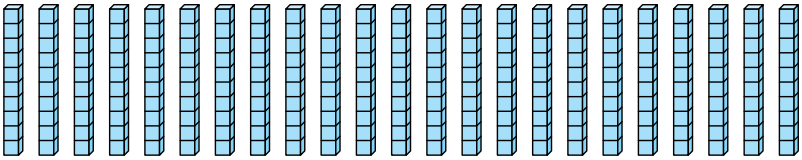

8) 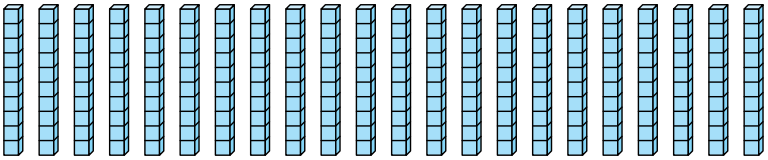

9) 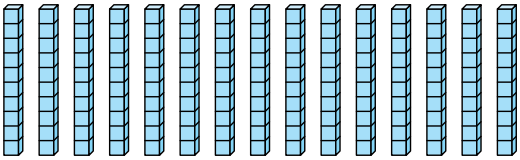

Respuestas

Ej.	3
1.	1
2.	1
3.	1
4.	1
5.	1
6.	2
7.	2
8.	2
9.	1

1-9	89	78	67	56	44	33	22	11	0

Creación de grupos de 100 Nombre:

Determine cuántos grupos de 100 se pueden crear a partir de los bloques que se muestran.

Ej)

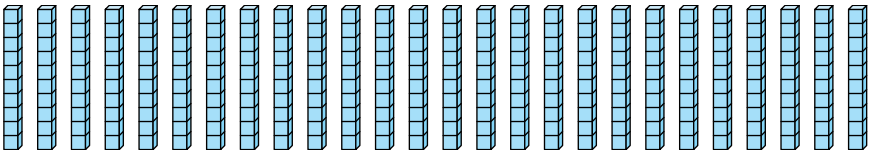

1)

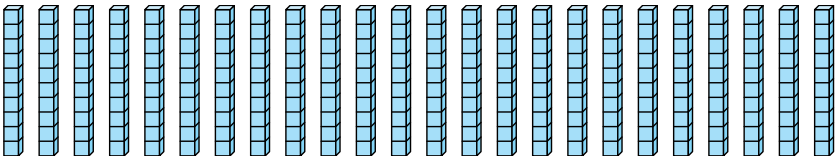

2)

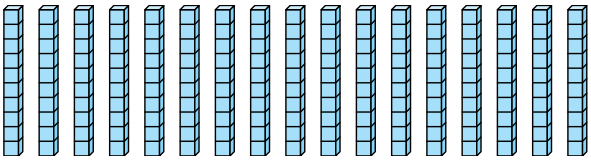

3)

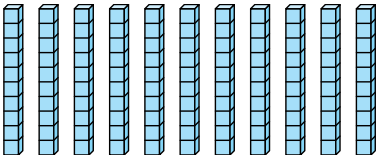

4)

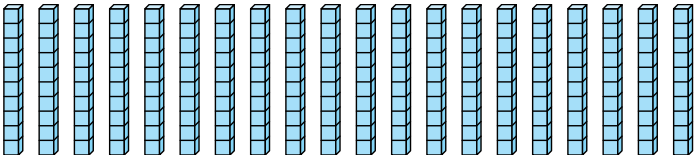

5)

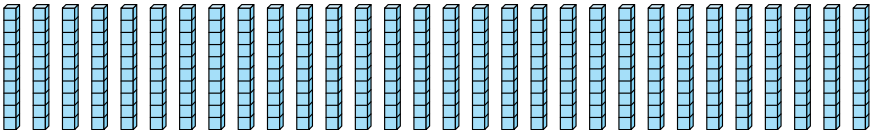

6)

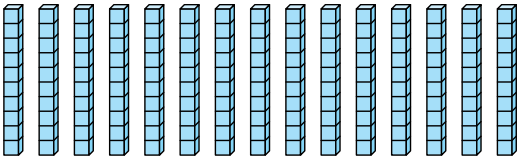

7)

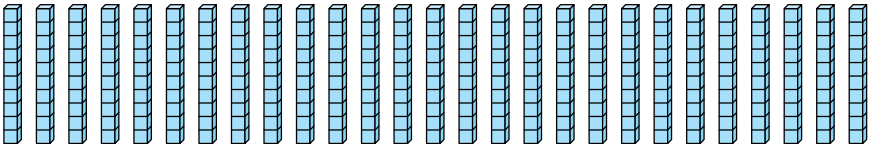

8)

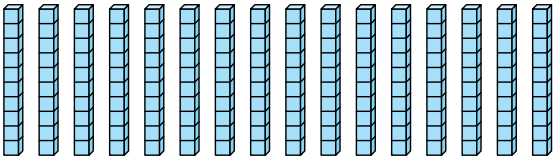

9)

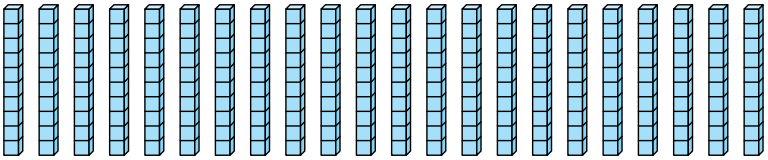

Respuestas

Ej. 2

1. _____

2. _____

3. _____

4. _____

5. _____

6. _____

7. _____

8. _____

9. _____

1-9	89	78	67	56	44	33	22	11	0

Determine cuántos grupos de 100 se pueden crear a partir de los bloques que se muestran.

Ej)

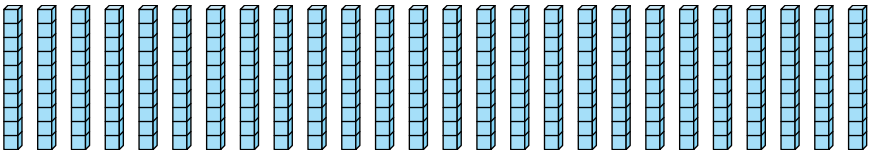

1)

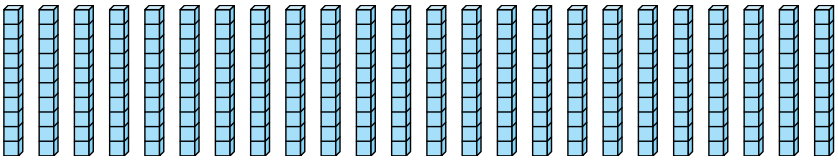

2)

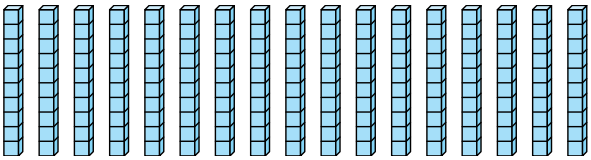

3)

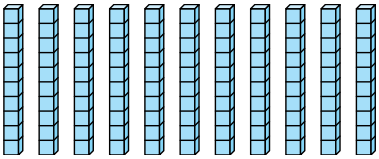

4)

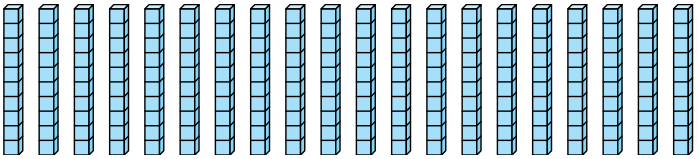

5)

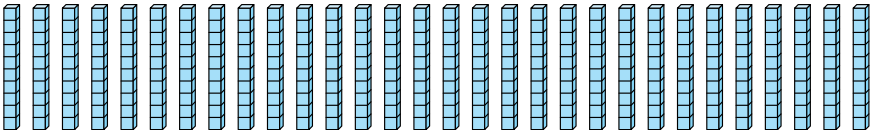

6)

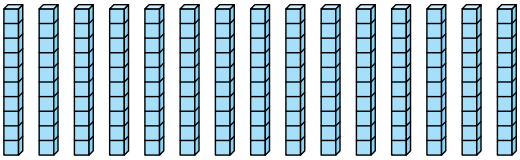

7)

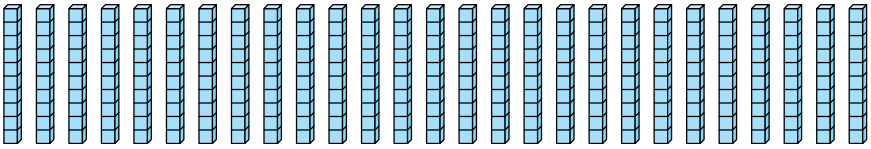

8)

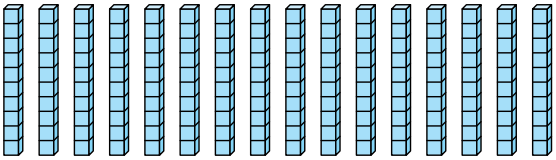

9)

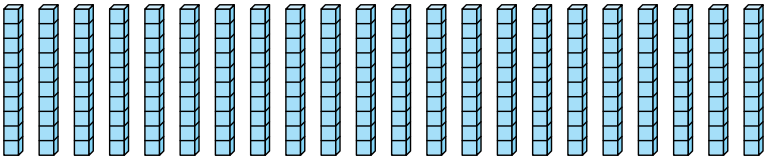

Respuestas

Ej.	2
1.	2
2.	1
3.	1
4.	2
5.	3
6.	1
7.	2
8.	1
9.	2

1-9	89	78	67	56	44	33	22	11	0

Creación de grupos de 100 Nombre:

Determine cuántos grupos de 100 se pueden crear a partir de los bloques que se muestran.

Ej)

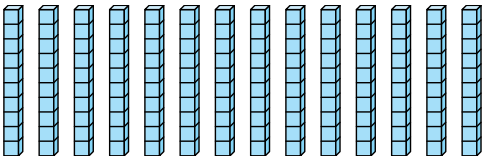

1)

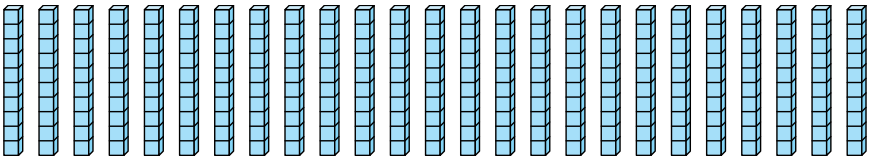

2)

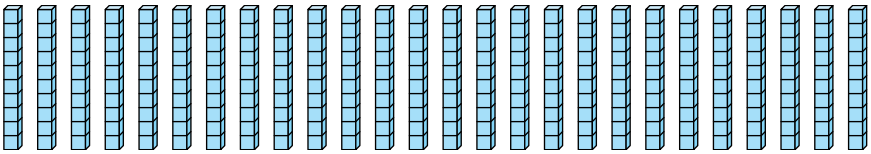

3)

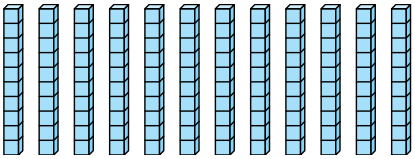

4)

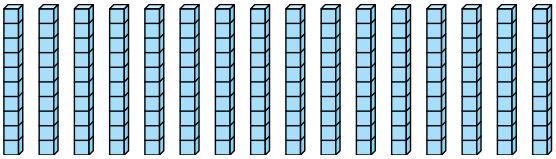

5)

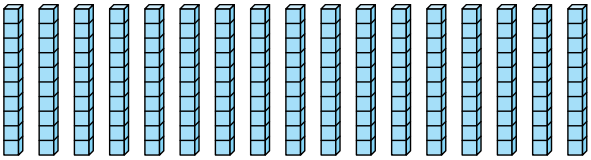

6)

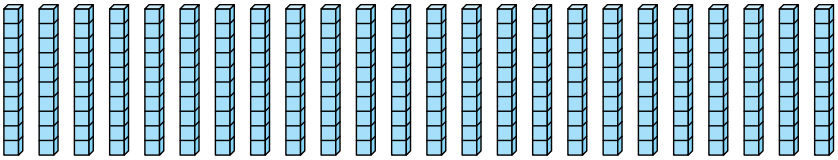

7)

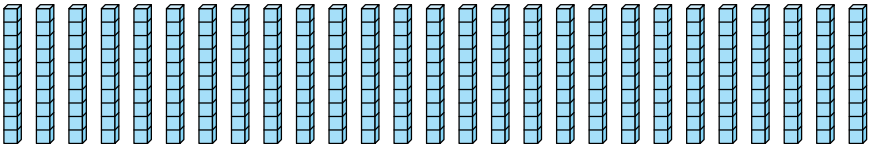

8)

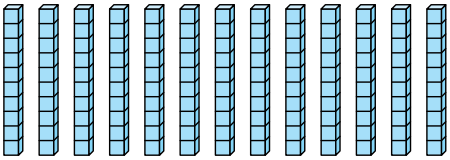

9)

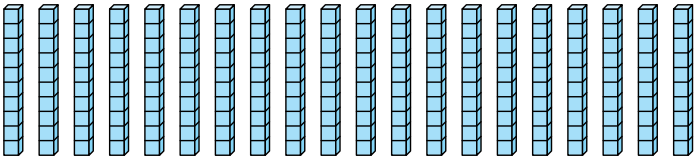

Respuestas

Ej. 1

1. _____

2. _____

3. _____

4. _____

5. _____

6. _____

7. _____

8. _____

9. _____

1-9	89	78	67	56	44	33	22	11	0

Determine cuántos grupos de 100 se pueden crear a partir de los bloques que se muestran.

Ej)

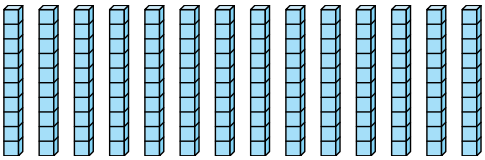

1)

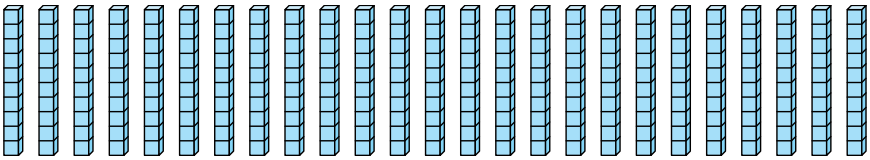

2)

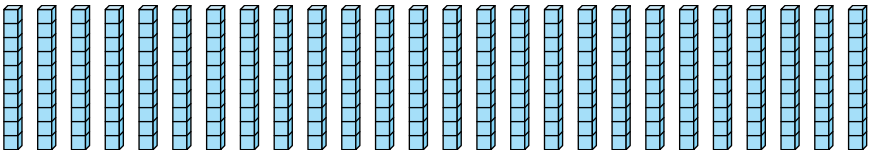

3)

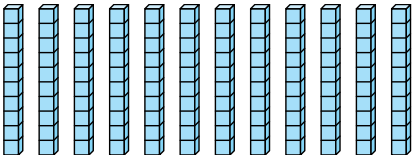

4)

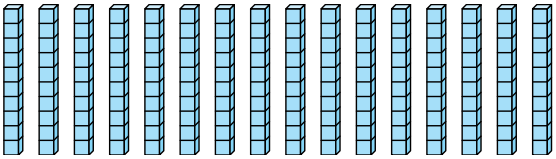

5)

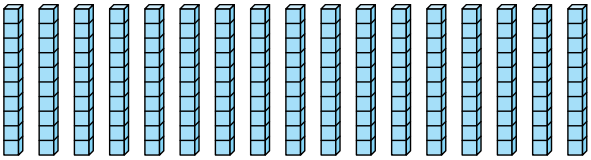

6)

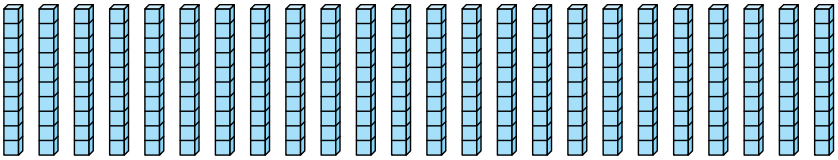

7)

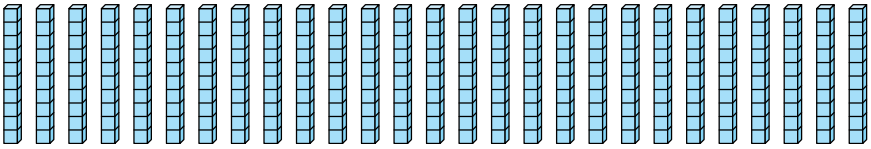

8)

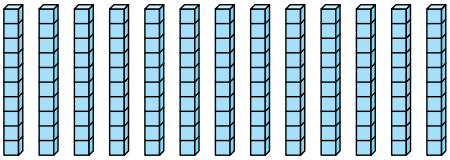

9)

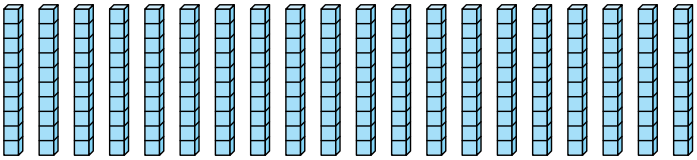

Respuestas

Ej.	1
1.	2
2.	2
3.	1
4.	1
5.	1
6.	2
7.	2
8.	1
9.	2

1-9	89	78	67	56	44	33	22	11	0

Creación de grupos de 100

Nombre:

Determine cuántos grupos de 100 se pueden crear a partir de los bloques que se muestran.

Ej) 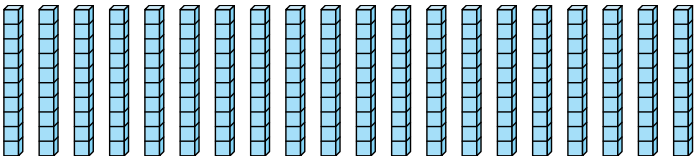

1) 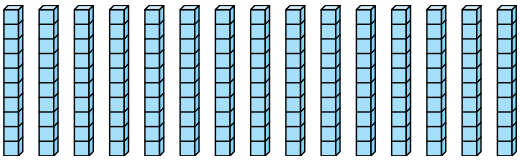

2) 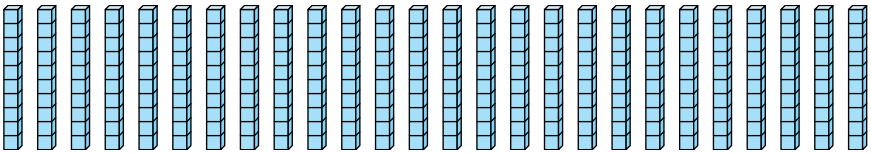

3) 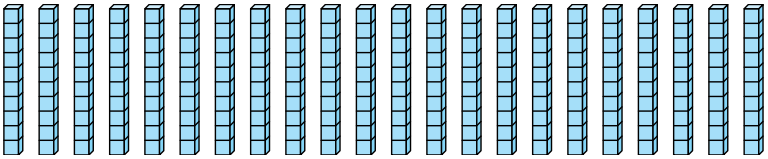

4) 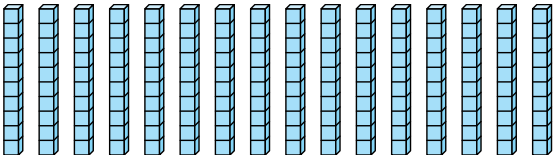

5) 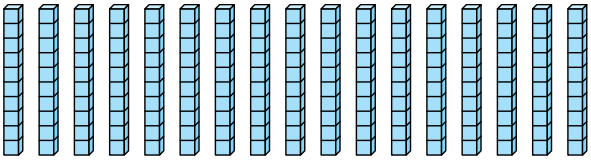

6) 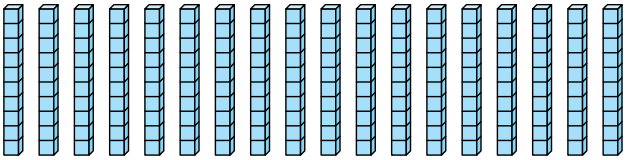

7) 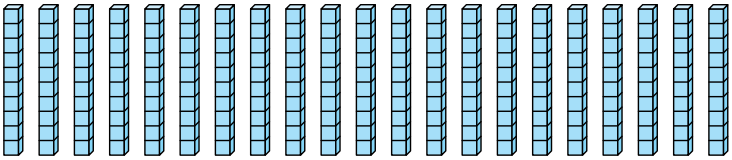

8) 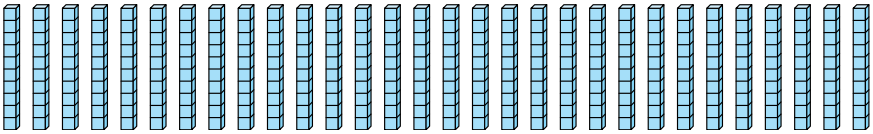

9) 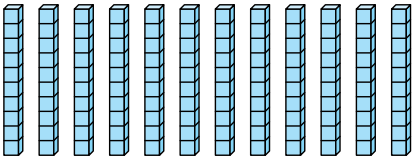

Respuestas

Ej. 2

1. _____
2. _____
3. _____
4. _____
5. _____
6. _____
7. _____
8. _____
9. _____

1-9	89	78	67	56	44	33	22	11	0

Nombre: **Clave De Respuestas**

Determine cuántos grupos de 100 se pueden crear a partir de los bloques que se muestran.

Ej)

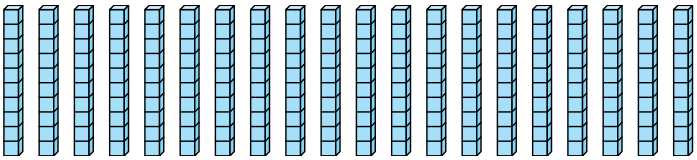

1)

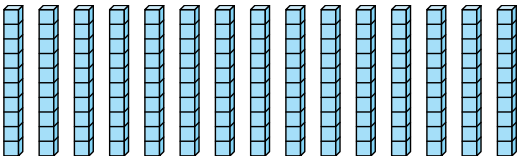

2)

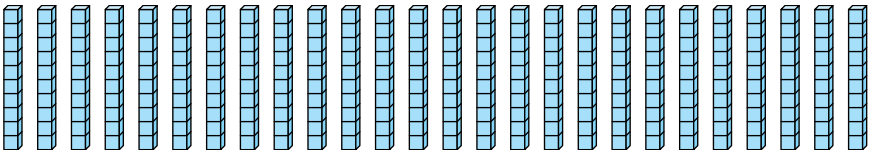

3)

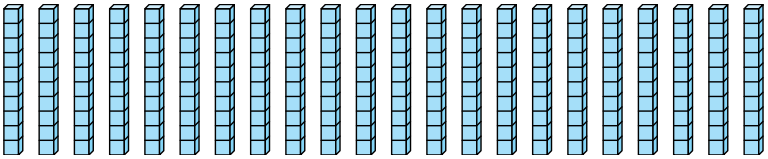

4)

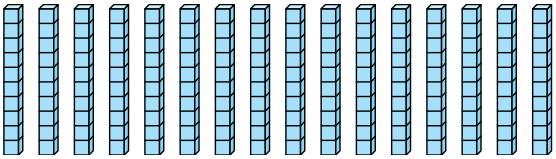

5)

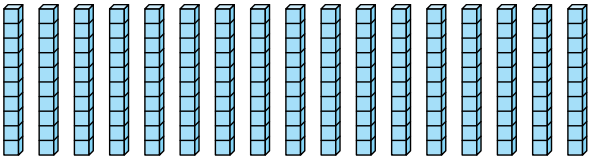

6)

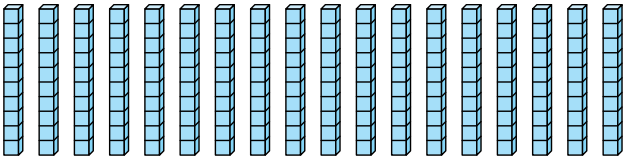

7)

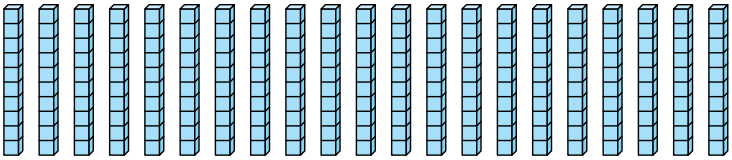

8)

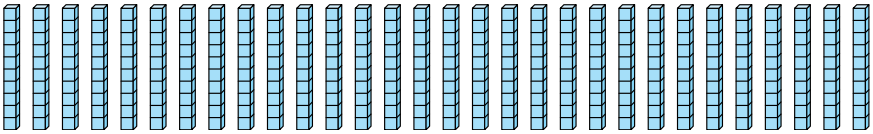

9)

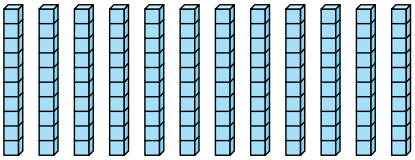

Respuestas

Ej.	2
1.	1
2.	2
3.	2
4.	1
5.	1
6.	1
7.	2
8.	3
9.	1

1-9	89	78	67	56	44	33	22	11	0